**Task card 1** Back to School Math

Sam buys a bookmark for 40¢ and a star sticker for 40¢. How many cents does Sam spend?

**Task card 2** Back to School Math

The bakery makes 284 granola bars. It sells 114 of them. How many granola bars are left?

**Task card 3** Back to School Math

Omar puts 5 muffins on each of 5 plates. How many muffins is that in all?



**Task card 4** Back to School Math

The school bakes 88 oatmeal cookies and 53 granola bars for the bake sale. How many treats is that in all?

**Task card 5** Back to School Math

The school bakes 60 granola bars and 83 muffins for the bake sale. How many treats is that in all?

**Task card 6** Back to School Math

The bakery makes 223 oatmeal cookies. It sells 65 of them. How many oatmeal cookies are left?

**Task card 7** Back to School Math

Ava puts 4 granola bars on each of 4 plates. How many granola bars is that in all?



**Task card 8** Back to School Math

Leo buys a bookmark for 10¢ and a name tag for 50¢. How many cents does Leo spend?

**Task card 9** Back to School Math

The bakery makes 36 oatmeal cookies. It sells 24 of them. How many oatmeal cookies are left?

**Task card 10** Back to School Math

Ava puts 5 oatmeal cookies on each of 4 plates. How many oatmeal cookies is that in all?



**Task card 11** Back to School Math

The bakery makes 112 muffins. It sells 99 of them. How many muffins are left?

**Task card 12** Back to School Math

Mia buys a bookmark for 30¢ and a name tag for 55¢. How many cents does Mia spend?

**Task card 13** Back to School Math

Omar puts 3 granola bars on each of 2 plates. How many granola bars is that in all?



**Task card 14** Back to School Math

Ava buys a bookmark for 40¢ and a name tag for 10¢. How many cents does Ava spend?

**Task card 15** Back to School Math

The school bakes 198 oatmeal cookies and 83 muffins for the bake sale. How many treats is that in all?

**Task card 16** Back to School Math

The school bakes 163 granola bars and 120 muffins for the bake sale. How many treats is that in all?

**Task card 17** Back to School Math

The school bakes 225 granola bars and 123 muffins for the bake sale. How many treats is that in all?

**Task card 18** Back to School Math

Zoe puts 5 granola bars on each of 2 plates. How many granola bars is that in all?



**Task card 19** Back to School Math

The school bakes 222 oatmeal cookies and 64 muffins for the bake sale. How many treats is that in all?

**Task card 20** Back to School Math

The bakery makes 167 granola bars. It sells 70 of them. How many granola bars are left?

**Task card 21** Back to School Math

Mia buys a bookmark for 40¢ and a name tag for 25¢. How many cents does Mia spend?

**Task card 22** Back to School Math

Ava puts 5 muffins on each of 4 plates. How many muffins is that in all?



**Task card 23** Back to School Math

The bakery makes 488 muffins. It sells 63 of them. How many muffins are left?

**Task card 24** Back to School Math

Sam buys a name tag for 25¢ and a bookmark for 5¢. How many cents does Sam spend?

# Back to School Math Task Cards

Recording sheet · Grade 2 · Read each story and solve.

Name: _____ Date: _____

Scan to check your answers

| | | | |
|---|---|---|---|
| 1 | 2 | 3 | 4 |
| 5 | 6 | 7 | 8 |
| 9 | 10 | 11 | 12 |
| 13 | 14 | 15 | 16 |
| 17 | 18 | 19 | 20 |
| 21 | 22 | 23 | 24 |

# Back to School Math Task Cards: Answer Key

Grade 2 · Hard

The answers online

| | | |
|---|---|---|
| **1.** 80 | **2.** 170 | **3.** 25 |
| **4.** 141 | **5.** 143 | **6.** 158 |
| **7.** 16 | **8.** 60 | **9.** 12 |
| **10.** 20 | **11.** 13 | **12.** 85 |
| **13.** 6 | **14.** 50 | **15.** 281 |
| **16.** 283 | **17.** 348 | **18.** 10 |
| **19.** 286 | **20.** 97 | **21.** 65 |
| **22.** 20 | **23.** 425 | **24.** 30 |