Task card 1 Back to School Math

The school bakes 22 muffins and 37 oatmeal cookies for the bake sale. How many treats is that in all?

Task card 2 Back to School Math

Mia buys a star sticker for 30¢ and a name tag for 30¢. How many cents does Mia spend?

Task card 3 Back to School Math

The school bakes 31 granola bars and 55 muffins for the bake sale. How many treats is that in all?

Task card 4 Back to School Math

The bakery makes 84 oatmeal cookies. It sells 70 of them. How many oatmeal cookies are left?

Task card 5 Back to School Math

Leo puts 4 muffins on each of 2 plates. How many muffins is that in all?



Task card 6 Back to School Math

Noah puts 2 oatmeal cookies on each of 2 plates. How many oatmeal cookies is that in all?



Task card 7 Back to School Math

The bakery makes 77 muffins. It sells 29 of them. How many muffins are left?

Task card 8 Back to School Math

Ben buys a star sticker for 25¢ and a name tag for 25¢. How many cents does Ben spend?

Task card 9 Back to School Math

Sam buys a name tag for 40¢ and a bookmark for 5¢. How many cents does Sam spend?

Task card 10 Back to School Math

Noah buys a name tag for 25¢ and a star sticker for 45¢. How many cents does Noah spend?

Task card 11 Back to School Math

The bakery makes 174 oatmeal cookies. It sells 153 of them. How many oatmeal cookies are left?

Task card 12 Back to School Math

The school bakes 199 muffins and 196 granola bars for the bake sale. How many treats is that in all?

Task card 13 Back to School Math

Omar puts 5 oatmeal cookies on each of 3 plates. How many oatmeal cookies is that in all?



Task card 14 Back to School Math

Omar puts 3 muffins on each of 3 plates. How many muffins is that in all?



Task card 15 Back to School Math

The bakery makes 389 granola bars. It sells 274 of them. How many granola bars are left?

Task card 16 Back to School Math

The school bakes 214 granola bars and 124 muffins for the bake sale. How many treats is that in all?

Task card 17 Back to School Math

The school bakes 173 granola bars and 198 oatmeal cookies for the bake sale. How many treats is that in all?

Task card 18 Back to School Math

Mia buys a star sticker for 35¢ and a name tag for 20¢. How many cents does Mia spend?

Task card 19 Back to School Math

Ben puts 2 muffins on each of 5 plates. How many muffins is that in all?



Task card 20 Back to School Math

Zoe buys a bookmark for 25¢ and a name tag for 35¢. How many cents does Zoe spend?

Task card 21 Back to School Math

The bakery makes 176 granola bars. It sells 126 of them. How many granola bars are left?

Task card 22 Back to School Math

The bakery makes 324 granola bars. It sells 110 of them. How many granola bars are left?

Task card 23 Back to School Math

Lily puts 2 oatmeal cookies on each of 2 plates. How many oatmeal cookies is that in all?



Task card 24 Back to School Math

The school bakes 40 oatmeal cookies and 425 granola bars for the bake sale. How many treats is that in all?

Back to School Math Task Cards

Recording sheet · Grade 2 · Read each story and solve.

Name: _____ Date: _____

Scan to check your answers

1	2	3	4
5	6	7	8
9	10	11	12
13	14	15	16
17	18	19	20
21	22	23	24

Back to School Math Task Cards: Answer Key

Grade 2 · Medium

The answers online

1. 59	**2.** 60	**3.** 86
4. 14	**5.** 8	**6.** 4
7. 48	**8.** 50	**9.** 45
10. 70	**11.** 21	**12.** 395
13. 15	**14.** 9	**15.** 115
16. 338	**17.** 371	**18.** 55
19. 10	**20.** 60	**21.** 50
22. 214	**23.** 4	**24.** 465