Task card 1 Back to School Math

The school bakes 42 granola bars and 37 muffins for the bake sale. How many treats is that in all?

Task card 2 Back to School Math

Ben buys a bookmark for 20¢ and a name tag for 25¢. How many cents does Ben spend?

Task card 3 Back to School Math

The school bakes 20 muffins and 32 oatmeal cookies for the bake sale. How many treats is that in all?

Task card 4 Back to School Math

Lily buys a bookmark for 35¢ and a star sticker for 20¢. How many cents does Lily spend?

Task card 5 Back to School Math

The bakery makes 62 oatmeal cookies. It sells 24 of them. How many oatmeal cookies are left?

Task card 6 Back to School Math

Leo puts 3 muffins on each of 2 plates. How many muffins is that in all?



Task card 7 Back to School Math

Leo puts 4 muffins on each of 2 plates. How many muffins is that in all?



Task card 8 Back to School Math

The bakery makes 54 muffins. It sells 13 of them. How many muffins are left?

Task card 9 Back to School Math

Leo buys a bookmark for 15¢ and a star sticker for 20¢. How many cents does Leo spend?

Task card 10 Back to School Math

The bakery makes 58 muffins. It sells 19 of them. How many muffins are left?

Task card 11 Back to School Math

The school bakes 47 oatmeal cookies and 53 granola bars for the bake sale. How many treats is that in all?

Task card 12 Back to School Math

Zoe buys a bookmark for 30¢ and a name tag for 30¢. How many cents does Zoe spend?

Task card 13 Back to School Math

Mia puts 4 muffins on each of 3 plates. How many muffins is that in all?



Task card 14 Back to School Math

The bakery makes 47 granola bars. It sells 25 of them. How many granola bars are left?

Task card 15 Back to School Math

Ava puts 3 muffins on each of 3 plates. How many muffins is that in all?



Task card 16 Back to School Math

The school bakes 42 muffins and 12 oatmeal cookies for the bake sale. How many treats is that in all?

Task card 17 Back to School Math

The bakery makes 67 granola bars. It sells 58 of them. How many granola bars are left?

Task card 18 Back to School Math

Ava puts 2 muffins on each of 3 plates. How many muffins is that in all?



Task card 19 Back to School Math

The bakery makes 56 oatmeal cookies. It sells 11 of them. How many oatmeal cookies are left?

Task card 20 Back to School Math

Ella buys a bookmark for 35¢ and a name tag for 15¢. How many cents does Ella spend?

Task card 21 Back to School Math

Ava buys a star sticker for 10¢ and a name tag for 10¢. How many cents does Ava spend?

Task card 22 Back to School Math

The school bakes 49 muffins and 32 oatmeal cookies for the bake sale. How many treats is that in all?

Task card 23 Back to School Math

The school bakes 32 oatmeal cookies and 33 granola bars for the bake sale. How many treats is that in all?

Task card 24 Back to School Math

Ben puts 2 oatmeal cookies on each of 3 plates. How many oatmeal cookies is that in all?



Back to School Math Task Cards

Recording sheet · Grade 2 · Read each story and solve.

Name: _____ Date: _____

Scan to check your answers

1	2	3	4
5	6	7	8
9	10	11	12
13	14	15	16
17	18	19	20
21	22	23	24

Back to School Math Task Cards: Answer Key

Grade 2 · Easy

The answers online

1. 79	**2.** 45	**3.** 52
4. 55	**5.** 38	**6.** 6
7. 8	**8.** 41	**9.** 35
10. 39	**11.** 100	**12.** 60
13. 12	**14.** 22	**15.** 9
16. 54	**17.** 9	**18.** 6
19. 45	**20.** 50	**21.** 20
22. 81	**23.** 65	**24.** 6