Back to School Math · 1

Sam buys a bookmark for 40¢ and a star sticker for 40¢. How many cents does Sam spend?

Back to School Math · 2

The bakery makes 284 granola bars. It sells 114 of them. How many granola bars are left?

Back to School Math · 3

Omar puts 5 muffins on each of 5 plates. How many muffins is that in all?



Back to School Math · 4

The school bakes 88 oatmeal cookies and 53 granola bars for the bake sale. How many treats is that in all?

Back to School Math · 5

The school bakes 60 granola bars and 83 muffins for the bake sale. How many treats is that in all?

Back to School Math · 6

The bakery makes 223 oatmeal cookies. It sells 65 of them. How many oatmeal cookies are left?

Back to School Math · 7

Ava puts 4 granola bars on each of 4 plates. How many granola bars is that in all?



Back to School Math · 8

Leo buys a bookmark for 10¢ and a name tag for 50¢. How many cents does Leo spend?

Back to School Math · 2

ANSWER

170

Back to School Math · 1

ANSWER

80

Back to School Math · 4

ANSWER

141

Back to School Math · 3

ANSWER

25

Back to School Math · 6

ANSWER

158

Back to School Math · 5

ANSWER

143

Back to School Math · 8

ANSWER

60

Back to School Math · 7

ANSWER

16

Back to School Math · 9

The bakery makes 36 oatmeal cookies. It sells 24 of them. How many oatmeal cookies are left?

Back to School Math · 10

Ava puts 5 oatmeal cookies on each of 4 plates. How many oatmeal cookies is that in all?



Back to School Math · 11

The bakery makes 112 muffins. It sells 99 of them. How many muffins are left?

Back to School Math · 12

Mia buys a bookmark for 30¢ and a name tag for 55¢. How many cents does Mia spend?

Back to School Math · 13

Omar puts 3 granola bars on each of 2 plates. How many granola bars is that in all?



Back to School Math · 14

Ava buys a bookmark for 40¢ and a name tag for 10¢. How many cents does Ava spend?

Back to School Math · 15

The school bakes 198 oatmeal cookies and 83 muffins for the bake sale. How many treats is that in all?

Back to School Math · 16

The school bakes 163 granola bars and 120 muffins for the bake sale. How many treats is that in all?

Back to School Math · 10

ANSWER

20

Back to School Math · 9

ANSWER

12

Back to School Math · 12

ANSWER

85

Back to School Math · 11

ANSWER

13

Back to School Math · 14

ANSWER

50

Back to School Math · 13

ANSWER

6

Back to School Math · 16

ANSWER

283

Back to School Math · 15

ANSWER

281

Back to School Math · 17

The school bakes 225 granola bars and 123 muffins for the bake sale. How many treats is that in all?

Back to School Math · 18

Zoe puts 5 granola bars on each of 2 plates. How many granola bars is that in all?



Back to School Math · 19

The school bakes 222 oatmeal cookies and 64 muffins for the bake sale. How many treats is that in all?

Back to School Math · 20

The bakery makes 167 granola bars. It sells 70 of them. How many granola bars are left?

Back to School Math · 21

Mia buys a bookmark for 40¢ and a name tag for 25¢. How many cents does Mia spend?

Back to School Math · 22

Ava puts 5 muffins on each of 4 plates. How many muffins is that in all?



Back to School Math · 23

The bakery makes 488 muffins. It sells 63 of them. How many muffins are left?

Back to School Math · 24

Sam buys a name tag for 25¢ and a bookmark for 5¢. How many cents does Sam spend?

Back to School Math · 18

ANSWER

10

Back to School Math · 17

ANSWER

348

Back to School Math · 20

ANSWER

97

Back to School Math · 19

ANSWER

286

Back to School Math · 22

ANSWER

20

Back to School Math · 21

ANSWER

65

Back to School Math · 24

ANSWER

30

Back to School Math · 23

ANSWER

425