Task card 1 Area: Counting Square Units

What is the area of this shape in square units?



Task card 2 Area: Counting Square Units

What is the area of this shape in square units?



Task card 3 Area: Counting Square Units

What is the area of this shape in square units?

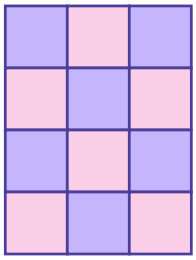

Task card 4 Area: Counting Square Units

What is the area of this shape in square units?

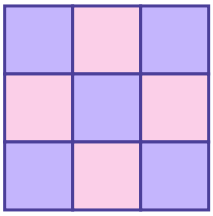

Task card 5 Area: Counting Square Units

What is the area of this shape in square units?

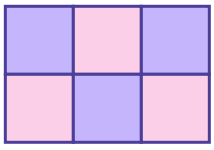

Task card 6 Area: Counting Square Units

What is the area of this shape in square units?



Task card 7 Area: Counting Square Units

What is the area of this shape in square units?

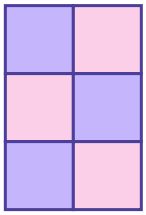

Task card 8 Area: Counting Square Units

What is the area of this shape in square units?

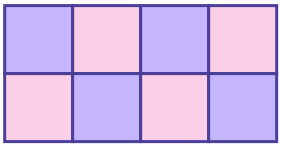

Task card 9 Area: Counting Square Units

What is the area of this shape in square units?

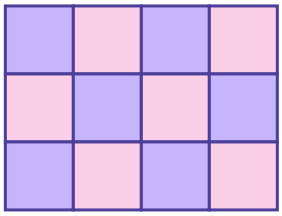

Task card 10 Area: Counting Square Units

What is the area of this shape in square units?

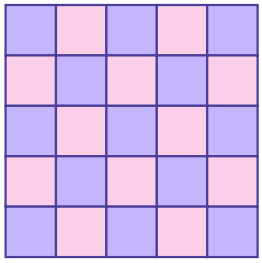

Task card 11 Area: Counting Square Units

What is the area of this shape in square units?



Task card 12 Area: Counting Square Units

What is the area of this shape in square units?

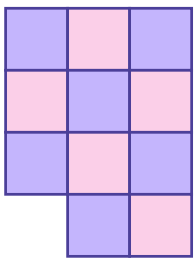

Task card 13 Area: Counting Square Units

What is the area of this shape in square units?

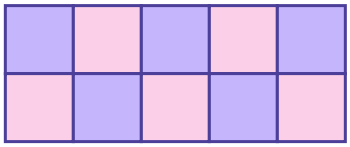

Task card 14 Area: Counting Square Units

What is the area of this shape in square units?

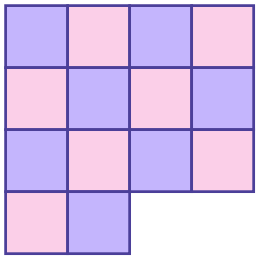

Task card 15 Area: Counting Square Units

What is the area of this shape in square units?

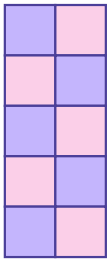

Task card 16 Area: Counting Square Units

What is the area of this shape in square units?

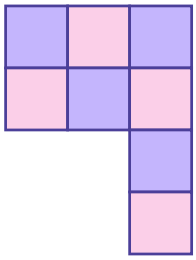

Task card 17 Area: Counting Square Units

What is the area of this shape in square units?

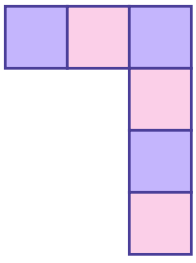

Task card 18 Area: Counting Square Units

What is the area of this shape in square units?

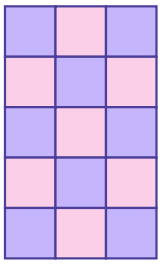

Task card 19 Area: Counting Square Units

What is the area of this shape in square units?

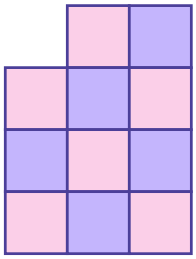

Task card 20 Area: Counting Square Units

What is the area of this shape in square units?

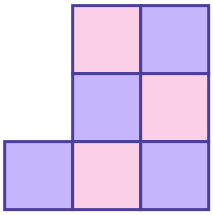

Task card 21 Area: Counting Square Units

What is the area of this shape in square units?

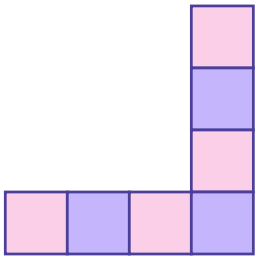

Task card 22 Area: Counting Square Units

What is the area of this shape in square units?

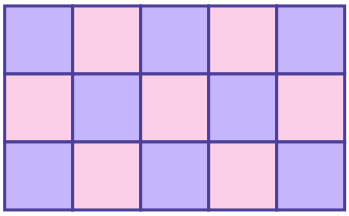

Task card 23 Area: Counting Square Units

What is the area of this shape in square units?

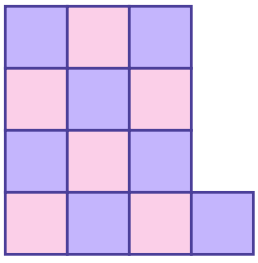

Area: Counting Square Units Task Cards

Recording sheet · Grade 2 · Count the colored squares inside each shape. Write the number of square units.

Name: _____ Date: _____

Scan to check your answers

1	2	3	4
5	6	7	8
9	10	11	12
13	14	15	16
17	18	19	20
21	22	23	

Area: Counting Square Units Task Cards: Answer Key

Grade 2 · Easy

The answers online

1. 8	**2.** 16	**3.** 12
4. 9	**5.** 6	**6.** 4
7. 6	**8.** 8	**9.** 12
10. 25	**11.** 20	**12.** 11
13. 10	**14.** 14	**15.** 10
16. 8	**17.** 6	**18.** 15
19. 11	**20.** 7	**21.** 7
22. 15	**23.** 13	