Area: Counting Square Units · 1

What is the area of this shape in square units?

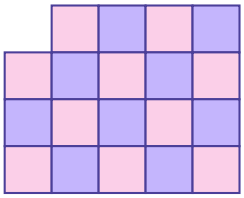

Area: Counting Square Units · 2

What is the area of this shape in square units?

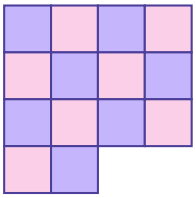

Area: Counting Square Units · 3

What is the area of this shape in square units?

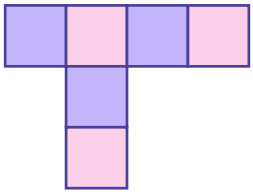

Area: Counting Square Units · 4

What is the area of this shape in square units?

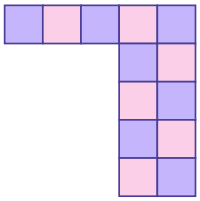

Area: Counting Square Units · 5

What is the area of this shape in square units?

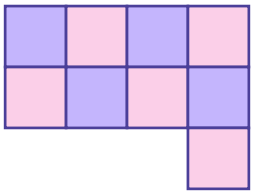

Area: Counting Square Units · 6

What is the area of this shape in square units?

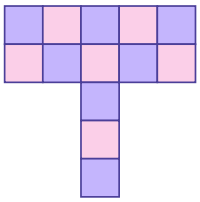

Area: Counting Square Units · 7

What is the area of this shape in square units?

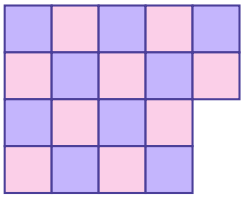

Area: Counting Square Units · 8

What is the area of this shape in square units?

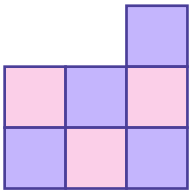

Area: Counting Square Units · 2

ANSWER

14

Area: Counting Square Units · 1

ANSWER

19

Area: Counting Square Units · 4

ANSWER

13

Area: Counting Square Units · 3

ANSWER

6

Area: Counting Square Units · 6

ANSWER

13

Area: Counting Square Units · 5

ANSWER

9

Area: Counting Square Units · 8

ANSWER

7

Area: Counting Square Units · 7

ANSWER

18

Area: Counting Square Units · 9

What is the area of this shape in square units?

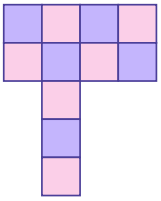

Area: Counting Square Units · 10

What is the area of this shape in square units?

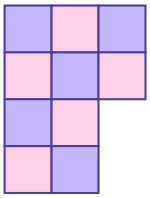

Area: Counting Square Units · 11

What is the area of this shape in square units?

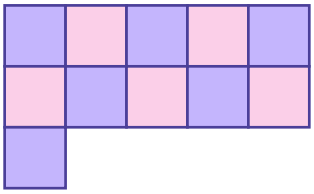

Area: Counting Square Units · 12

What is the area of this shape in square units?

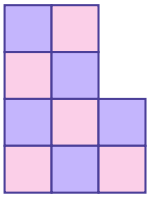

Area: Counting Square Units · 13

What is the area of this shape in square units?

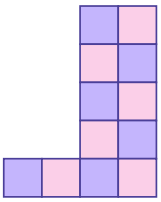

Area: Counting Square Units · 14

What is the area of this shape in square units?

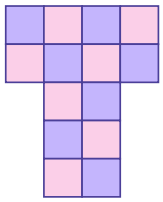

Area: Counting Square Units · 15

What is the area of this shape in square units?

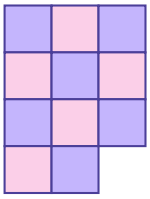

Area: Counting Square Units · 16

What is the area of this shape in square units?

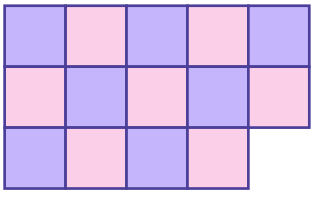

Area: Counting Square Units · 10

ANSWER

10

Area: Counting Square Units · 9

ANSWER

11

Area: Counting Square Units · 12

ANSWER

10

Area: Counting Square Units · 11

ANSWER

11

Area: Counting Square Units · 14

ANSWER

14

Area: Counting Square Units · 13

ANSWER

12

Area: Counting Square Units · 16

ANSWER

14

Area: Counting Square Units · 15

ANSWER

11

Area: Counting Square Units · 17

What is the area of this shape in square units?

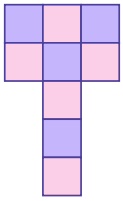

Area: Counting Square Units · 18

What is the area of this shape in square units?

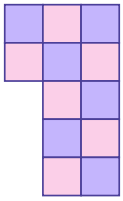

Area: Counting Square Units · 19

What is the area of this shape in square units?

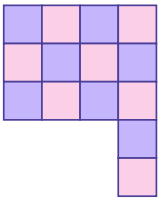

Area: Counting Square Units · 20

What is the area of this shape in square units?

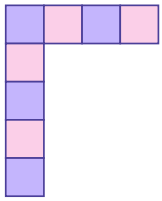

Area: Counting Square Units · 21

What is the area of this shape in square units?

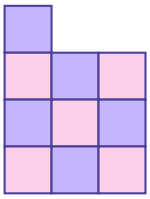

Area: Counting Square Units · 22

What is the area of this shape in square units?

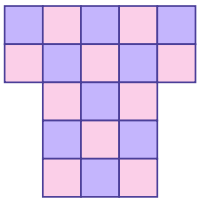

Area: Counting Square Units · 23

What is the area of this shape in square units?

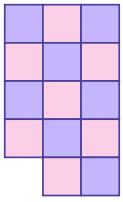

Area: Counting Square Units · 24

What is the area of this shape in square units?

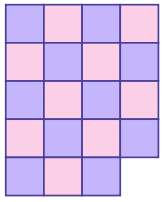

Area: Counting Square Units · 18

ANSWER

12

Area: Counting Square Units · 17

ANSWER

9

Area: Counting Square Units · 20

ANSWER

8

Area: Counting Square Units · 19

ANSWER

14

Area: Counting Square Units · 22

ANSWER

19

Area: Counting Square Units · 21

ANSWER

10

Area: Counting Square Units · 24

ANSWER

19

Area: Counting Square Units · 23

ANSWER

14