Task card 1 Adding Two-Digit Numbers (No Regro...

Add.

$$\begin{array}{r} 46 \\ +\ 23 \\ \hline \end{array}$$

Task card 2 Adding Two-Digit Numbers (No Regro...

Add.

$$\begin{array}{r} 31 \\ +\ 41 \\ \hline \end{array}$$

Task card 3 Adding Two-Digit Numbers (No Regro...

$47 + 22 = ___$

Task card 4 Adding Two-Digit Numbers (No Regro...

Add the tens, then the ones. 42 + 17 = ___

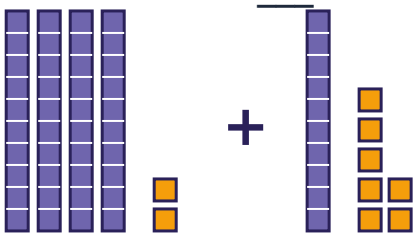

Task card 5 Adding Two-Digit Numbers (No Regro...

Tens: 40 + 40 = 80.

Ones: 6 + 1 = 7. So

$46 + 41 = ___$

Task card 6 Adding Two-Digit Numbers (No Regro...

$80 + ___ = 92$

Task card 7 Adding Two-Digit Numbers (No Regro...

Max has 37 crayons and gets 62 more. How many crayons does Max have now?

Task card 8 Adding Two-Digit Numbers (No Regro...

$28 + 41 = 31 + ___$

Task card 9 Adding Two-Digit Numbers (No Regro...

Add.

$$\begin{array}{r} 82 \\ +\ 11 \\ \hline \end{array}$$

Task card 10 Adding Two-Digit Numbers (No Regro...

Add.

$$\begin{array}{r} 55 \\ +\ 22 \\ \hline \end{array}$$

Task card 11 Adding Two-Digit Numbers (No Regro...

$55 + 21 = ___$

Task card 12 Adding Two-Digit Numbers (No Regro...

Add the tens, then the ones. 85 + 13 = ___

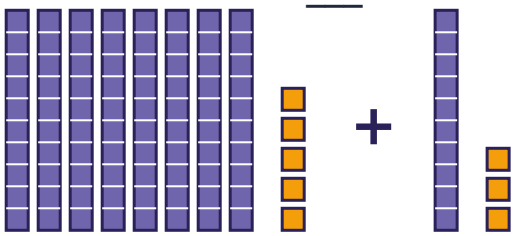

Task card 13 Adding Two-Digit Numbers (No Regro...

Tens: 10 + 60 = 70.

Ones: 8 + 1 = 9. So

18 + 61 = ___

Task card 14 Adding Two-Digit Numbers (No Regro...

88 + ___ = 99

Task card 15 Adding Two-Digit Numbers (No Regro...

Mia has 70 beads and gets 18 more. How many beads does Mia have now?

Task card 16 Adding Two-Digit Numbers (No Regro...

71 + 22 = 73 + ___

Task card 17 Adding Two-Digit Numbers (No Regro...

Add.

$$\begin{array}{r} 14 \\ +\ 15 \\ \hline \end{array}$$

Task card 18 Adding Two-Digit Numbers (No Regro...

Add.

$$\begin{array}{r} 53 \\ +\ 13 \\ \hline \end{array}$$

Task card 19 Adding Two-Digit Numbers (No Regro...

41 + 27 = ___

Task card 20 Adding Two-Digit Numbers (No Regro...

Add the tens, then the ones. 50 + 38 = ___

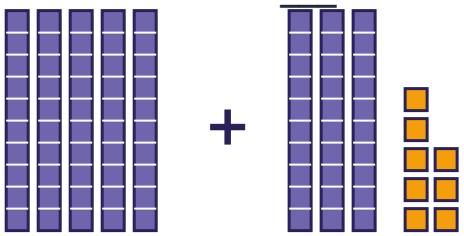

Task card 21 Adding Two-Digit Numbers (No Regro...

Tens: 40 + 40 = 80.

Ones: 1 + 1 = 2. So

41 + 41 = ___

Task card 22 Adding Two-Digit Numbers (No Regro...

10 + ___ = 37

Task card 23 Adding Two-Digit Numbers (No Regro...

Max has 73 beads and gets 13 more. How many beads does Max have now?

Task card 24 Adding Two-Digit Numbers (No Regro...

11 + 24 = 14 + ___

Adding Two-Digit Numbers (No Regrouping) Task Cards

Recording sheet · Grade 2 · Add the ones, then add the tens. The same kind of sum comes in different shapes.

Scan to check your answers

Name: _____ Date: _____

1	2	3	4
5	6	7	8
9	10	11	12
13	14	15	16
17	18	19	20
21	22	23	24

Adding Two-Digit Numbers (No Regrouping) Task Cards: Answer Key

Grade 2 · Medium

The answers online

1. 69	**2.** 72	**3.** 69
4. 59	**5.** 87	**6.** 12
7. 99	**8.** 38	**9.** 93
10. 77	**11.** 76	**12.** 98
13. 79	**14.** 11	**15.** 88
16. 20	**17.** 29	**18.** 66
19. 68	**20.** 88	**21.** 82
22. 27	**23.** 86	**24.** 21