Task card 1 Adding Two-Digit Numbers (No Regro...

Add.

$$\begin{array}{r} 16 \\ +\ 1 \\ \hline \end{array}$$

Task card 2 Adding Two-Digit Numbers (No Regro...

Add.

$$\begin{array}{r} 41 \\ +\ 6 \\ \hline \end{array}$$

Task card 3 Adding Two-Digit Numbers (No Regro...

$82 + 7 = ___$

Task card 4 Adding Two-Digit Numbers (No Regro...

Add the tens, then the ones. 77

$+ 2 = ___$

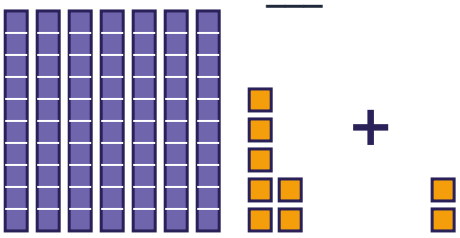

Task card 5 Adding Two-Digit Numbers (No Regro...

$___ + 4 = 59$

Task card 6 Adding Two-Digit Numbers (No Regro...

$18 + ___ = 19$

Task card 7 Adding Two-Digit Numbers (No Regro...

Mia has 73 shells and gets 6 more. How many shells does Mia have now?

Task card 8 Adding Two-Digit Numbers (No Regro...

16 + 2 = 17 + ___

Task card 9 Adding Two-Digit Numbers (No Regro...

Add.

$$\begin{array}{r} 47 \\ +\ 2 \\ \hline \end{array}$$

Task card 10 Adding Two-Digit Numbers (No Regro...

Add.

$$\begin{array}{r} 30 \\ +\ 5 \\ \hline \end{array}$$

Task card 11 Adding Two-Digit Numbers (No Regro...

45 + 2 = ___

Task card 12 Adding Two-Digit Numbers (No Regro...

Add the tens, then the ones. 62

+ 1 = ___

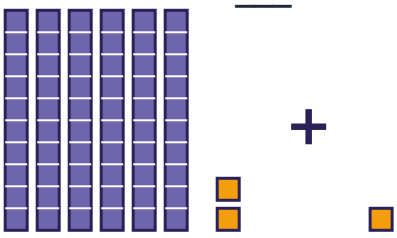

Task card 13 Adding Two-Digit Numbers (No Regro...

$$__ + 5 = 49$$

Task card 14 Adding Two-Digit Numbers (No Regro...

$$41 + __ = 49$$

Task card 15 Adding Two-Digit Numbers (No Regro...

Ben has 28 beads and gets 1 more. How many beads does Ben have now?

Task card 16 Adding Two-Digit Numbers (No Regro...

$$42 + 3 = 44 + __$$

Task card 17 Adding Two-Digit Numbers (No Regro...

Add.

$$\begin{array}{r} 31 \\ +\ 56 \\ \hline \end{array}$$

Task card 18 Adding Two-Digit Numbers (No Regro...

Add.

$$\begin{array}{r} 66 \\ +\ 12 \\ \hline \end{array}$$

Task card 19 Adding Two-Digit Numbers (No Regro...

$48 + 31 = ___$

Task card 20 Adding Two-Digit Numbers (No Regro...

Add the tens, then the ones. 71 + 26 = ___

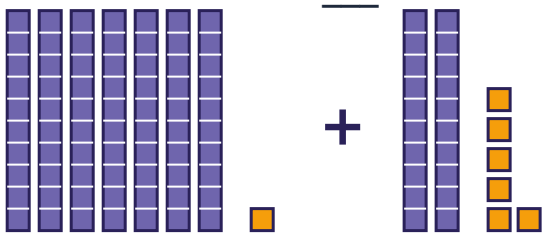

Task card 21 Adding Two-Digit Numbers (No Regro...

$___ + 10 = 63$

Task card 22 Adding Two-Digit Numbers (No Regro...

$66 + ___ = 76$

Task card 23 Adding Two-Digit Numbers (No Regro...

Mia has 62 beads and gets 34 more. How many beads does Mia have now?

Task card 24 Adding Two-Digit Numbers (No Regro...

$43 + 53 = 45 + ___$

Adding Two-Digit Numbers (No Regrouping) Task Cards

Recording sheet · Grade 2 · Add the ones, then add the tens. The same kind of sum comes in different shapes.

Scan to check your answers

Name: _____ Date: _____

1	2	3	4
5	6	7	8
9	10	11	12
13	14	15	16
17	18	19	20
21	22	23	24

Adding Two-Digit Numbers (No Regrouping) Task Cards: Answer Key

Grade 2 · Easy

The answers online

1. 17	**2.** 47	**3.** 89
4. 79	**5.** 55	**6.** 1
7. 79	**8.** 1	**9.** 49
10. 35	**11.** 47	**12.** 63
13. 44	**14.** 8	**15.** 29
16. 1	**17.** 87	**18.** 78
19. 79	**20.** 97	**21.** 53
22. 10	**23.** 96	**24.** 51