Adding Three & Four Numbers · 1

$21 + 15 + 1 = ___$

Adding Three & Four Numbers · 2

Count the tens, then the ones. 27 + 18 + 2 = ___

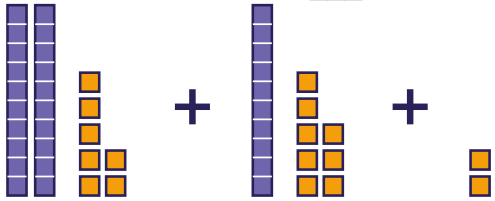

Adding Three & Four Numbers · 3

Find the pair that is easy to add first: 16 + 4 = 20. So 16 + 28 + 4 = ___

Adding Three & Four Numbers · 4

Add two numbers first: 36 + 21 = 57. Then 57 + 6 = ___

Adding Three & Four Numbers · 5

A jar has 16 red, 25 blue and 4 green beads. How many beads are in the jar?

Adding Three & Four Numbers · 6

$35 + 14 + ___ = 50$

Adding Three & Four Numbers · 7

$26 + 13 + 60 = ___$

Adding Three & Four Numbers · 8

Count the tens, then the ones. 35 + 27 + 26 = ___

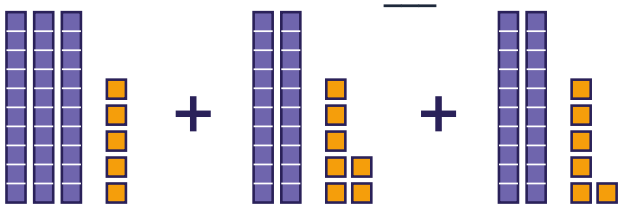

Adding Three & Four Numbers · 2

ANSWER

47

Adding Three & Four Numbers · 1

ANSWER

37

Adding Three & Four Numbers · 4

ANSWER

63

Adding Three & Four Numbers · 3

ANSWER

48

Adding Three & Four Numbers · 6

ANSWER

1

Adding Three & Four Numbers · 5

ANSWER

45

Adding Three & Four Numbers · 8

ANSWER

88

Adding Three & Four Numbers · 7

ANSWER

99

Adding Three & Four Numbers · 9

Find the pair that is easy to add first: 32 + 28 = 60. So 32 + 28 + 12 = ___

Adding Three & Four Numbers · 10

Add two numbers first: 18 + 29 = 47. Then 47 + 41 = ___

Adding Three & Four Numbers · 11

A jar has 14 red, 19 blue and 34 green beads. How many beads are in the jar?

Adding Three & Four Numbers · 12

29 + 29 + ___ = 98

Adding Three & Four Numbers · 13

30 + 29 + 12 = ___

Adding Three & Four Numbers · 14

Tens: 30 + 40 + 10 = 80. Ones: 5 + 0 + 3 = 8. So 35 + 40 + 13 = ___

Adding Three & Four Numbers · 15

Find the pair that is easy to add first: 12 + 28 = 40. So 12 + 46 + 28 = ___

Adding Three & Four Numbers · 16

Add two numbers first: 21 + 41 = 62. Then 62 + 45 = ___

Adding Three & Four Numbers · 10

ANSWER

88

Adding Three & Four Numbers · 9

ANSWER

72

Adding Three & Four Numbers · 12

ANSWER

40

Adding Three & Four Numbers · 11

ANSWER

67

Adding Three & Four Numbers · 14

ANSWER

88

Adding Three & Four Numbers · 13

ANSWER

71

Adding Three & Four Numbers · 16

ANSWER

107

Adding Three & Four Numbers · 15

ANSWER

86

Adding Three & Four Numbers · 17

A jar has 44 red, 14 blue and 29 green beads. How many beads are in the jar?

Adding Three & Four Numbers · 18

$18 + 24 + ___ = 63$

Adding Three & Four Numbers · 19

$14 + 24 + 7 = ___$

Adding Three & Four Numbers · 20

Count the tens, then the ones. 14 + 19 + 1 = ___

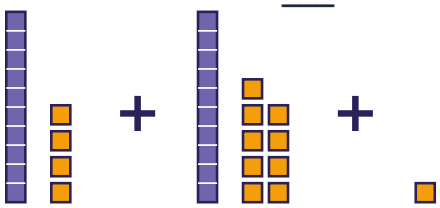

Adding Three & Four Numbers · 21

Find the pair that is easy to add first: 25 + 5 = 30. So 23 + 25 + 5 = ___

Adding Three & Four Numbers · 22

Add two numbers first: 15 + 20 = 35. Then 35 + 3 = ___

Adding Three & Four Numbers · 23

A jar has 15 red, 25 blue and 9 green beads. How many beads are in the jar?

Adding Three & Four Numbers · 24

$20 + 11 + ___ = 34$

Adding Three & Four Numbers · 18

ANSWER

21

Adding Three & Four Numbers · 17

ANSWER

87

Adding Three & Four Numbers · 20

ANSWER

34

Adding Three & Four Numbers · 19

ANSWER

45

Adding Three & Four Numbers · 22

ANSWER

38

Adding Three & Four Numbers · 21

ANSWER

53

Adding Three & Four Numbers · 24

ANSWER

3

Adding Three & Four Numbers · 23

ANSWER

49