Task card 1 2-Digit Subtraction with Borrowing...

Subtract.

$$\begin{array}{r} 45 \\ -\ 17 \\ \hline \end{array}$$

Task card 2 2-Digit Subtraction with Borrowing...

Subtract.

$$\begin{array}{r} 53 \\ -\ 26 \\ \hline \end{array}$$

Task card 3 2-Digit Subtraction with Borrowing...

$74 - 36 = ___$

Task card 4 2-Digit Subtraction with Borrowing...

The blocks show 67. Take away 39. How many are left?

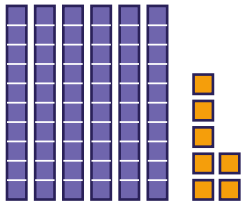

Task card 5 2-Digit Subtraction with Borrowing...

Take away the tens, then the ones: $65 - 40 = 25$, then take away 6 more.

$65 - 46 = ___$

Task card 6 2-Digit Subtraction with Borrowing...

$42 - ___ = 17$

Task card 7 2-Digit Subtraction with Borrowing...

Lily has 72 buttons and gives away 67. How many buttons does Lily have left?

Task card 8 2-Digit Subtraction with Borrowing...

$61 - 56 = 58 - ___$

Task card 9 2-Digit Subtraction with Borrowing...

Subtract.

$$\begin{array}{r} 71 \\ -\ 56 \\ \hline \end{array}$$

Task card 10 2-Digit Subtraction with Borrowing...

Subtract.

$$\begin{array}{r} 73 \\ -\ 64 \\ \hline \end{array}$$

Task card 11 2-Digit Subtraction with Borrowing...

$64 - 56 = ___$

Task card 12 2-Digit Subtraction with Borrowing...

The blocks show 85. Take away 69. How many are left?



Task card 13 2-Digit Subtraction with Borrowing...

Take away the tens, then the ones: 91 − 20 = 71, then take away 3 more.

91 − 23 = ___

Task card 14 2-Digit Subtraction with Borrowing...

91 − ___ = 2

Task card 15 2-Digit Subtraction with Borrowing...

Ava has 71 buttons and gives away 66. How many buttons does Ava have left?

Task card 16 2-Digit Subtraction with Borrowing...

92 − 55 = 89 − ___

Task card 17 2-Digit Subtraction with Borrowing...

Subtract.

```
  90
? 39
```

Task card 18 2-Digit Subtraction with Borrowing...

Subtract.

```
  90
? 15
```

Task card 19 2-Digit Subtraction with Borrowing...

$70 - 52 = ___$

Task card 20 2-Digit Subtraction with Borrowing...

The blocks show 60. Take away 22. How many are left?



Task card 21 2-Digit Subtraction with Borrowing...

Take away the tens, then the ones: $80 - 40 = 40$, then take away 2 more.

$80 - 42 = ___$

Task card 22 2-Digit Subtraction with Borrowing...

$80 - ___ = 47$

Task card 23 2-Digit Subtraction with Borrowing...

Max has 90 beads and gives away 24. How many beads does Max have left?

Task card 24 2-Digit Subtraction with Borrowing...

$80 - 67 = 77 - ___$

2-Digit Subtraction with Borrowing (Every Problem) Task Cards

Recording sheet · Grade 2 · Every problem needs borrowing. The same kind of sum comes in different shapes.

Scan to check your answers

Name: _____ Date: _____

1	2	3	4
5	6	7	8
9	10	11	12
13	14	15	16
17	18	19	20
21	22	23	24

2-Digit Subtraction with Borrowing (Every Problem) Task Cards: Answer Key

Grade 2 · Medium

The answers online

1. 28	**2.** 27	**3.** 38
4. 28	**5.** 19	**6.** 25
7. 5	**8.** 53	**9.** 15
10. 9	**11.** 8	**12.** 16
13. 68	**14.** 89	**15.** 5
16. 52	**17.** 51	**18.** 75
19. 18	**20.** 38	**21.** 38
22. 33	**23.** 66	**24.** 64