Task card 1 2-Digit Addition with Regrouping (...

Add.

$$\begin{array}{r} 53 \\ +\ 18 \\ \hline \end{array}$$

Task card 2 2-Digit Addition with Regrouping (...

Add.

$$\begin{array}{r} 36 \\ +\ 16 \\ \hline \end{array}$$

Task card 3 2-Digit Addition with Regrouping (...

$29 + 33 = ___$

Task card 4 2-Digit Addition with Regrouping (...

Add the tens, then the ones. 15 + 59 =

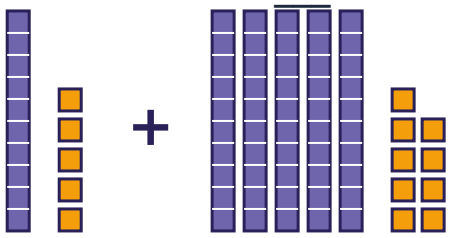

Task card 5 2-Digit Addition with Regrouping (...

Tens: 50 + 30 = 80.

Ones: 7 + 9 = 16. So

$57 + 39 = ___$

Task card 6 2-Digit Addition with Regrouping (...

$17 + ___ = 82$

Task card 7 2-Digit Addition with Regrouping (...

Ava has 26 buttons and gets 35 more. How many buttons does Ava have now?

Task card 8 2-Digit Addition with Regrouping (...

$68 + 24 = 70 +$ ___

Task card 9 2-Digit Addition with Regrouping (...

Add.

$$\begin{array}{r} 58 \\ +\ 34 \\ \hline \end{array}$$

Task card 10 2-Digit Addition with Regrouping (...

Add.

$$\begin{array}{r} 49 \\ +\ 49 \\ \hline \end{array}$$

Task card 11 2-Digit Addition with Regrouping (...

$37 + 58 =$ ___

Task card 12 2-Digit Addition with Regrouping (...

Add the tens, then the ones. 28 + 58 =

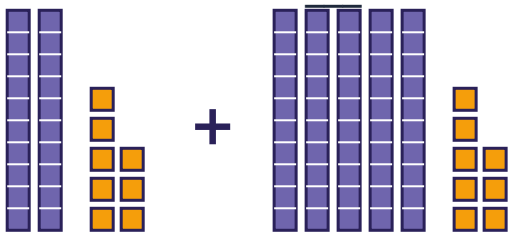

Task card 13 2-Digit Addition with Regrouping (...

Tens: 20 + 60 = 80.

Ones: 6 + 7 = 13. So

26 + 67 = ___

Task card 14 2-Digit Addition with Regrouping (...

59 + ___ = 94

Task card 15 2-Digit Addition with Regrouping (...

Mia has 59 marbles and gets 38 more. How many marbles does Mia have now?

Task card 16 2-Digit Addition with Regrouping (...

35 + 59 = 36 + ___

Task card 17 2-Digit Addition with Regrouping (...

Add.

$$\begin{array}{r} 44 \\ +\ 68 \\ \hline \end{array}$$

Task card 18 2-Digit Addition with Regrouping (...

Add.

$$\begin{array}{r} 34 \\ +\ 87 \\ \hline \end{array}$$

Task card 19 2-Digit Addition with Regrouping (...

$44 + 98 = ___$

Task card 20 2-Digit Addition with Regrouping (...

Add the tens, then the ones. 46 + 54 = ___

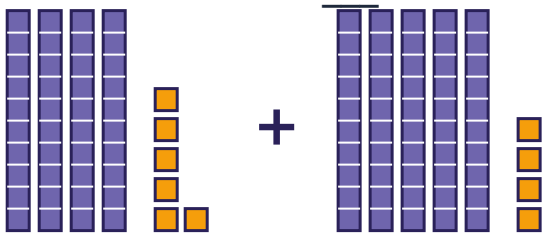

Task card 21 2-Digit Addition with Regrouping (...

Tens: 40 + 60 = 100. Ones: 4 + 6 = 10. So 44 + 66 = ___

Task card 22 2-Digit Addition with Regrouping (...

$57 + ___ = 136$

Task card 23 2-Digit Addition with Regrouping (...

Lily has 59 cards and gets 74 more. How many cards does Lily have now?

Task card 24 2-Digit Addition with Regrouping (...

$54 + 69 = 56 + ___$

2-Digit Addition with Regrouping (Every Problem) Task Cards

Recording sheet · Grade 2 · Every problem needs regrouping. The same kind of sum comes in different shapes.

Scan to check your answers

Name: _____ Date: _____

1	2	3	4
5	6	7	8
9	10	11	12
13	14	15	16
17	18	19	20
21	22	23	24

2-Digit Addition with Regrouping (Every Problem) Task Cards: Answer Key

Grade 2 · Medium

The answers online

1. 71	**2.** 52	**3.** 62
4. 74	**5.** 96	**6.** 65
7. 61	**8.** 22	**9.** 92
10. 98	**11.** 95	**12.** 86
13. 93	**14.** 35	**15.** 97
16. 58	**17.** 112	**18.** 121
19. 142	**20.** 100	**21.** 110
22. 79	**23.** 133	**24.** 67