Task card 1 2-Digit Addition with Regrouping (...

$18 + 32 = ___$

Task card 2 2-Digit Addition with Regrouping (...

$32 + 18 = ___$

Task card 3 2-Digit Addition with Regrouping (...

Add.

$$\begin{array}{r} 26 \\ +\ 24 \\ \hline \end{array}$$

Task card 4 2-Digit Addition with Regrouping (...

Add the tens, then the ones. 12 + 18 = ___

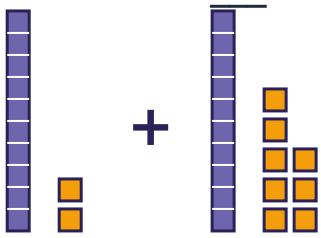

Task card 5 2-Digit Addition with Regrouping (...

Tens: 10 + 10 = 20.

Ones: 4 + 9 = 13. So

$14 + 19 = ___$

Task card 6 2-Digit Addition with Regrouping (...

$16 + ___ = 32$

Task card 7 2-Digit Addition with Regrouping (...

Lily has 28 buttons and gets 17 more. How many buttons does Lily have now?

Task card 8 2-Digit Addition with Regrouping (...

$12 + 29 = 13 +$ ___

Task card 9 2-Digit Addition with Regrouping (...

$45 + 18 =$ ___

Task card 10 2-Digit Addition with Regrouping (...

$25 + 45 =$ ___

Task card 11 2-Digit Addition with Regrouping (...

Add.

$$\begin{array}{r} 25 \\ +\ 18 \\ \hline \end{array}$$

Task card 12 2-Digit Addition with Regrouping (...

Add the tens, then the ones. 27 + 26 = ___

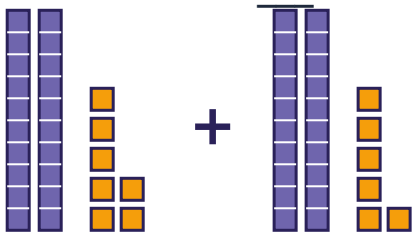

Task card 13 2-Digit Addition with Regrouping (...

Tens: 30 + 10 = 40.

Ones: 6 + 4 = 10. So

36 + 14 = ___

Task card 14 2-Digit Addition with Regrouping (...

37 + ___ = 62

Task card 15 2-Digit Addition with Regrouping (...

Max has 29 toy cars and gets 16 more. How many toy cars does Max have now?

Task card 16 2-Digit Addition with Regrouping (...

19 + 26 = 22 + ___

Task card 17 2-Digit Addition with Regrouping (...

77 + 19 = ___

Task card 18 2-Digit Addition with Regrouping (...

19 + 49 = ___

Task card 19 2-Digit Addition with Regrouping (...

Add.

$$\begin{array}{r} 28 \\ +\ 64 \\ \hline \end{array}$$

Task card 20 2-Digit Addition with Regrouping (...

Add the tens, then the ones. 37 + 34 = ___

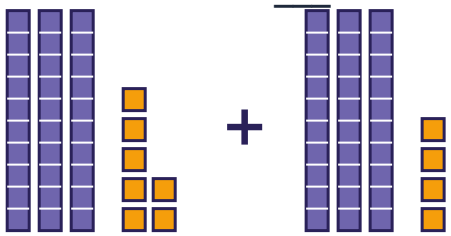

Task card 21 2-Digit Addition with Regrouping (...

Tens: 10 + 60 = 70.

Ones: 5 + 6 = 11. So 15 + 66 = ___

Task card 22 2-Digit Addition with Regrouping (...

16 + ___ = 82

Task card 23 2-Digit Addition with Regrouping (...

Ben has 38 stickers and gets 32 more. How many stickers does Ben have now?

Task card 24 2-Digit Addition with Regrouping (...

48 + 18 = 50 + ___

2-Digit Addition with Regrouping (Every Problem) Task Cards

Recording sheet · Grade 2 · Every problem needs regrouping. The same kind of sum comes in different shapes.

Scan to check your answers

Name: _____ Date: _____

1	2	3	4
5	6	7	8
9	10	11	12
13	14	15	16
17	18	19	20
21	22	23	24

2-Digit Addition with Regrouping (Every Problem) Task Cards: Answer Key

Grade 2 · Easy

The answers online

1. 50	**2.** 50	**3.** 50
4. 30	**5.** 33	**6.** 16
7. 45	**8.** 28	**9.** 63
10. 70	**11.** 43	**12.** 53
13. 50	**14.** 25	**15.** 45
16. 23	**17.** 96	**18.** 68
19. 92	**20.** 71	**21.** 81
22. 66	**23.** 70	**24.** 16