Add.

$$\begin{array}{r} 53 \\ +\ 18 \\ \hline \end{array}$$

Add.

$$\begin{array}{r} 36 \\ +\ 16 \\ \hline \end{array}$$

$29 + 33 = ___$

Add the tens, then the ones.

$15 + 59 = ___$

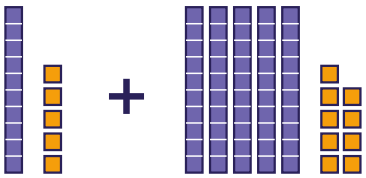

Tens: 50 + 30 = 80.

Ones: 7 + 9 = 16. So 57 + 39 = ___

$17 + ___ = 82$

Ava has 26 buttons and gets 35 more. How many buttons does Ava have now?

$68 + 24 = 70 +$ ___

2-Digit Addition with Regrouping (Every Problem) · 2

ANSWER

52

2-Digit Addition with Regrouping (Every Problem) · 1

ANSWER

71

2-Digit Addition with Regrouping (Every Problem) · 4

ANSWER

74

2-Digit Addition with Regrouping (Every Problem) · 3

ANSWER

62

2-Digit Addition with Regrouping (Every Problem) · 6

ANSWER

65

2-Digit Addition with Regrouping (Every Problem) · 5

ANSWER

96

2-Digit Addition with Regrouping (Every Problem) · 8

ANSWER

22

2-Digit Addition with Regrouping (Every Problem) · 7

ANSWER

61

Add.

$$\begin{array}{r} 58 \\ +\ 34 \\ \hline \end{array}$$

Add.

$$\begin{array}{r} 49 \\ +\ 49 \\ \hline \end{array}$$

$37 + 58 = ___$

Add the tens, then the ones.

$28 + 58 = ___$

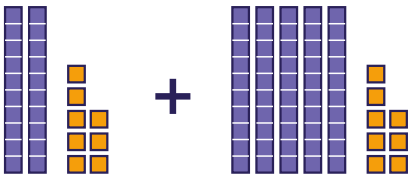

Tens: 20 + 60 = 80.

Ones: 6 + 7 = 13. So 26 + 67 = ___

$59 + ___ = 94$

Mia has 59 marbles and gets 38 more. How many marbles does Mia have now?

$35 + 59 = 36 + ___$

2-Digit Addition with Regrouping (Every Problem) · 10

ANSWER

98

2-Digit Addition with Regrouping (Every Problem) · 9

ANSWER

92

2-Digit Addition with Regrouping (Every Problem) · 12

ANSWER

86

2-Digit Addition with Regrouping (Every Problem) · 11

ANSWER

95

2-Digit Addition with Regrouping (Every Problem) · 14

ANSWER

35

2-Digit Addition with Regrouping (Every Problem) · 13

ANSWER

93

2-Digit Addition with Regrouping (Every Problem) · 16

ANSWER

58

2-Digit Addition with Regrouping (Every Problem) · 15

ANSWER

97

2-Digit Addition with Regrouping (Every Problem) · 17

Add.

$$\begin{array}{r} 44 \\ +\ 68 \\ \hline \end{array}$$

2-Digit Addition with Regrouping (Every Problem) · 18

Add.

$$\begin{array}{r} 34 \\ +\ 87 \\ \hline \end{array}$$

2-Digit Addition with Regrouping (Every Problem) · 19

$44 + 98 = ___$

2-Digit Addition with Regrouping (Every Problem) · 20

Add the tens, then the ones.

46 + 54 = ___

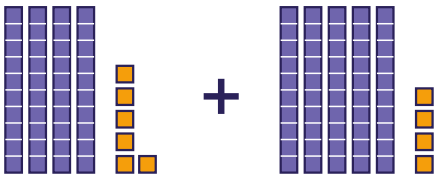

2-Digit Addition with Regrouping (Every Problem) · 21

Tens: 40 + 60 = 100. Ones: 4 + 6 = 10. So 44 + 66 = ___

2-Digit Addition with Regrouping (Every Problem) · 22

$57 + ___ = 136$

2-Digit Addition with Regrouping (Every Problem) · 23

Lily has 59 cards and gets 74 more. How many cards does Lily have now?

2-Digit Addition with Regrouping (Every Problem) · 24

$54 + 69 = 56 + ___$

2-Digit Addition with Regrouping (Every Problem) · 18

ANSWER

121

2-Digit Addition with Regrouping (Every Problem) · 17

ANSWER

112

2-Digit Addition with Regrouping (Every Problem) · 20

ANSWER

100

2-Digit Addition with Regrouping (Every Problem) · 19

ANSWER

142

2-Digit Addition with Regrouping (Every Problem) · 22

ANSWER

79

2-Digit Addition with Regrouping (Every Problem) · 21

ANSWER

110

2-Digit Addition with Regrouping (Every Problem) · 24

ANSWER

67

2-Digit Addition with Regrouping (Every Problem) · 23

ANSWER

133