2-Digit Addition with Regrouping (Every Problem) · 1

$18 + 32 = ___$

2-Digit Addition with Regrouping (Every Problem) · 2

$32 + 18 = ___$

2-Digit Addition with Regrouping (Every Problem) · 3

Add.

$$\begin{array}{r} 26 \\ +\ 24 \\ \hline \end{array}$$

2-Digit Addition with Regrouping (Every Problem) · 4

Add the tens, then the ones.

12 + 18 = ___

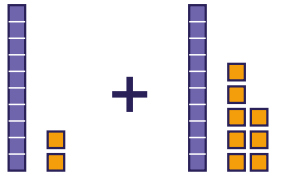

2-Digit Addition with Regrouping (Every Problem) · 5

Tens: 10 + 10 = 20.

Ones: 4 + 9 = 13. So 14 + 19 = ___

2-Digit Addition with Regrouping (Every Problem) · 6

16 + ___ = 32

2-Digit Addition with Regrouping (Every Problem) · 7

Lily has 28 buttons and gets 17 more. How many buttons does Lily have now?

2-Digit Addition with Regrouping (Every Problem) · 8

12 + 29 = 13 + ___

2-Digit Addition with Regrouping (Every Problem) · 2

ANSWER

50

2-Digit Addition with Regrouping (Every Problem) · 1

ANSWER

50

2-Digit Addition with Regrouping (Every Problem) · 4

ANSWER

30

2-Digit Addition with Regrouping (Every Problem) · 3

ANSWER

50

2-Digit Addition with Regrouping (Every Problem) · 6

ANSWER

16

2-Digit Addition with Regrouping (Every Problem) · 5

ANSWER

33

2-Digit Addition with Regrouping (Every Problem) · 8

ANSWER

28

2-Digit Addition with Regrouping (Every Problem) · 7

ANSWER

45

$45 + 18 = ___$

$25 + 45 = ___$

Add.

$$\begin{array}{r} 25 \\ +\ 18 \\ \hline \end{array}$$

Add the tens, then the ones.

27 + 26 = ___

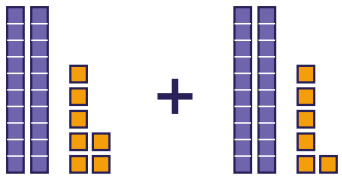

Tens: 30 + 10 = 40.

Ones: 6 + 4 = 10. So 36 + 14 = ___

$37 + ___ = 62$

Max has 29 toy cars and gets 16 more. How many toy cars does Max have now?

$19 + 26 = 22 + ___$

2-Digit Addition with Regrouping (Every Problem) · 10

ANSWER

70

2-Digit Addition with Regrouping (Every Problem) · 9

ANSWER

63

2-Digit Addition with Regrouping (Every Problem) · 12

ANSWER

53

2-Digit Addition with Regrouping (Every Problem) · 11

ANSWER

43

2-Digit Addition with Regrouping (Every Problem) · 14

ANSWER

25

2-Digit Addition with Regrouping (Every Problem) · 13

ANSWER

50

2-Digit Addition with Regrouping (Every Problem) · 16

ANSWER

23

2-Digit Addition with Regrouping (Every Problem) · 15

ANSWER

45

$$77 + 19 = ___$$

$$19 + 49 = ___$$

Add.

$$\begin{array}{r} 28 \\ +\ 64 \\ \hline \end{array}$$

Add the tens, then the ones.

37 + 34 = ___

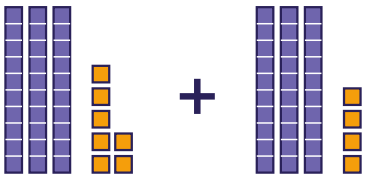

Tens: 10 + 60 = 70.

Ones: 5 + 6 = 11. So 15 + 66 = ___

$$16 + ___ = 82$$

Ben has 38 stickers and gets 32 more. How many stickers does Ben have now?

$$48 + 18 = 50 + ___$$

2-Digit Addition with Regrouping (Every Problem) · 18

ANSWER

68

2-Digit Addition with Regrouping (Every Problem) · 17

ANSWER

96

2-Digit Addition with Regrouping (Every Problem) · 20

ANSWER

71

2-Digit Addition with Regrouping (Every Problem) · 19

ANSWER

92

2-Digit Addition with Regrouping (Every Problem) · 22

ANSWER

66

2-Digit Addition with Regrouping (Every Problem) · 21

ANSWER

81

2-Digit Addition with Regrouping (Every Problem) · 24

ANSWER

16

2-Digit Addition with Regrouping (Every Problem) · 23

ANSWER

70