**Task card 1** 100th Day of School Math

Ella buys a paper crown for 30¢ and a balloon for 5¢. How many cents does Ella spend?

**Task card 2** 100th Day of School Math

The bakery makes 131 cupcakes. It sells 64 of them. How many cupcakes are left?

**Task card 3** 100th Day of School Math

Ava buys a paper crown for 45¢ and a balloon for 20¢. How many cents does Ava spend?

**Task card 4** 100th Day of School Math

The school bakes 48 cookies and 147 cupcakes for the bake sale. How many treats is that in all?

**Task card 5** 100th Day of School Math

The school bakes 135 pretzels and 302 cupcakes for the bake sale. How many treats is that in all?

**Task card 6** 100th Day of School Math

Omar puts 2 cookies on each of 4 plates. How many cookies is that in all?



**Task card 7** 100th Day of School Math

The bakery makes 194 pretzels. It sells 175 of them. How many pretzels are left?

**Task card 8** 100th Day of School Math

Noah puts 3 cookies on each of 2 plates. How many cookies is that in all?



**Task card 9** 100th Day of School Math

The school bakes 233 cupcakes and 62 pretzels for the bake sale. How many treats is that in all?

**Task card 10** 100th Day of School Math

Ben puts 2 cookies on each of 3 plates. How many cookies is that in all?



**Task card 11** 100th Day of School Math

Mia buys a balloon for 10¢ and a gold star sticker for 60¢. How many cents does Mia spend?

**Task card 12** 100th Day of School Math

Lily puts 3 pretzels on each of 3 plates. How many pretzels is that in all?



**Task card 13** 100th Day of School Math

The school bakes 168 cookies and 93 cupcakes for the bake sale. How many treats is that in all?

**Task card 14** 100th Day of School Math

The bakery makes 136 pretzels. It sells 118 of them. How many pretzels are left?

**Task card 15** 100th Day of School Math

Sam buys a gold star sticker for 25¢ and a paper crown for 35¢. How many cents does Sam spend?

**Task card 16** 100th Day of School Math

The bakery makes 294 pretzels. It sells 109 of them. How many pretzels are left?

**Task card 17** 100th Day of School Math

Omar puts 4 cupcakes on each of 2 plates. How many cupcakes is that in all?



**Task card 18** 100th Day of School Math

Omar puts 2 pretzels on each of 5 plates. How many pretzels is that in all?



**Task card 19** 100th Day of School Math

The school bakes 158 cookies and 18 cupcakes for the bake sale. How many treats is that in all?

**Task card 20** 100th Day of School Math

The bakery makes 392 cupcakes. It sells 358 of them. How many cupcakes are left?

**Task card 21** 100th Day of School Math

The school bakes 165 pretzels and 203 cookies for the bake sale. How many treats is that in all?

**Task card 22** 100th Day of School Math

Leo buys a balloon for 30¢ and a gold star sticker for 20¢. How many cents does Leo spend?

**Task card 23** 100th Day of School Math

Omar buys a gold star sticker for 15¢ and a paper crown for 40¢. How many cents does Omar spend?

**Task card 24** 100th Day of School Math

The bakery makes 108 cupcakes. It sells 51 of them. How many cupcakes are left?

# 100th Day of School Math Task Cards

Recording sheet · Grade 2 · Read each story and solve.

Name: _____ Date: _____

Scan to check your answers

| | | | |
|---|---|---|---|
| 1 | 2 | 3 | 4 |
| 5 | 6 | 7 | 8 |
| 9 | 10 | 11 | 12 |
| 13 | 14 | 15 | 16 |
| 17 | 18 | 19 | 20 |
| 21 | 22 | 23 | 24 |

# 100th Day of School Math Task Cards: Answer Key

Grade 2 · Hard

The answers online

| | | |
|---|---|---|
| **1.** 35 | **2.** 67 | **3.** 65 |
| **4.** 195 | **5.** 437 | **6.** 8 |
| **7.** 19 | **8.** 6 | **9.** 295 |
| **10.** 6 | **11.** 70 | **12.** 9 |
| **13.** 261 | **14.** 18 | **15.** 60 |
| **16.** 185 | **17.** 8 | **18.** 10 |
| **19.** 176 | **20.** 34 | **21.** 368 |
| **22.** 50 | **23.** 55 | **24.** 57 |