**Task card 1** 100th Day of School Math

The bakery makes 91 cookies. It sells 30 of them. How many cookies are left?

**Task card 2** 100th Day of School Math

Leo buys a gold star sticker for 20¢ and a paper crown for 15¢. How many cents does Leo spend?

**Task card 3** 100th Day of School Math

The school bakes 48 cupcakes and 17 cookies for the bake sale. How many treats is that in all?

**Task card 4** 100th Day of School Math

Omar buys a gold star sticker for 30¢ and a balloon for 15¢. How many cents does Omar spend?

**Task card 5** 100th Day of School Math

The bakery makes 37 cupcakes. It sells 11 of them. How many cupcakes are left?

**Task card 6** 100th Day of School Math

Zoe puts 2 pretzels on each of 2 plates. How many pretzels is that in all?



**Task card 7** 100th Day of School Math

The school bakes 47 pretzels and 31 cookies for the bake sale. How many treats is that in all?

**Task card 8** 100th Day of School Math

Zoe puts 4 cookies on each of 2 plates. How many cookies is that in all?



**Task card 9** 100th Day of School Math

Ella buys a balloon for 10¢ and a gold star sticker for 20¢. How many cents does Ella spend?

**Task card 10** 100th Day of School Math

Omar puts 4 cookies on each of 2 plates. How many cookies is that in all?



**Task card 11** 100th Day of School Math

The school bakes 32 cupcakes and 38 pretzels for the bake sale. How many treats is that in all?

**Task card 12** 100th Day of School Math

Noah puts 3 cookies on each of 3 plates. How many cookies is that in all?



**Task card 13** 100th Day of School Math

The school bakes 19 cookies and 22 cupcakes for the bake sale. How many treats is that in all?

**Task card 14** 100th Day of School Math

Ella buys a gold star sticker for 20¢ and a paper crown for 20¢. How many cents does Ella spend?

**Task card 15** 100th Day of School Math

The bakery makes 55 cupcakes. It sells 45 of them. How many cupcakes are left?

**Task card 16** 100th Day of School Math

The bakery makes 65 pretzels. It sells 44 of them. How many pretzels are left?

**Task card 17** 100th Day of School Math

Ben puts 2 cookies on each of 2 plates. How many cookies is that in all?



**Task card 18** 100th Day of School Math

The bakery makes 65 cookies. It sells 44 of them. How many cookies are left?

**Task card 19** 100th Day of School Math

Sam buys a balloon for 10¢ and a paper crown for 20¢. How many cents does Sam spend?

**Task card 20** 100th Day of School Math

The school bakes 13 cookies and 17 cupcakes for the bake sale. How many treats is that in all?

**Task card 21** 100th Day of School Math

Ava buys a paper crown for 10¢ and a gold star sticker for 10¢. How many cents does Ava spend?

**Task card 22** 100th Day of School Math

The bakery makes 78 cookies. It sells 42 of them. How many cookies are left?

**Task card 23** 100th Day of School Math

The school bakes 43 pretzels and 15 cookies for the bake sale. How many treats is that in all?

**Task card 24** 100th Day of School Math

Ella puts 3 cookies on each of 3 plates. How many cookies is that in all?



# 100th Day of School Math Task Cards

Recording sheet · Grade 2 · Read each story and solve.

Name: _____ Date: _____

Scan to check your answers

| | | | |
|---|---|---|---|
| 1 | 2 | 3 | 4 |
| 5 | 6 | 7 | 8 |
| 9 | 10 | 11 | 12 |
| 13 | 14 | 15 | 16 |
| 17 | 18 | 19 | 20 |
| 21 | 22 | 23 | 24 |

# 100th Day of School Math Task Cards: Answer Key

Grade 2 · Easy

The answers online

| | | |
|---|---|---|
| **1.** 61 | **2.** 35 | **3.** 65 |
| **4.** 45 | **5.** 26 | **6.** 4 |
| **7.** 78 | **8.** 8 | **9.** 30 |
| **10.** 8 | **11.** 70 | **12.** 9 |
| **13.** 41 | **14.** 40 | **15.** 10 |
| **16.** 21 | **17.** 4 | **18.** 21 |
| **19.** 30 | **20.** 30 | **21.** 20 |
| **22.** 36 | **23.** 58 | **24.** 9 |