Task card 1 100th Day of School Math

The bakery makes 91 cookies. It sells 30 of them. How many cookies are left?

Task card 2 100th Day of School Math

Leo buys a gold star sticker for 20¢ and a paper crown for 15¢. How many cents does Leo spend?

Task card 3 100th Day of School Math

The school bakes 48 cupcakes and 17 cookies for the bake sale. How many treats is that in all?

Task card 4 100th Day of School Math

Omar buys a gold star sticker for 30¢ and a balloon for 15¢. How many cents does Omar spend?

Task card 5 100th Day of School Math

The bakery makes 37 cupcakes. It sells 11 of them. How many cupcakes are left?

Task card 6 100th Day of School Math

Zoe puts 2 pretzels on each of 2 plates. How many pretzels is that in all?



Task card 7 100th Day of School Math

The school bakes 47 pretzels and 31 cookies for the bake sale. How many treats is that in all?

Task card 8 100th Day of School Math

Zoe puts 4 cookies on each of 2 plates. How many cookies is that in all?



Task card 9 100th Day of School Math

Ella buys a balloon for 10¢ and a gold star sticker for 20¢. How many cents does Ella spend?

Task card 10 100th Day of School Math

Omar puts 4 cookies on each of 2 plates. How many cookies is that in all?



Task card 11 100th Day of School Math

The school bakes 32 cupcakes and 38 pretzels for the bake sale. How many treats is that in all?

Task card 12 100th Day of School Math

Noah puts 3 cookies on each of 3 plates. How many cookies is that in all?



Task card 13 100th Day of School Math

The school bakes 19 cookies and 22 cupcakes for the bake sale. How many treats is that in all?

Task card 14 100th Day of School Math

Ella buys a gold star sticker for 20¢ and a paper crown for 20¢. How many cents does Ella spend?

Task card 15 100th Day of School Math

The bakery makes 55 cupcakes. It sells 45 of them. How many cupcakes are left?

Task card 16 100th Day of School Math

The bakery makes 65 pretzels. It sells 44 of them. How many pretzels are left?

Task card 17 100th Day of School Math

Ben puts 2 cookies on each of 2 plates. How many cookies is that in all?



Task card 18 100th Day of School Math

The bakery makes 65 cookies. It sells 44 of them. How many cookies are left?

Task card 19 100th Day of School Math

Sam buys a balloon for 10¢ and a paper crown for 20¢. How many cents does Sam spend?

Task card 20 100th Day of School Math

The school bakes 13 cookies and 17 cupcakes for the bake sale. How many treats is that in all?

Task card 21 100th Day of School Math

Ava buys a paper crown for 10¢ and a gold star sticker for 10¢. How many cents does Ava spend?

Task card 22 100th Day of School Math

The bakery makes 78 cookies. It sells 42 of them. How many cookies are left?

Task card 23 100th Day of School Math

The school bakes 43 pretzels and 15 cookies for the bake sale. How many treats is that in all?

Task card 24 100th Day of School Math

Ella puts 3 cookies on each of 3 plates. How many cookies is that in all?



100th Day of School Math Task Cards

Recording sheet · Grade 2 · Read each story and solve.

Name: _____ Date: _____

Scan to check your answers

1	2	3	4
5	6	7	8
9	10	11	12
13	14	15	16
17	18	19	20
21	22	23	24

100th Day of School Math Task Cards: Answer Key

Grade 2 · Easy

The answers online

1. 61	**2.** 35	**3.** 65
4. 45	**5.** 26	**6.** 4
7. 78	**8.** 8	**9.** 30
10. 8	**11.** 70	**12.** 9
13. 41	**14.** 40	**15.** 10
16. 21	**17.** 4	**18.** 21
19. 30	**20.** 30	**21.** 20
22. 36	**23.** 58	**24.** 9