100th Day of School Math · 1

The bakery makes 90 pretzels. It sells 72 of them. How many pretzels are left?

100th Day of School Math · 2

Ben puts 4 cupcakes on each of 4 plates. How many cupcakes is that in all?



100th Day of School Math · 3

Sam buys a paper crown for 30¢ and a gold star sticker for 30¢. How many cents does Sam spend?

100th Day of School Math · 4

Zoe buys a gold star sticker for 20¢ and a balloon for 30¢. How many cents does Zoe spend?

100th Day of School Math · 5

The school bakes 14 pretzels and 63 cookies for the bake sale. How many treats is that in all?

100th Day of School Math · 6

The school bakes 23 pretzels and 66 cookies for the bake sale. How many treats is that in all?

100th Day of School Math · 7

The bakery makes 37 cupcakes. It sells 24 of them. How many cupcakes are left?

100th Day of School Math · 8

Ben puts 3 cupcakes on each of 3 plates. How many cupcakes is that in all?



100th Day of School Math · 2

ANSWER

16

100th Day of School Math · 1

ANSWER

18

100th Day of School Math · 4

ANSWER

50

100th Day of School Math · 3

ANSWER

60

100th Day of School Math · 6

ANSWER

89

100th Day of School Math · 5

ANSWER

77

100th Day of School Math · 8

ANSWER

9

100th Day of School Math · 7

ANSWER

13

100th Day of School Math · 9

Noah puts 4 cupcakes on each of 2 plates. How many cupcakes is that in all?



100th Day of School Math · 10

The bakery makes 392 cookies. It sells 217 of them. How many cookies are left?

100th Day of School Math · 11

The school bakes 250 cookies and 222 cupcakes for the bake sale. How many treats is that in all?

100th Day of School Math · 12

The bakery makes 206 cookies. It sells 47 of them. How many cookies are left?

100th Day of School Math · 13

Ava buys a paper crown for 20¢ and a balloon for 30¢. How many cents does Ava spend?

100th Day of School Math · 14

Noah puts 3 cupcakes on each of 2 plates. How many cupcakes is that in all?



100th Day of School Math · 15

The school bakes 113 pretzels and 128 cookies for the bake sale. How many treats is that in all?

100th Day of School Math · 16

Omar buys a balloon for 40¢ and a gold star sticker for 20¢. How many cents does Omar spend?

100th Day of School Math · 10

ANSWER

175

100th Day of School Math · 9

ANSWER

8

100th Day of School Math · 12

ANSWER

159

100th Day of School Math · 11

ANSWER

472

100th Day of School Math · 14

ANSWER

6

100th Day of School Math · 13

ANSWER

50

100th Day of School Math · 16

ANSWER

60

100th Day of School Math · 15

ANSWER

241

100th Day of School Math · 17

Leo buys a paper crown for 25¢ and a gold star sticker for 10¢. How many cents does Leo spend?

100th Day of School Math · 18

The bakery makes 217 pretzels. It sells 15 of them. How many pretzels are left?

100th Day of School Math · 19

The bakery makes 208 pretzels. It sells 78 of them. How many pretzels are left?

100th Day of School Math · 20

The school bakes 231 pretzels and 262 cookies for the bake sale. How many treats is that in all?

100th Day of School Math · 21

Ava puts 3 pretzels on each of 3 plates. How many pretzels is that in all?



100th Day of School Math · 22

Ava puts 2 pretzels on each of 4 plates. How many pretzels is that in all?



100th Day of School Math · 23

Leo buys a balloon for 15¢ and a paper crown for 10¢. How many cents does Leo spend?

100th Day of School Math · 24

The school bakes 124 cookies and 302 cupcakes for the bake sale. How many treats is that in all?

100th Day of School Math · 18

ANSWER

202

100th Day of School Math · 17

ANSWER

35

100th Day of School Math · 20

ANSWER

493

100th Day of School Math · 19

ANSWER

130

100th Day of School Math · 22

ANSWER

8

100th Day of School Math · 21

ANSWER

9

100th Day of School Math · 24

ANSWER

426

100th Day of School Math · 23

ANSWER

25