100th Day of School Math · 1

Ella buys a paper crown for 30¢ and a balloon for 5¢. How many cents does Ella spend?

100th Day of School Math · 2

The bakery makes 131 cupcakes. It sells 64 of them. How many cupcakes are left?

100th Day of School Math · 3

Ava buys a paper crown for 45¢ and a balloon for 20¢. How many cents does Ava spend?

100th Day of School Math · 4

The school bakes 48 cookies and 147 cupcakes for the bake sale. How many treats is that in all?

100th Day of School Math · 5

The school bakes 135 pretzels and 302 cupcakes for the bake sale. How many treats is that in all?

100th Day of School Math · 6

Omar puts 2 cookies on each of 4 plates. How many cookies is that in all?



100th Day of School Math · 7

The bakery makes 194 pretzels. It sells 175 of them. How many pretzels are left?

100th Day of School Math · 8

Noah puts 3 cookies on each of 2 plates. How many cookies is that in all?



100th Day of School Math · 2

ANSWER

67

100th Day of School Math · 1

ANSWER

35

100th Day of School Math · 4

ANSWER

195

100th Day of School Math · 3

ANSWER

65

100th Day of School Math · 6

ANSWER

8

100th Day of School Math · 5

ANSWER

437

100th Day of School Math · 8

ANSWER

6

100th Day of School Math · 7

ANSWER

19

100th Day of School Math · 9

The school bakes 233 cupcakes and 62 pretzels for the bake sale. How many treats is that in all?

100th Day of School Math · 10

Ben puts 2 cookies on each of 3 plates. How many cookies is that in all?



100th Day of School Math · 11

Mia buys a balloon for 10¢ and a gold star sticker for 60¢. How many cents does Mia spend?

100th Day of School Math · 12

Lily puts 3 pretzels on each of 3 plates. How many pretzels is that in all?



100th Day of School Math · 13

The school bakes 168 cookies and 93 cupcakes for the bake sale. How many treats is that in all?

100th Day of School Math · 14

The bakery makes 136 pretzels. It sells 118 of them. How many pretzels are left?

100th Day of School Math · 15

Sam buys a gold star sticker for 25¢ and a paper crown for 35¢. How many cents does Sam spend?

100th Day of School Math · 16

The bakery makes 294 pretzels. It sells 109 of them. How many pretzels are left?

100th Day of School Math · 10

ANSWER

6

100th Day of School Math · 9

ANSWER

295

100th Day of School Math · 12

ANSWER

9

100th Day of School Math · 11

ANSWER

70

100th Day of School Math · 14

ANSWER

18

100th Day of School Math · 13

ANSWER

261

100th Day of School Math · 16

ANSWER

185

100th Day of School Math · 15

ANSWER

60

100th Day of School Math · 17

Omar puts 4 cupcakes on each of 2 plates. How many cupcakes is that in all?



100th Day of School Math · 18

Omar puts 2 pretzels on each of 5 plates. How many pretzels is that in all?



100th Day of School Math · 19

The school bakes 158 cookies and 18 cupcakes for the bake sale. How many treats is that in all?

100th Day of School Math · 20

The bakery makes 392 cupcakes. It sells 358 of them. How many cupcakes are left?

100th Day of School Math · 21

The school bakes 165 pretzels and 203 cookies for the bake sale. How many treats is that in all?

100th Day of School Math · 22

Leo buys a balloon for 30¢ and a gold star sticker for 20¢. How many cents does Leo spend?

100th Day of School Math · 23

Omar buys a gold star sticker for 15¢ and a paper crown for 40¢. How many cents does Omar spend?

100th Day of School Math · 24

The bakery makes 108 cupcakes. It sells 51 of them. How many cupcakes are left?

100th Day of School Math · 18

ANSWER

10

100th Day of School Math · 17

ANSWER

8

100th Day of School Math · 20

ANSWER

34

100th Day of School Math · 19

ANSWER

176

100th Day of School Math · 22

ANSWER

50

100th Day of School Math · 21

ANSWER

368

100th Day of School Math · 24

ANSWER

57

100th Day of School Math · 23

ANSWER

55