100th Day of School Math · 1

The bakery makes 91 cookies. It sells 30 of them. How many cookies are left?

100th Day of School Math · 2

Leo buys a gold star sticker for 20¢ and a paper crown for 15¢. How many cents does Leo spend?

100th Day of School Math · 3

The school bakes 48 cupcakes and 17 cookies for the bake sale. How many treats is that in all?

100th Day of School Math · 4

Omar buys a gold star sticker for 30¢ and a balloon for 15¢. How many cents does Omar spend?

100th Day of School Math · 5

The bakery makes 37 cupcakes. It sells 11 of them. How many cupcakes are left?

100th Day of School Math · 6

Zoe puts 2 pretzels on each of 2 plates. How many pretzels is that in all?



100th Day of School Math · 7

The school bakes 47 pretzels and 31 cookies for the bake sale. How many treats is that in all?

100th Day of School Math · 8

Zoe puts 4 cookies on each of 2 plates. How many cookies is that in all?



100th Day of School Math · 2

ANSWER

35

100th Day of School Math · 1

ANSWER

61

100th Day of School Math · 4

ANSWER

45

100th Day of School Math · 3

ANSWER

65

100th Day of School Math · 6

ANSWER

4

100th Day of School Math · 5

ANSWER

26

100th Day of School Math · 8

ANSWER

8

100th Day of School Math · 7

ANSWER

78

100th Day of School Math · 9

Ella buys a balloon for 10¢ and a gold star sticker for 20¢. How many cents does Ella spend?

100th Day of School Math · 10

Omar puts 4 cookies on each of 2 plates. How many cookies is that in all?



100th Day of School Math · 11

The school bakes 32 cupcakes and 38 pretzels for the bake sale. How many treats is that in all?

100th Day of School Math · 12

Noah puts 3 cookies on each of 3 plates. How many cookies is that in all?



100th Day of School Math · 13

The school bakes 19 cookies and 22 cupcakes for the bake sale. How many treats is that in all?

100th Day of School Math · 14

Ella buys a gold star sticker for 20¢ and a paper crown for 20¢. How many cents does Ella spend?

100th Day of School Math · 15

The bakery makes 55 cupcakes. It sells 45 of them. How many cupcakes are left?

100th Day of School Math · 16

The bakery makes 65 pretzels. It sells 44 of them. How many pretzels are left?

100th Day of School Math · 10

ANSWER

8

100th Day of School Math · 9

ANSWER

30

100th Day of School Math · 12

ANSWER

9

100th Day of School Math · 11

ANSWER

70

100th Day of School Math · 14

ANSWER

40

100th Day of School Math · 13

ANSWER

41

100th Day of School Math · 16

ANSWER

21

100th Day of School Math · 15

ANSWER

10

100th Day of School Math · 17

Ben puts 2 cookies on each of 2 plates. How many cookies is that in all?



100th Day of School Math · 18

The bakery makes 65 cookies. It sells 44 of them. How many cookies are left?

100th Day of School Math · 19

Sam buys a balloon for 10¢ and a paper crown for 20¢. How many cents does Sam spend?

100th Day of School Math · 20

The school bakes 13 cookies and 17 cupcakes for the bake sale. How many treats is that in all?

100th Day of School Math · 21

Ava buys a paper crown for 10¢ and a gold star sticker for 10¢. How many cents does Ava spend?

100th Day of School Math · 22

The bakery makes 78 cookies. It sells 42 of them. How many cookies are left?

100th Day of School Math · 23

The school bakes 43 pretzels and 15 cookies for the bake sale. How many treats is that in all?

100th Day of School Math · 24

Ella puts 3 cookies on each of 3 plates. How many cookies is that in all?



100th Day of School Math · 18

ANSWER

21

100th Day of School Math · 17

ANSWER

4

100th Day of School Math · 20

ANSWER

30

100th Day of School Math · 19

ANSWER

30

100th Day of School Math · 22

ANSWER

36

100th Day of School Math · 21

ANSWER

20

100th Day of School Math · 24

ANSWER

9

100th Day of School Math · 23

ANSWER

58