Coterminal & Reference Angles (Degrees & Radians) · 1

Find the angle between 0° and 360° that is coterminal with 430°.

Coterminal & Reference Angles (Degrees & Radians) · 2

In which quadrant does the terminal side of 30° lie?

Coterminal & Reference Angles (Degrees & Radians) · 3

Find the reference angle of 340°.

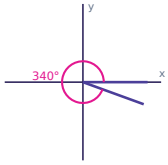


Coterminal & Reference Angles (Degrees & Radians) · 4

Find the angle between 0° and 360° that is coterminal with 560°.

Coterminal & Reference Angles (Degrees & Radians) · 5

Find the angle between 0° and 360° that is coterminal with 550°.

Coterminal & Reference Angles (Degrees & Radians) · 6

In which quadrant does the terminal side of 280° lie?

Coterminal & Reference Angles (Degrees & Radians) · 7

Find the reference angle of 160°.

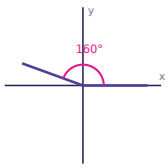


Coterminal & Reference Angles (Degrees & Radians) · 8

Find the angle between 0° and 360° that is coterminal with 590°.

Coterminal & Reference Angles (Degrees & Radians) · 2

**ANSWER**

**I**

Coterminal & Reference Angles (Degrees & Radians) · 1

**ANSWER**

**70°**

Coterminal & Reference Angles (Degrees & Radians) · 4

**ANSWER**

**200°**

Coterminal & Reference Angles (Degrees & Radians) · 3

**ANSWER**

**20°**

Coterminal & Reference Angles (Degrees & Radians) · 6

**ANSWER**

**IV**

Coterminal & Reference Angles (Degrees & Radians) · 5

**ANSWER**

**190°**

Coterminal & Reference Angles (Degrees & Radians) · 8

**ANSWER**

**230°**

Coterminal & Reference Angles (Degrees & Radians) · 7

**ANSWER**

**20°**

Coterminal & Reference Angles (Degrees & Radians) · 9

Find the angle between 0° and 360° that is coterminal with -130°.

Coterminal & Reference Angles (Degrees & Radians) · 10

Find the reference angle of 330°.

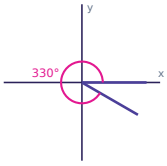


Coterminal & Reference Angles (Degrees & Radians) · 11

In which quadrant does the terminal side of 250° lie?

Coterminal & Reference Angles (Degrees & Radians) · 12

Find the angle between -360° and 0° that is coterminal with 120°.

Coterminal & Reference Angles (Degrees & Radians) · 13

Find the reference angle of 290°.

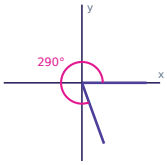


Coterminal & Reference Angles (Degrees & Radians) · 14

Find the angle between 0° and 360° that is coterminal with 770°.

Coterminal & Reference Angles (Degrees & Radians) · 15

Find the angle between 0° and 360° that is coterminal with -290°.

Coterminal & Reference Angles (Degrees & Radians) · 16

Find the reference angle of 100°.

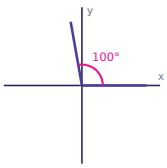

Coterminal & Reference Angles (Degrees & Radians) · 10

**ANSWER**

**30°**

Coterminal & Reference Angles (Degrees & Radians) · 9

**ANSWER**

**230°**

Coterminal & Reference Angles (Degrees & Radians) · 12

**ANSWER**

**-240°**

Coterminal & Reference Angles (Degrees & Radians) · 11

**ANSWER**

**III**

Coterminal & Reference Angles (Degrees & Radians) · 14

**ANSWER**

**50°**

Coterminal & Reference Angles (Degrees & Radians) · 13

**ANSWER**

**70°**

Coterminal & Reference Angles (Degrees & Radians) · 16

**ANSWER**

**80°**

Coterminal & Reference Angles (Degrees & Radians) · 15

**ANSWER**

**70°**

Coterminal & Reference Angles (Degrees & Radians) · 17

Find the angle between 0° and 360° that is coterminal with 520°.

Coterminal & Reference Angles (Degrees & Radians) · 18

Find the reference angle of 285°.

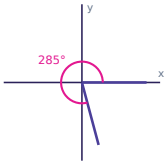


Coterminal & Reference Angles (Degrees & Radians) · 19

In which quadrant does the terminal side of 460° lie?

Coterminal & Reference Angles (Degrees & Radians) · 20

Find the angle between -360° and 0° that is coterminal with 335°.

Coterminal & Reference Angles (Degrees & Radians) · 21

Find the angle between 0° and 360° that is coterminal with 405°.

Coterminal & Reference Angles (Degrees & Radians) · 22

Find the angle between 0° and 360° that is coterminal with -280°.

Coterminal & Reference Angles (Degrees & Radians) · 23

Find the reference angle of 170°.

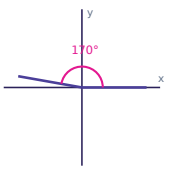


Coterminal & Reference Angles (Degrees & Radians) · 24

Find the angle between 0° and 360° that is coterminal with 620°.

Coterminal & Reference Angles (Degrees & Radians) · 18

**ANSWER**

**75°**

Coterminal & Reference Angles (Degrees & Radians) · 17

**ANSWER**

**160°**

Coterminal & Reference Angles (Degrees & Radians) · 20

**ANSWER**

**-25°**

Coterminal & Reference Angles (Degrees & Radians) · 19

**ANSWER**

**II**

Coterminal & Reference Angles (Degrees & Radians) · 22

**ANSWER**

**80°**

Coterminal & Reference Angles (Degrees & Radians) · 21

**ANSWER**

**45°**

Coterminal & Reference Angles (Degrees & Radians) · 24

**ANSWER**

**260°**

Coterminal & Reference Angles (Degrees & Radians) · 23

**ANSWER**

**10°**