Task card 1 Volume & Surface Area (Mixed Revie...

Find the volume of a rectangular prism with length 2, width 5, and height 4.

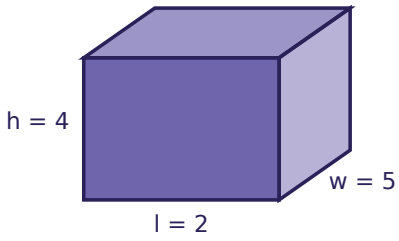

Task card 2 Volume & Surface Area (Mixed Revie...

Find the surface area of a rectangular prism with length 3, width 3, and height 4.

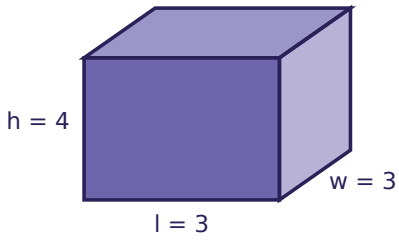

Task card 3 Volume & Surface Area (Mixed Revie...

Find the volume of a rectangular prism with length 4, width 3, and height 4.

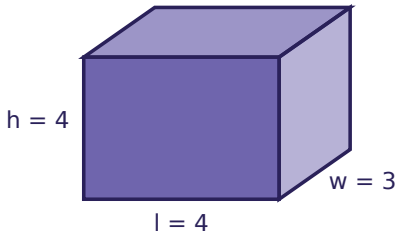

Task card 4 Volume & Surface Area (Mixed Revie...

Find the surface area of a rectangular prism with length 2, width 2, and height 5.

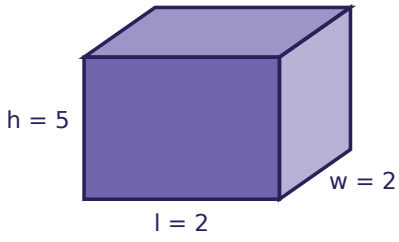

Task card 5 Volume & Surface Area (Mixed Revie...

Find the volume of a rectangular prism with length 2, width 5, and height 3.

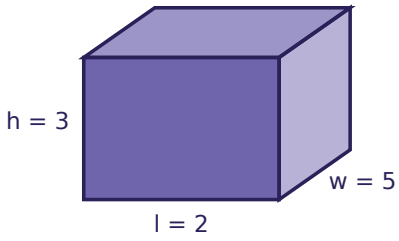

Task card 6 Volume & Surface Area (Mixed Revie...

Find the surface area of a rectangular prism with length 5, width 4, and height 5.

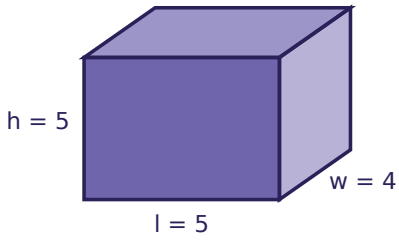

Task card 7 Volume & Surface Area (Mixed Revie...

Find the volume of a rectangular prism with length 4, width 5, and height 5.

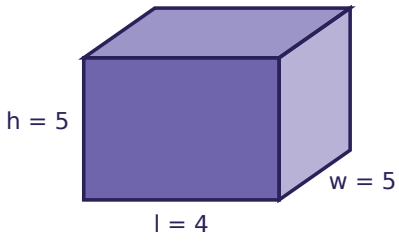

Task card 8 Volume & Surface Area (Mixed Revie...

Find the surface area of a rectangular prism with length 4, width 2, and height 4.

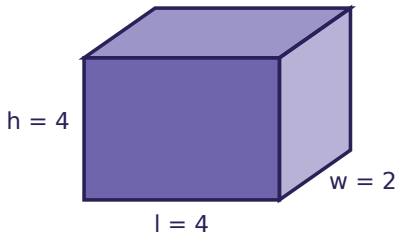

Task card 9 Volume & Surface Area (Mixed Revie...

Find the volume of a rectangular prism with length 2, width 3, and height 6.

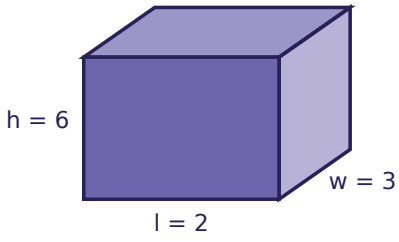

Task card 10 Volume & Surface Area (Mixed Revie...

Find the surface area of a rectangular prism with length 6, width 5, and height 5.

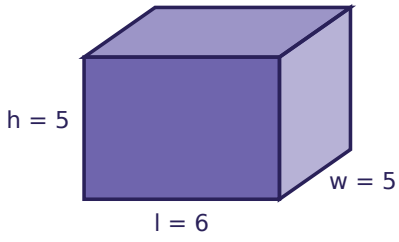

Task card 11 Volume & Surface Area (Mixed Revie...

Find the volume of a rectangular prism with length 3, width 4, and height 3.

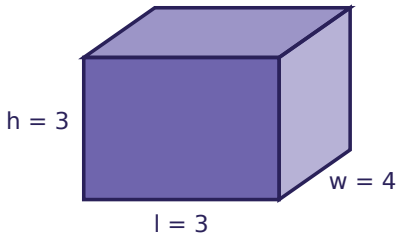

Task card 12 Volume & Surface Area (Mixed Revie...

Find the surface area of a rectangular prism with length 2, width 2, and height 6.

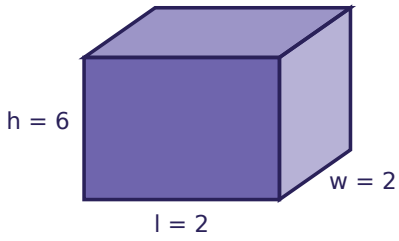

Task card 13 Volume & Surface Area (Mixed Revie...

Find the volume of a rectangular prism with length 5, width 3, and height 3.

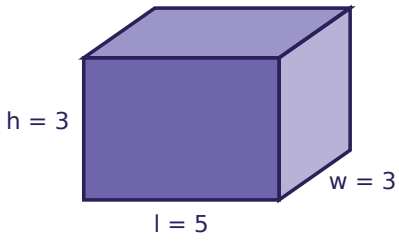

Task card 14 Volume & Surface Area (Mixed Revie...

Find the surface area of a rectangular prism with length 3, width 2, and height 6.

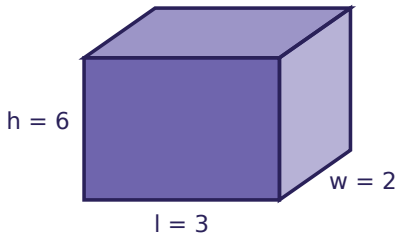

Task card 15 Volume & Surface Area (Mixed Revie...

Find the volume of a rectangular prism with length 2, width 3, and height 5.

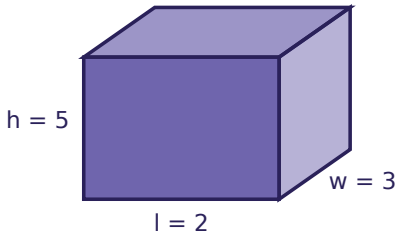

Task card 16 Volume & Surface Area (Mixed Revie...

Find the surface area of a rectangular prism with length 3, width 6, and height 4.

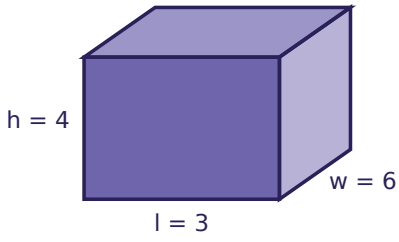

Task card 17 Volume & Surface Area (Mixed Revie...

Find the volume of a rectangular prism with length 5, width 6, and height 3.

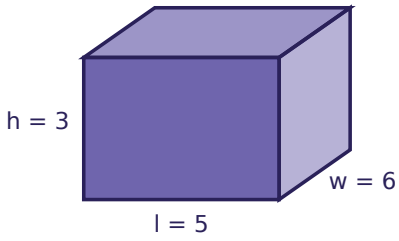

Task card 18 Volume & Surface Area (Mixed Revie...

Find the surface area of a rectangular prism with length 2, width 6, and height 3.

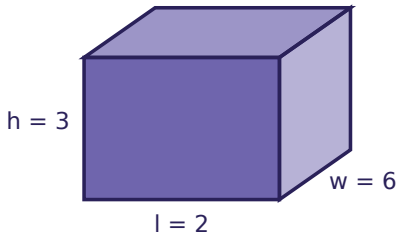

Task card 19 Volume & Surface Area (Mixed Revie...

Find the volume of a rectangular prism with length 5, width 5, and height 2.

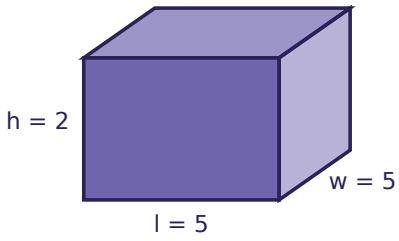

Task card 20 Volume & Surface Area (Mixed Revie...

Find the surface area of a rectangular prism with length 2, width 6, and height 6.

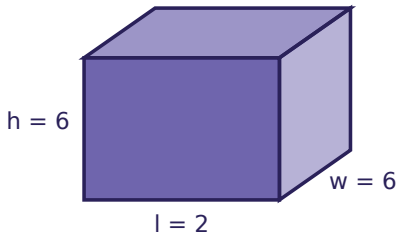

Task card 21 Volume & Surface Area (Mixed Revie...

Find the volume of a rectangular prism with length 4, width 5, and height 6.

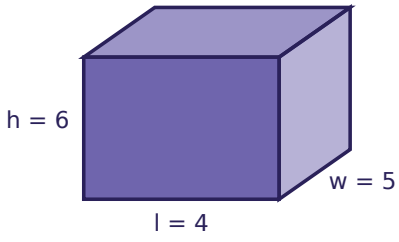

Task card 22 Volume & Surface Area (Mixed Revie...

Find the surface area of a rectangular prism with length 2, width 5, and height 7.

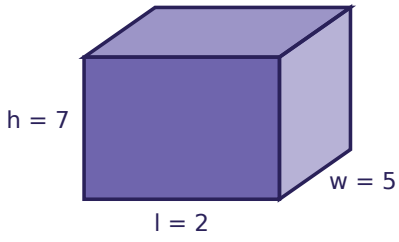

Task card 23 Volume & Surface Area (Mixed Revie...

Find the volume of a rectangular prism with length 7, width 2, and height 2.

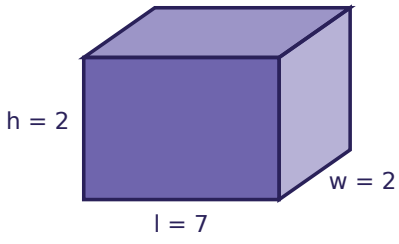

Task card 24 Volume & Surface Area (Mixed Revie...

Find the surface area of a rectangular prism with length 5, width 5, and height 4.

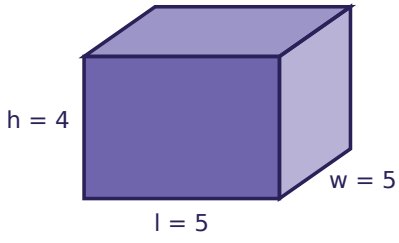

Volume & Surface Area (Mixed Review) Task Cards

Recording sheet · Grade 10 · Solve each problem.

Scan to check your answers

Name: _____ Date: _____

1	2	3	4
5	6	7	8
9	10	11	12
13	14	15	16
17	18	19	20
21	22	23	24

Volume & Surface Area (Mixed Review) Task Cards: Answer Key

Grade 10 · Easy

The answers online

1. 40	**2.** 66	**3.** 48
4. 48	**5.** 30	**6.** 130
7. 100	**8.** 64	**9.** 36
10. 170	**11.** 36	**12.** 56
13. 45	**14.** 72	**15.** 30
16. 108	**17.** 90	**18.** 72
19. 50	**20.** 120	**21.** 120
22. 118	**23.** 28	**24.** 130