Triangle Midsegment Theorem · 1

BC = 14. Find DE.

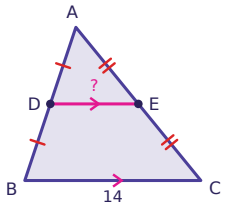

Triangle Midsegment Theorem · 2

DE = 12. Find BC.

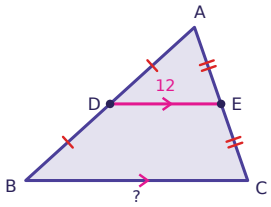

Triangle Midsegment Theorem · 3

BC = 22. Find DE.

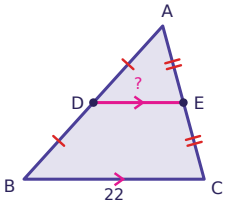

Triangle Midsegment Theorem · 4

AB = 26. Find DB.

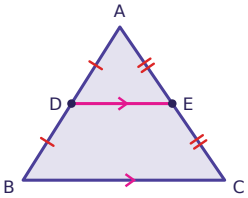

Triangle Midsegment Theorem · 5

DE = 6. Find BC.

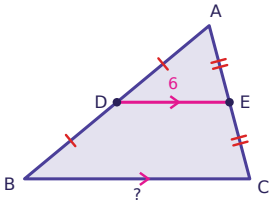

Triangle Midsegment Theorem · 6

BC = 8. Find DE.

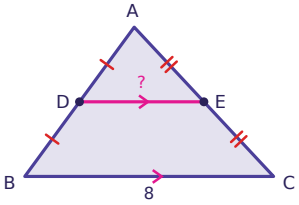

Triangle Midsegment Theorem · 7

AB = 28. Find DB.

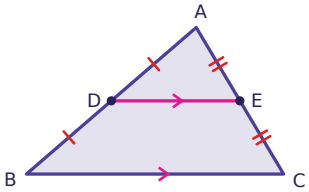

Triangle Midsegment Theorem · 8

DE = 6. Find BC.

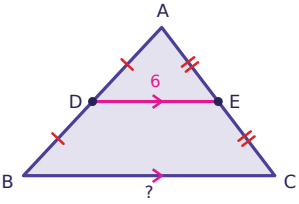

Triangle Midsegment Theorem · 2

ANSWER

24

Triangle Midsegment Theorem · 1

ANSWER

7

Triangle Midsegment Theorem · 4

ANSWER

13

Triangle Midsegment Theorem · 3

ANSWER

11

Triangle Midsegment Theorem · 6

ANSWER

4

Triangle Midsegment Theorem · 5

ANSWER

12

Triangle Midsegment Theorem · 8

ANSWER

12

Triangle Midsegment Theorem · 7

ANSWER

14

Triangle Midsegment Theorem · 9

BC = 20. Find DE.

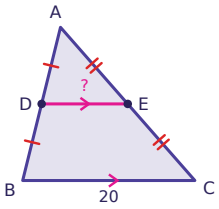

Triangle Midsegment Theorem · 10

DE = 3. Find BC.

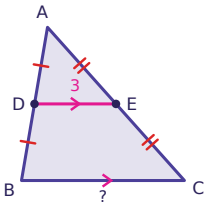

Triangle Midsegment Theorem · 11

BC = 12. Find DE.

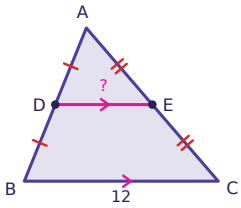

Triangle Midsegment Theorem · 12

AB = 18. Find DB.

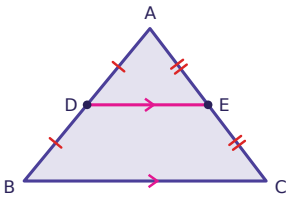

Triangle Midsegment Theorem · 13

DE = 7. Find BC.

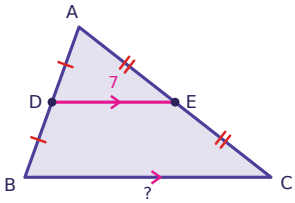

Triangle Midsegment Theorem · 14

BC = 20. Find DE.

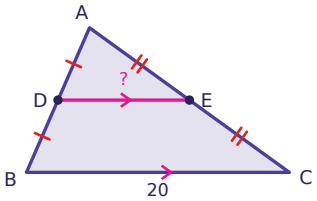

Triangle Midsegment Theorem · 15

AB = 14. Find DB.

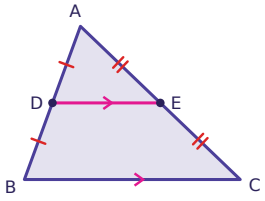

Triangle Midsegment Theorem · 16

DE = 7. Find BC.

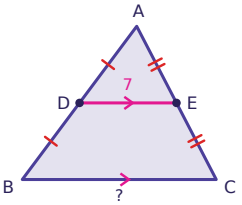

Triangle Midsegment Theorem · 10

ANSWER

6

Triangle Midsegment Theorem · 9

ANSWER

10

Triangle Midsegment Theorem · 12

ANSWER

9

Triangle Midsegment Theorem · 11

ANSWER

6

Triangle Midsegment Theorem · 14

ANSWER

10

Triangle Midsegment Theorem · 13

ANSWER

14

Triangle Midsegment Theorem · 16

ANSWER

14

Triangle Midsegment Theorem · 15

ANSWER

7

Triangle Midsegment Theorem · 17

DE = 5x - 14 and BC = 4x + 8. Find x.

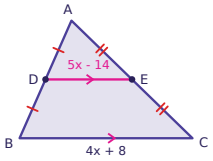

Triangle Midsegment Theorem · 18

AE = 5x + 4 and EC = x + 24. Find x.

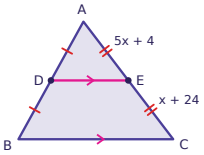

Triangle Midsegment Theorem · 19

DE = 3x + 8 and BC = 5x + 18. Find x.

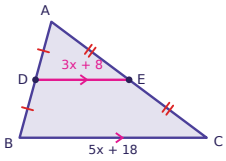

Triangle Midsegment Theorem · 20

DE = 4. Find BC.

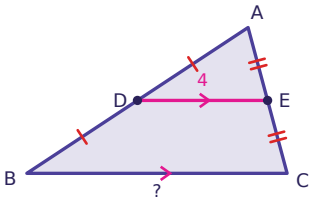

Triangle Midsegment Theorem · 21

DE = 2x + 3 and BC = 3x + 10. Find x.

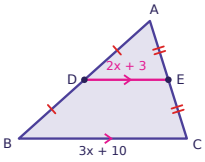

Triangle Midsegment Theorem · 22

AE = 5x + 11 and EC = 4x + 14. Find x.

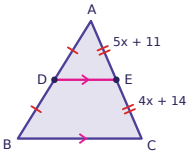

Triangle Midsegment Theorem · 23

BC = 20. Find DE.

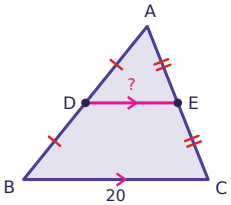

Triangle Midsegment Theorem · 24

DE = 4x + 3 and BC = 6x + 12. Find x.

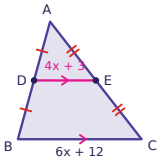

Triangle Midsegment Theorem · 18

ANSWER

5

Triangle Midsegment Theorem · 17

ANSWER

6

Triangle Midsegment Theorem · 20

ANSWER

8

Triangle Midsegment Theorem · 19

ANSWER

2

Triangle Midsegment Theorem · 22

ANSWER

3

Triangle Midsegment Theorem · 21

ANSWER

4

Triangle Midsegment Theorem · 24

ANSWER

3

Triangle Midsegment Theorem · 23

ANSWER

10