Pythagorean Theorem · 1

A right triangle has legs of length 8 and 15. Find the hypotenuse.

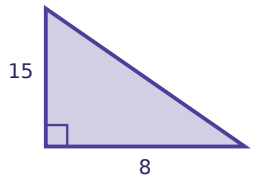

Pythagorean Theorem · 2

A right triangle has legs of length 5 and 12. Find the hypotenuse.

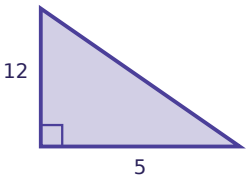

Pythagorean Theorem · 3

A right triangle has legs of length 9 and 12. Find the hypotenuse.

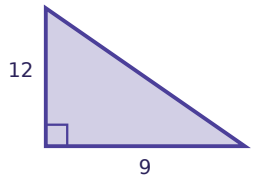

Pythagorean Theorem · 4

A right triangle has legs of length 7 and 24. Find the hypotenuse.

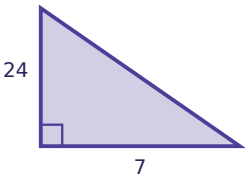

Pythagorean Theorem · 5

A right triangle has legs of length 10 and 24. Find the hypotenuse.

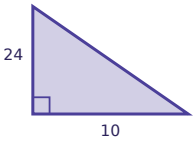

Pythagorean Theorem · 6

A right triangle has legs of length 6 and 8. Find the hypotenuse.

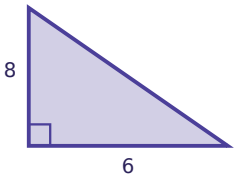

Pythagorean Theorem · 7

A right triangle has legs of length 12 and 16. Find the hypotenuse.

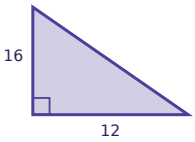

Pythagorean Theorem · 8

A right triangle has legs of length 9 and 40. Find the hypotenuse.

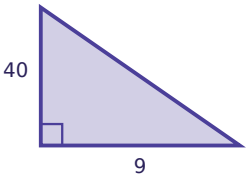

Pythagorean Theorem · 2

ANSWER

13

Pythagorean Theorem · 1

ANSWER

17

Pythagorean Theorem · 4

ANSWER

25

Pythagorean Theorem · 3

ANSWER

15

Pythagorean Theorem · 6

ANSWER

10

Pythagorean Theorem · 5

ANSWER

26

Pythagorean Theorem · 8

ANSWER

41

Pythagorean Theorem · 7

ANSWER

20

Pythagorean Theorem · 9

A right triangle has legs of length 20 and 21. Find the hypotenuse.

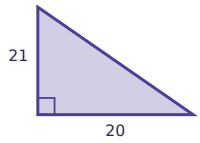

Pythagorean Theorem · 10

A right triangle has legs of length 3 and 4. Find the hypotenuse.

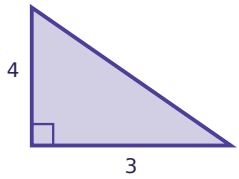

Pythagorean Theorem · 10

ANSWER

5

Pythagorean Theorem · 9

ANSWER

29