Geometric Mean in Right Triangles · 1

Find x.

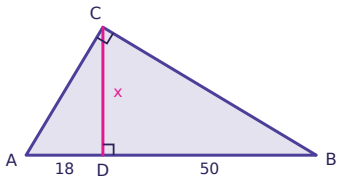

Geometric Mean in Right Triangles · 2

Find x.

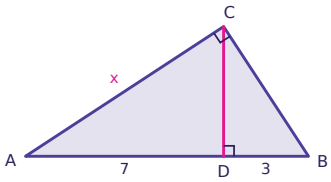

Geometric Mean in Right Triangles · 3

Find x.

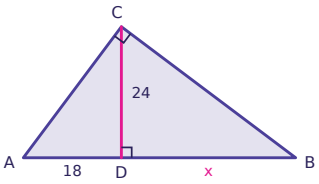

Geometric Mean in Right Triangles · 4

Find the geometric mean of 2 and 15.

Geometric Mean in Right Triangles · 5

Find x.

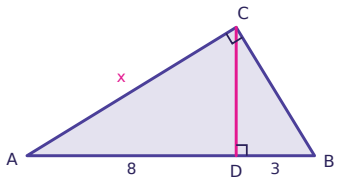

Geometric Mean in Right Triangles · 6

Find x.

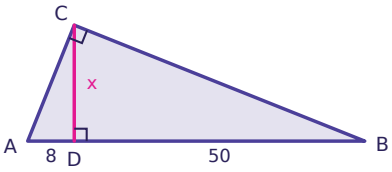

Geometric Mean in Right Triangles · 7

Find x.

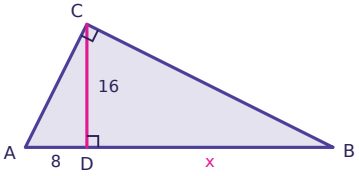

Geometric Mean in Right Triangles · 8

Find x.

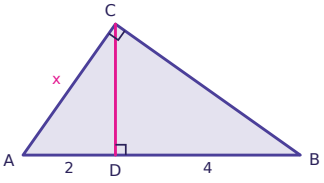

Geometric Mean in Right Triangles · 2

ANSWER

$\sqrt{70}$

Geometric Mean in Right Triangles · 1

ANSWER

30

Geometric Mean in Right Triangles · 4

ANSWER

$\sqrt{30}$

Geometric Mean in Right Triangles · 3

ANSWER

32

Geometric Mean in Right Triangles · 6

ANSWER

20

Geometric Mean in Right Triangles · 5

ANSWER

$2\sqrt{22}$

Geometric Mean in Right Triangles · 8

ANSWER

$2\sqrt{3}$

Geometric Mean in Right Triangles · 7

ANSWER

32

Geometric Mean in Right Triangles · 9

Find x.

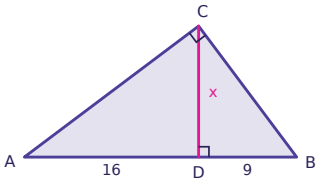

Geometric Mean in Right Triangles · 10

Find x.

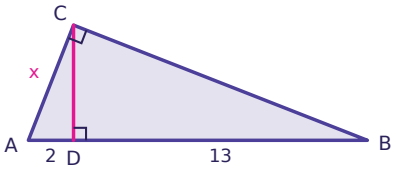

Geometric Mean in Right Triangles · 11

Find x.

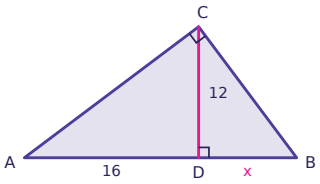

Geometric Mean in Right Triangles · 12

Find the geometric mean of 6 and 11.

Geometric Mean in Right Triangles · 13

Find x.

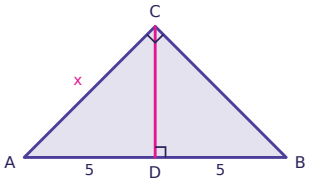

Geometric Mean in Right Triangles · 14

Find x.

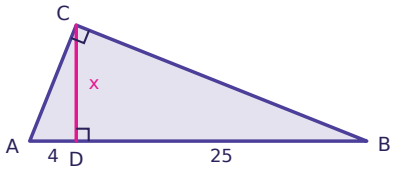

Geometric Mean in Right Triangles · 15

Find x.

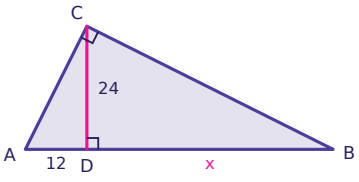

Geometric Mean in Right Triangles · 16

Find x.

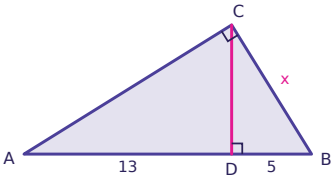

Geometric Mean in Right Triangles · 10

ANSWER

$\sqrt{30}$

Geometric Mean in Right Triangles · 9

ANSWER

12

Geometric Mean in Right Triangles · 12

ANSWER

$\sqrt{66}$

Geometric Mean in Right Triangles · 11

ANSWER

9

Geometric Mean in Right Triangles · 14

ANSWER

10

Geometric Mean in Right Triangles · 13

ANSWER

$5\sqrt{2}$

Geometric Mean in Right Triangles · 16

ANSWER

$3\sqrt{10}$

Geometric Mean in Right Triangles · 15

ANSWER

48

Geometric Mean in Right Triangles · 17

Find x.

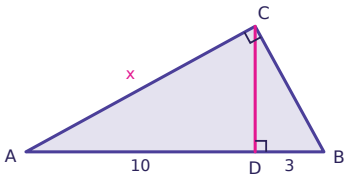

Geometric Mean in Right Triangles · 18

Find x.

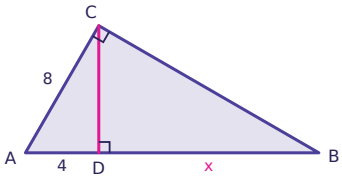

Geometric Mean in Right Triangles · 19

Find x.

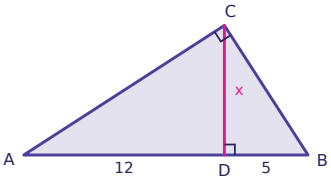

Geometric Mean in Right Triangles · 20

Find x.

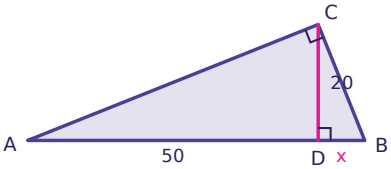

Geometric Mean in Right Triangles · 21

Find x.

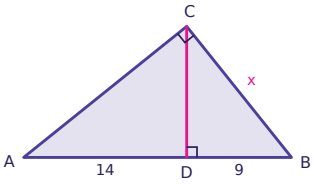

Geometric Mean in Right Triangles · 22

Find the geometric mean of 12 and 8.

Geometric Mean in Right Triangles · 23

Find x.

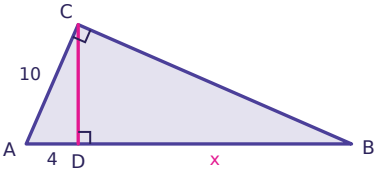

Geometric Mean in Right Triangles · 24

Find x.

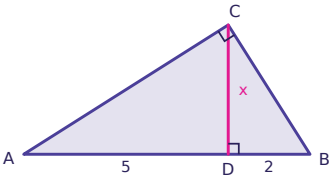

Geometric Mean in Right Triangles · 18

ANSWER

12

Geometric Mean in Right Triangles · 17

ANSWER

√130

Geometric Mean in Right Triangles · 20

ANSWER

8

Geometric Mean in Right Triangles · 19

ANSWER

2√15

Geometric Mean in Right Triangles · 22

ANSWER

4√6

Geometric Mean in Right Triangles · 21

ANSWER

3√23

Geometric Mean in Right Triangles · 24

ANSWER

√10

Geometric Mean in Right Triangles · 23

ANSWER

21