Task card 1 Dot Plots: Standard Deviation

The dot plot shows the quiz score for 9 students. Each dot stands for one student. What is the population standard deviation of the data?

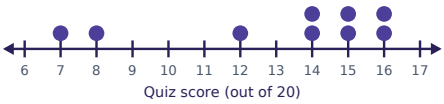

Task card 2 Dot Plots: Standard Deviation

The dot plot shows the number of books read over the summer for 8 students. Each dot stands for one student. What is the population standard deviation of the data?



Task card 3 Dot Plots: Standard Deviation

The dot plot shows the number of rainy days for 9 months. Each dot stands for one month. What is the population standard deviation of the data?

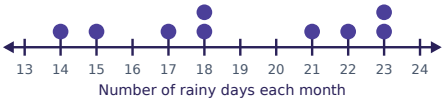

Task card 4 Dot Plots: Standard Deviation

The dot plot shows the number of minutes the bus was late for 9 days. Each dot stands for one day. What is the population standard deviation of the data?

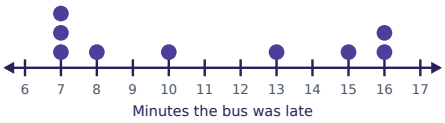

Task card 5 Dot Plots: Standard Deviation

The dot plot shows the number of text messages sent in one hour for 8 teens. Each dot stands for one teen. What is the population standard deviation of the data?

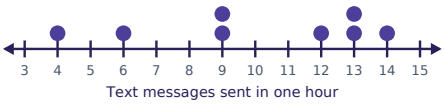

Task card 6 Dot Plots: Standard Deviation

The dot plot shows the number of points scored for 8 games. Each dot stands for one game. What is the population standard deviation of the data?

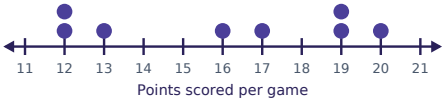

Task card 7 Dot Plots: Standard Deviation

The dot plot shows the number of rainy days for 9 months. Each dot stands for one month. What is the population standard deviation of the data?

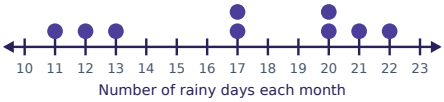

Task card 8 Dot Plots: Standard Deviation

The dot plot shows the number of goals scored for 9 matches. Each dot stands for one match. What is the population standard deviation of the data?



Task card 9 Dot Plots: Standard Deviation

The dot plot shows the number of text messages sent in one hour for 9 teens. Each dot stands for one teen. What is the population standard deviation of the data?



Task card 10 Dot Plots: Standard Deviation

The dot plot shows the number of minutes the bus was late for 8 days. Each dot stands for one day. What is the population standard deviation of the data?

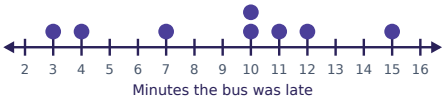

Task card 11 Dot Plots: Standard Deviation

The dot plot shows the quiz score for 8 students. Each dot stands for one student. What is the population standard deviation of the data?

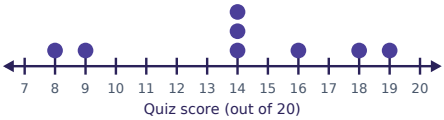

Task card 12 Dot Plots: Standard Deviation

The dot plot shows the high temperature in °C for 9 days. Each dot stands for one day. What is the population standard deviation of the data?

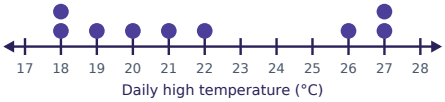

Task card 13 Dot Plots: Standard Deviation

The dot plot shows the number of minutes the bus was late for 8 days. Each dot stands for one day. What is the population standard deviation of the data?

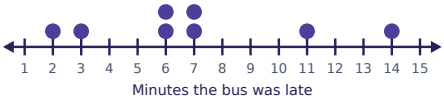

Task card 14 Dot Plots: Standard Deviation

The dot plot shows the high temperature in °C for 9 days. Each dot stands for one day. What is the population standard deviation of the data?

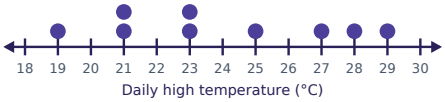

Task card 15 Dot Plots: Standard Deviation

The dot plot shows the number of books read over the summer for 9 students. Each dot stands for one student. What is the population standard deviation of the data?



Task card 16 Dot Plots: Standard Deviation

The dot plot shows the quiz score for 9 students. Each dot stands for one student. What is the population standard deviation of the data?



Task card 17 Dot Plots: Standard Deviation

The dot plot shows the number of rainy days for 9 months. Each dot stands for one month. What is the population standard deviation of the data?

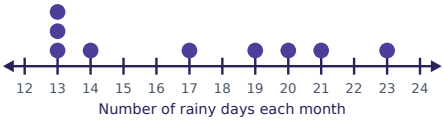

Task card 18 Dot Plots: Standard Deviation

The dot plot shows the high temperature in °C for 9 days. Each dot stands for one day. What is the population standard deviation of the data?

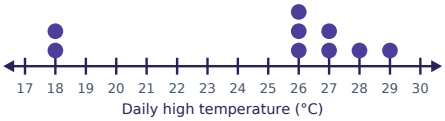

Task card 19 Dot Plots: Standard Deviation

The dot plot shows the number of points scored for 9 games. Each dot stands for one game. What is the population standard deviation of the data?



Task card 20 Dot Plots: Standard Deviation

The dot plot shows the high temperature in °C for 8 days. Each dot stands for one day. What is the population standard deviation of the data?

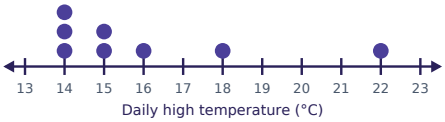

Task card 21 Dot Plots: Standard Deviation

The dot plot shows the number of text messages sent in one hour for 9 teens. Each dot stands for one teen. What is the population standard deviation of the data?



Task card 22 Dot Plots: Standard Deviation

The dot plot shows the number of rainy days for 8 months. Each dot stands for one month. What is the population standard deviation of the data?



Task card 23 Dot Plots: Standard Deviation

The dot plot shows the number of text messages sent in one hour for 9 teens. Each dot stands for one teen. What is the population standard deviation of the data?



Task card 24 Dot Plots: Standard Deviation

The dot plot shows the number of minutes the bus was late for 8 days. Each dot stands for one day. What is the population standard deviation of the data?

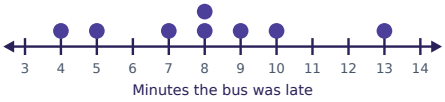

Dot Plots: Standard Deviation Task Cards

Recording sheet · Grade 10 · Find the population standard deviation: divide the sum of the squared differences from the mean by n, the number of values, then take the square root. Round to the nearest tenth.

Scan to check your answers

Name: _____ Date: _____

1	2	3	4
5	6	7	8
9	10	11	12
13	14	15	16
17	18	19	20
21	22	23	24

Dot Plots: Standard Deviation Task Cards: Answer Key

Grade 10 · Hard

The answers online

1. 3.2	**2.** 2.1	**3.** 3.2
4. 3.8	**5.** 3.4	**6.** 3.1
7. 3.9	**8.** 2.7	**9.** 3.3
10. 3.8	**11.** 3.6	**12.** 3.5
13. 3.7	**14.** 3.3	**15.** 2.1
16. 4.0	**17.** 3.7	**18.** 3.9
19. 4.0	**20.** 2.6	**21.** 3.2
22. 3.3	**23.** 2.4	**24.** 2.6