Dot Plots: Standard Deviation · 1

The dot plot shows the quiz score for 9 students. Each dot stands for one student. What is the population standard deviation of the data?

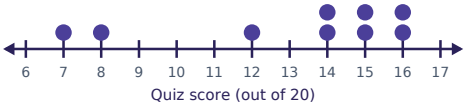

Dot Plots: Standard Deviation · 2

The dot plot shows the number of books read over the summer for 8 students. Each dot stands for one student. What is the population standard deviation of the data?

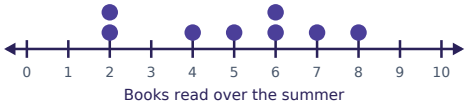

Dot Plots: Standard Deviation · 3

The dot plot shows the number of rainy days for 9 months. Each dot stands for one month. What is the population standard deviation of the data?

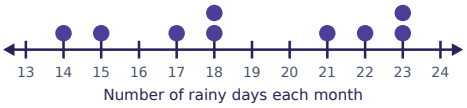

Dot Plots: Standard Deviation · 4

The dot plot shows the number of minutes the bus was late for 9 days. Each dot stands for one day. What is the population standard deviation of the data?

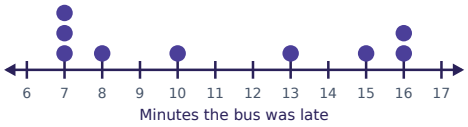

Dot Plots: Standard Deviation · 5

The dot plot shows the number of text messages sent in one hour for 8 teens. Each dot stands for one teen. What is the population standard deviation of the data?

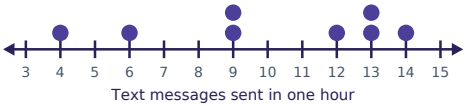

Dot Plots: Standard Deviation · 6

The dot plot shows the number of points scored for 8 games. Each dot stands for one game. What is the population standard deviation of the data?



Dot Plots: Standard Deviation · 7

The dot plot shows the number of rainy days for 9 months. Each dot stands for one month. What is the population standard deviation of the data?



Dot Plots: Standard Deviation · 8

The dot plot shows the number of goals scored for 9 matches. Each dot stands for one match. What is the population standard deviation of the data?



Dot Plots: Standard Deviation · 2

ANSWER

2.1

Dot Plots: Standard Deviation · 1

ANSWER

3.2

Dot Plots: Standard Deviation · 4

ANSWER

3.8

Dot Plots: Standard Deviation · 3

ANSWER

3.2

Dot Plots: Standard Deviation · 6

ANSWER

3.1

Dot Plots: Standard Deviation · 5

ANSWER

3.4

Dot Plots: Standard Deviation · 8

ANSWER

2.7

Dot Plots: Standard Deviation · 7

ANSWER

3.9

Dot Plots: Standard Deviation · 9

The dot plot shows the number of text messages sent in one hour for 9 teens. Each dot stands for one teen. What is the population standard deviation of the data?



Dot Plots: Standard Deviation · 10

The dot plot shows the number of minutes the bus was late for 8 days. Each dot stands for one day. What is the population standard deviation of the data?

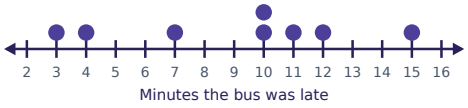

Dot Plots: Standard Deviation · 11

The dot plot shows the quiz score for 8 students. Each dot stands for one student. What is the population standard deviation of the data?

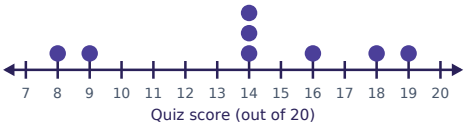

Dot Plots: Standard Deviation · 12

The dot plot shows the high temperature in °C for 9 days. Each dot stands for one day. What is the population standard deviation of the data?

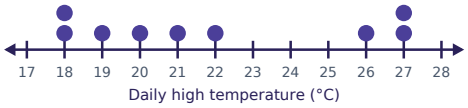

Dot Plots: Standard Deviation · 13

The dot plot shows the number of minutes the bus was late for 8 days. Each dot stands for one day. What is the population standard deviation of the data?

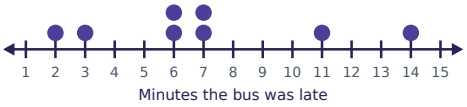

Dot Plots: Standard Deviation · 14

The dot plot shows the high temperature in °C for 9 days. Each dot stands for one day. What is the population standard deviation of the data?

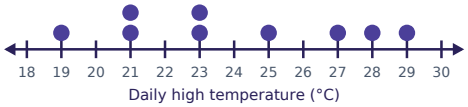

Dot Plots: Standard Deviation · 15

The dot plot shows the number of books read over the summer for 9 students. Each dot stands for one student. What is the population standard deviation of the data?

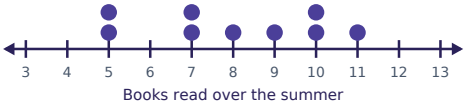

Dot Plots: Standard Deviation · 16

The dot plot shows the quiz score for 9 students. Each dot stands for one student. What is the population standard deviation of the data?

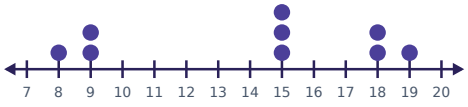

Dot Plots: Standard Deviation · 10

ANSWER

3.8

Dot Plots: Standard Deviation · 9

ANSWER

3.3

Dot Plots: Standard Deviation · 12

ANSWER

3.5

Dot Plots: Standard Deviation · 11

ANSWER

3.6

Dot Plots: Standard Deviation · 14

ANSWER

3.3

Dot Plots: Standard Deviation · 13

ANSWER

3.7

Dot Plots: Standard Deviation · 16

ANSWER

4.0

Dot Plots: Standard Deviation · 15

ANSWER

2.1

Dot Plots: Standard Deviation · 17

The dot plot shows the number of rainy days for 9 months. Each dot stands for one month. What is the population standard deviation of the data?

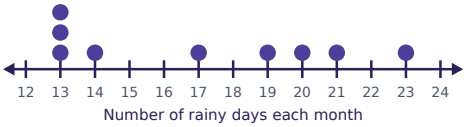

Dot Plots: Standard Deviation · 18

The dot plot shows the high temperature in °C for 9 days. Each dot stands for one day. What is the population standard deviation of the data?

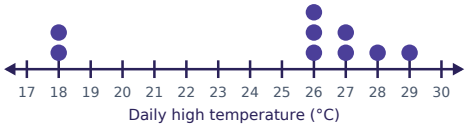

Dot Plots: Standard Deviation · 19

The dot plot shows the number of points scored for 9 games. Each dot stands for one game. What is the population standard deviation of the data?



Dot Plots: Standard Deviation · 20

The dot plot shows the high temperature in °C for 8 days. Each dot stands for one day. What is the population standard deviation of the data?

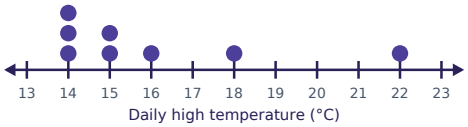

Dot Plots: Standard Deviation · 21

The dot plot shows the number of text messages sent in one hour for 9 teens. Each dot stands for one teen. What is the population standard deviation of the data?



Dot Plots: Standard Deviation · 22

The dot plot shows the number of rainy days for 8 months. Each dot stands for one month. What is the population standard deviation of the data?

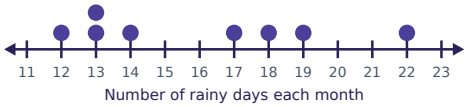

Dot Plots: Standard Deviation · 23

The dot plot shows the number of text messages sent in one hour for 9 teens. Each dot stands for one teen. What is the population standard deviation of the data?

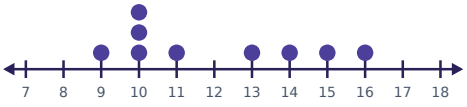

Dot Plots: Standard Deviation · 24

The dot plot shows the number of minutes the bus was late for 8 days. Each dot stands for one day. What is the population standard deviation of the data?

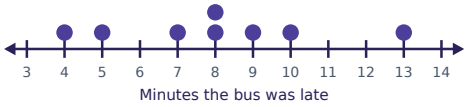

Dot Plots: Standard Deviation · 18

ANSWER

3.9

Dot Plots: Standard Deviation · 17

ANSWER

3.7

Dot Plots: Standard Deviation · 20

ANSWER

2.6

Dot Plots: Standard Deviation · 19

ANSWER

4.0

Dot Plots: Standard Deviation · 22

ANSWER

3.3

Dot Plots: Standard Deviation · 21

ANSWER

3.2

Dot Plots: Standard Deviation · 24

ANSWER

2.6

Dot Plots: Standard Deviation · 23

ANSWER

2.4