Dot Plots: Quartiles and Interquartile Range · 1

The dot plot shows the high temperature in °C for 15 days. Each dot stands for one day. What is the interquartile range (IQR) of the data?

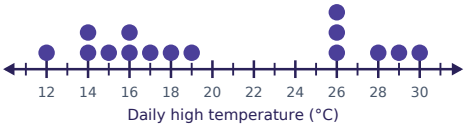

Dot Plots: Quartiles and Interquartile Range · 2

The dot plot shows the number of push-ups done in one minute for 16 students. Each dot stands for one student. What is the third quartile (Q3) of the data?

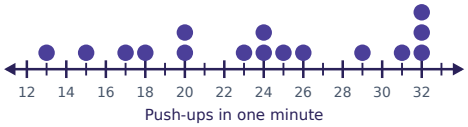

Dot Plots: Quartiles and Interquartile Range · 3

The dot plot shows the number of rainy days for 15 months. Each dot stands for one month. What is the interquartile range (IQR) of the data?

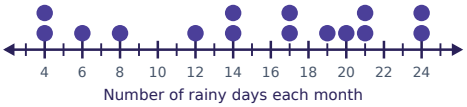

Dot Plots: Quartiles and Interquartile Range · 4

The dot plot shows the number of books read over the summer for 16 students. Each dot stands for one student. What is the first quartile (Q1) of the data?

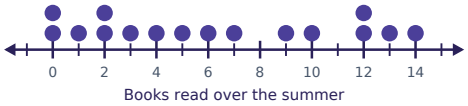

Dot Plots: Quartiles and Interquartile Range · 5

The dot plot shows the quiz score for 15 students. Each dot stands for one student. What is the interquartile range (IQR) of the data?

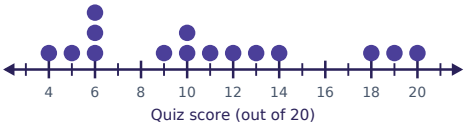

Dot Plots: Quartiles and Interquartile Range · 6

The dot plot shows the number of points scored for 16 games. Each dot stands for one game. What is the third quartile (Q3) of the data?

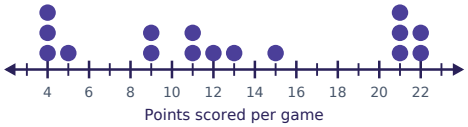

Dot Plots: Quartiles and Interquartile Range · 7

The dot plot shows the number of goals scored for 15 matches. Each dot stands for one match. What is the interquartile range (IQR) of the data?



Dot Plots: Quartiles and Interquartile Range · 8

The dot plot shows the quiz score for 16 students. Each dot stands for one student. What is the first quartile (Q1) of the data?

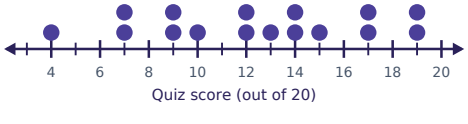

Dot Plots: Quartiles and Interquartile Range · 2

ANSWER

30

Dot Plots: Quartiles and Interquartile Range · 1

ANSWER

11

Dot Plots: Quartiles and Interquartile Range · 4

ANSWER

2

Dot Plots: Quartiles and Interquartile Range · 3

ANSWER

13

Dot Plots: Quartiles and Interquartile Range · 6

ANSWER

21

Dot Plots: Quartiles and Interquartile Range · 5

ANSWER

8

Dot Plots: Quartiles and Interquartile Range · 8

ANSWER

9

Dot Plots: Quartiles and Interquartile Range · 7

ANSWER

4

Dot Plots: Quartiles and Interquartile Range · 9

The dot plot shows the number of books read over the summer for 16 students. Each dot stands for one student. What is the interquartile range (IQR) of the data?

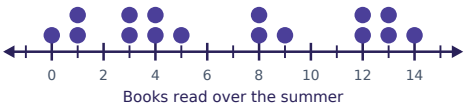

Dot Plots: Quartiles and Interquartile Range · 10

The dot plot shows the number of hours of sleep for 17 students. Each dot stands for one student. What is the third quartile (Q3) of the data?



Dot Plots: Quartiles and Interquartile Range · 11

The dot plot shows the number of push-ups done in one minute for 16 students. Each dot stands for one student. What is the interquartile range (IQR) of the data?

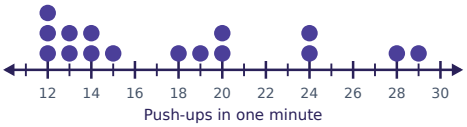

Dot Plots: Quartiles and Interquartile Range · 12

The dot plot shows the number of goals scored for 17 matches. Each dot stands for one match. What is the first quartile (Q1) of the data?

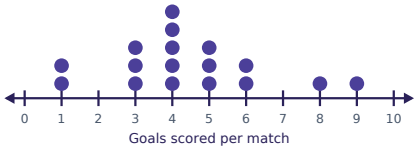

Dot Plots: Quartiles and Interquartile Range · 13

The dot plot shows the high temperature in °C for 16 days. Each dot stands for one day. What is the interquartile range (IQR) of the data?

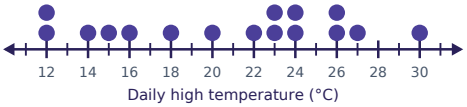

Dot Plots: Quartiles and Interquartile Range · 14

The dot plot shows the number of push-ups done in one minute for 17 students. Each dot stands for one student. What is the third quartile (Q3) of the data?

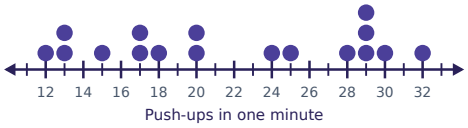

Dot Plots: Quartiles and Interquartile Range · 15

The dot plot shows the number of books read over the summer for 16 students. Each dot stands for one student. What is the interquartile range (IQR) of the data?

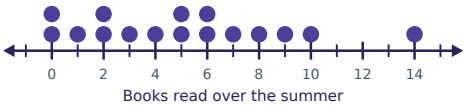

Dot Plots: Quartiles and Interquartile Range · 16

The dot plot shows the number of hours of sleep for 17 students. Each dot stands for one student. What is the first quartile (Q1) of the data?



Dot Plots: Quartiles and Interquartile Range · 10

ANSWER

11

Dot Plots: Quartiles and Interquartile Range · 9

ANSWER

9

Dot Plots: Quartiles and Interquartile Range · 12

ANSWER

3

Dot Plots: Quartiles and Interquartile Range · 11

ANSWER

9

Dot Plots: Quartiles and Interquartile Range · 14

ANSWER

29

Dot Plots: Quartiles and Interquartile Range · 13

ANSWER

9.5

Dot Plots: Quartiles and Interquartile Range · 16

ANSWER

5.5

Dot Plots: Quartiles and Interquartile Range · 15

ANSWER

5.5

Dot Plots: Quartiles and Interquartile Range · 17

The dot plot shows the high temperature in °C for 15 days. Each dot stands for one day. What is the interquartile range (IQR) of the data?

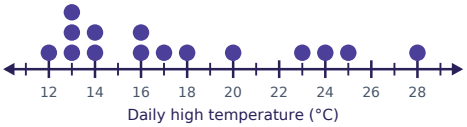

Dot Plots: Quartiles and Interquartile Range · 18

The dot plot shows the number of hours of sleep for 16 students. Each dot stands for one student. What is the third quartile (Q3) of the data?

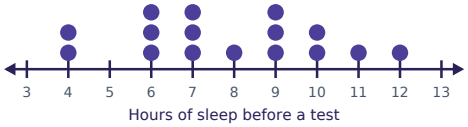

Dot Plots: Quartiles and Interquartile Range · 19

The dot plot shows the number of goals scored for 15 matches. Each dot stands for one match. What is the interquartile range (IQR) of the data?



Dot Plots: Quartiles and Interquartile Range · 20

The dot plot shows the number of rainy days for 16 months. Each dot stands for one month. What is the first quartile (Q1) of the data?

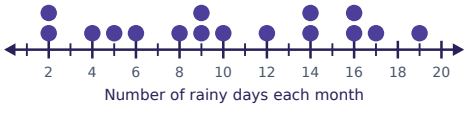

Dot Plots: Quartiles and Interquartile Range · 21

The dot plot shows the number of rainy days for 15 months. Each dot stands for one month. What is the interquartile range (IQR) of the data?



Dot Plots: Quartiles and Interquartile Range · 22

The dot plot shows the number of minutes the bus was late for 16 days. Each dot stands for one day. What is the third quartile (Q3) of the data?

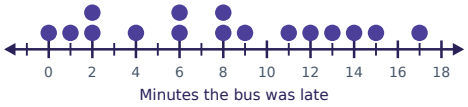

Dot Plots: Quartiles and Interquartile Range · 23

The dot plot shows the quiz score for 15 students. Each dot stands for one student. What is the interquartile range (IQR) of the data?

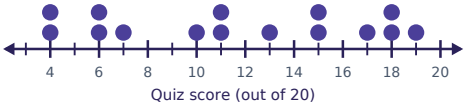

Dot Plots: Quartiles and Interquartile Range · 24

The dot plot shows the number of push-ups done in one minute for 16 students. Each dot stands for one student. What is the first quartile (Q1) of the data?

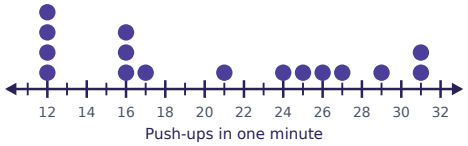

Dot Plots: Quartiles and Interquartile Range · 18

ANSWER

9.5

Dot Plots: Quartiles and Interquartile Range · 17

ANSWER

10

Dot Plots: Quartiles and Interquartile Range · 20

ANSWER

5.5

Dot Plots: Quartiles and Interquartile Range · 19

ANSWER

6

Dot Plots: Quartiles and Interquartile Range · 22

ANSWER

12.5

Dot Plots: Quartiles and Interquartile Range · 21

ANSWER

15

Dot Plots: Quartiles and Interquartile Range · 24

ANSWER

14

Dot Plots: Quartiles and Interquartile Range · 23

ANSWER

11