Dot Plots: Finding the Median · 1

The dot plot shows the number of points scored for 13 games. Each dot stands for one game. What is the median number of points scored?

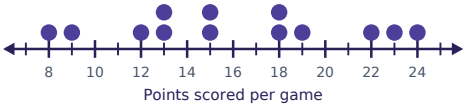

Dot Plots: Finding the Median · 2

The dot plot shows the number of points scored for 14 games. Each dot stands for one game. What is the median number of points scored?

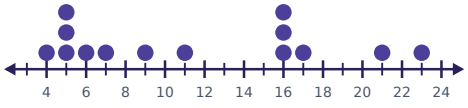

Dot Plots: Finding the Median · 3

The dot plot shows the number of books read over the summer for 13 students. Each dot stands for one student. What is the median number of books read over the summer?



Dot Plots: Finding the Median · 4

The dot plot shows the number of push-ups done in one minute for 14 students. Each dot stands for one student. What is the median number of push-ups done in one minute?

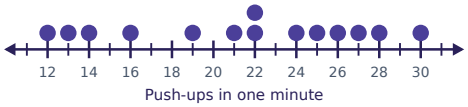

Dot Plots: Finding the Median · 5

The dot plot shows the number of books read over the summer for 13 students. Each dot stands for one student. What is the median number of books read over the summer?

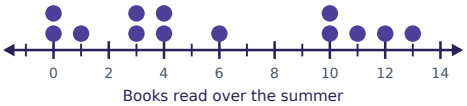

Dot Plots: Finding the Median · 6

The dot plot shows the number of rainy days for 14 months. Each dot stands for one month. What is the median number of rainy days?

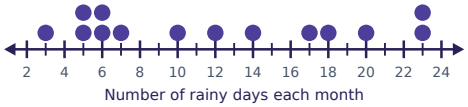

Dot Plots: Finding the Median · 7

The dot plot shows the number of text messages sent in one hour for 13 teens. Each dot stands for one teen. What is the median number of text messages sent in one hour?



Dot Plots: Finding the Median · 8

The dot plot shows the number of push-ups done in one minute for 14 students. Each dot stands for one student. What is the median number of push-ups done in one minute?

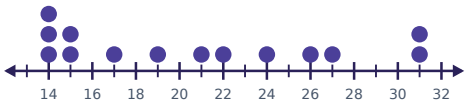

Dot Plots: Finding the Median · 2

ANSWER

10

Dot Plots: Finding the Median · 1

ANSWER

15

Dot Plots: Finding the Median · 4

ANSWER

22

Dot Plots: Finding the Median · 3

ANSWER

7

Dot Plots: Finding the Median · 6

ANSWER

11

Dot Plots: Finding the Median · 5

ANSWER

4

Dot Plots: Finding the Median · 8

ANSWER

20

Dot Plots: Finding the Median · 7

ANSWER

6

Dot Plots: Finding the Median · 9

The dot plot shows the number of push-ups done in one minute for 15 students. Each dot stands for one student. What is the median number of push-ups done in one minute?

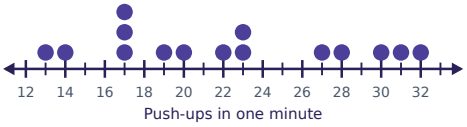

Dot Plots: Finding the Median · 10

The dot plot shows the number of text messages sent in one hour for 16 teens. Each dot stands for one teen. What is the median number of text messages sent in one hour?



Dot Plots: Finding the Median · 11

The dot plot shows the number of minutes the bus was late for 15 days. Each dot stands for one day. What is the median number of minutes the bus was late?

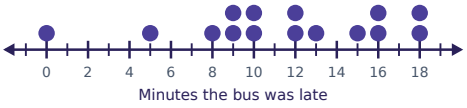

Dot Plots: Finding the Median · 12

The dot plot shows the number of rainy days for 16 months. Each dot stands for one month. What is the median number of rainy days?

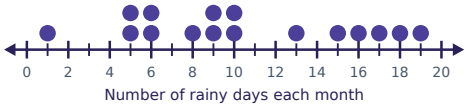

Dot Plots: Finding the Median · 13

The dot plot shows the number of text messages sent in one hour for 15 teens. Each dot stands for one teen. What is the median number of text messages sent in one hour?

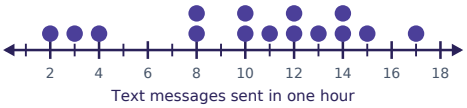

Dot Plots: Finding the Median · 14

The dot plot shows the number of minutes the bus was late for 16 days. Each dot stands for one day. What is the median number of minutes the bus was late?

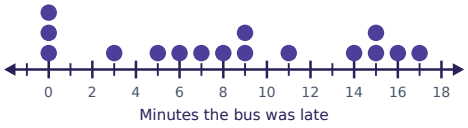

Dot Plots: Finding the Median · 15

The dot plot shows the quiz score for 15 students. Each dot stands for one student. What is the median quiz score?



Dot Plots: Finding the Median · 16

The dot plot shows the high temperature in °C for 16 days. Each dot stands for one day. What is the median high temperature in °C?

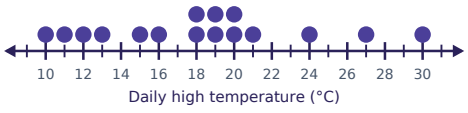

Dot Plots: Finding the Median · 10

ANSWER

4.5

Dot Plots: Finding the Median · 9

ANSWER

22

Dot Plots: Finding the Median · 12

ANSWER

9.5

Dot Plots: Finding the Median · 11

ANSWER

12

Dot Plots: Finding the Median · 14

ANSWER

8.5

Dot Plots: Finding the Median · 13

ANSWER

11

Dot Plots: Finding the Median · 16

ANSWER

18.5

Dot Plots: Finding the Median · 15

ANSWER

12

Dot Plots: Finding the Median · 17

The dot plot shows the quiz score for 13 students. Each dot stands for one student. What is the median quiz score?

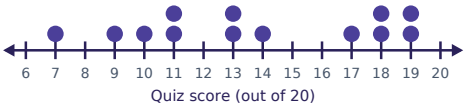

Dot Plots: Finding the Median · 18

The dot plot shows the number of rainy days for 14 months. Each dot stands for one month. What is the median number of rainy days?

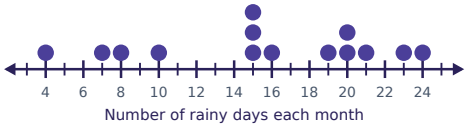

Dot Plots: Finding the Median · 19

The dot plot shows the number of text messages sent in one hour for 13 teens. Each dot stands for one teen. What is the median number of text messages sent in one hour?

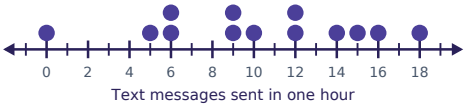

Dot Plots: Finding the Median · 20

The dot plot shows the number of push-ups done in one minute for 14 students. Each dot stands for one student. What is the median number of push-ups done in one minute?

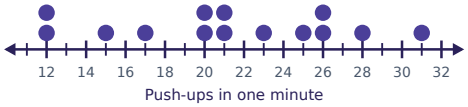

Dot Plots: Finding the Median · 21

The dot plot shows the high temperature in °C for 13 days. Each dot stands for one day. What is the median high temperature in °C?

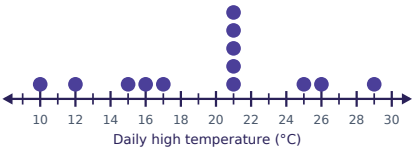

Dot Plots: Finding the Median · 22

The dot plot shows the number of hours of sleep for 14 students. Each dot stands for one student. What is the median number of hours of sleep?



Dot Plots: Finding the Median · 23

The dot plot shows the number of hours of sleep for 13 students. Each dot stands for one student. What is the median number of hours of sleep?



Dot Plots: Finding the Median · 24

The dot plot shows the high temperature in °C for 14 days. Each dot stands for one day. What is the median high temperature in °C?

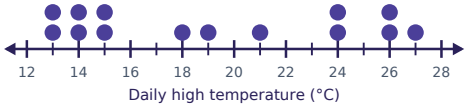

Dot Plots: Finding the Median · 18

ANSWER

15.5

Dot Plots: Finding the Median · 17

ANSWER

13

Dot Plots: Finding the Median · 20

ANSWER

21

Dot Plots: Finding the Median · 19

ANSWER

10

Dot Plots: Finding the Median · 22

ANSWER

7.5

Dot Plots: Finding the Median · 21

ANSWER

21

Dot Plots: Finding the Median · 24

ANSWER

18.5

Dot Plots: Finding the Median · 23

ANSWER

6