Dot Plots: Finding the Mean · 1

The dot plot shows the number of points scored for 10 games. Each dot stands for one game. The same data as a list: S = [7, 14, 10, 19, 11, 20, 7, 11, 21, 17]. What is the mean number of points scored?

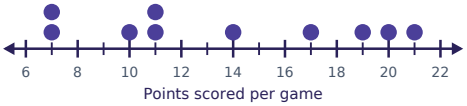

Dot Plots: Finding the Mean · 2

The dot plot shows the number of push-ups done in one minute for 11 students. Each dot stands for one student. The same data as a list: S = [30, 18, 28, 15, 18, 17, 24, 21, 29, 30, 20]. What is the mean number of push-ups done in one minute?

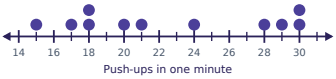

Dot Plots: Finding the Mean · 3

The dot plot shows the high temperature in °C for 10 days. Each dot stands for one day. The same data as a list: S = [19, 10, 14, 15, 18, 20, 12, 12, 15, 24]. What is the mean high temperature in °C?

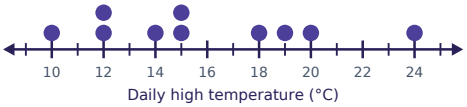

Dot Plots: Finding the Mean · 4

The dot plot shows the number of minutes the bus was late for 11 days. Each dot stands for one day. The same data as a list: S = [2, 2, 3, 5, 14, 9, 12, 1, 12, 4, 13]. What is the mean number of minutes the bus was late?



Dot Plots: Finding the Mean · 5

The dot plot shows the high temperature in °C for 10 days. Each dot stands for one day. The same data as a list: S = [19, 26, 27, 17, 20, 22, 23, 18, 17, 15]. What is the mean high temperature in °C?

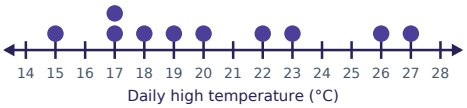

Dot Plots: Finding the Mean · 6

The dot plot shows the quiz score for 10 students. Each dot stands for one student. The same data as a list: S = [5, 17, 10, 14, 13, 19, 4, 19, 15, 7]. What is the mean quiz score?

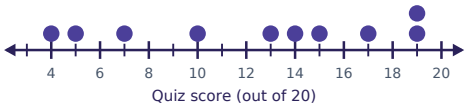

Dot Plots: Finding the Mean · 7

The dot plot shows the number of text messages sent in one hour for 10 teens. Each dot stands for one teen. The same data as a list: S = [11, 1, 9, 14, 3, 2, 17, 3, 11, 16]. What is the mean number of text messages sent in one hour?

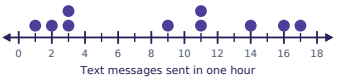

Dot Plots: Finding the Mean · 8

The dot plot shows the number of push-ups done in one minute for 11 students. Each dot stands for one student. The same data as a list: S = [28, 29, 25, 30, 21, 26, 28, 16, 26, 21, 27]. What is the mean number of push-ups done in one minute?

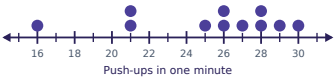

Dot Plots: Finding the Mean · 2

ANSWER

22.7

Dot Plots: Finding the Mean · 1

ANSWER

13.7

Dot Plots: Finding the Mean · 4

ANSWER

7

Dot Plots: Finding the Mean · 3

ANSWER

15.9

Dot Plots: Finding the Mean · 6

ANSWER

12.3

Dot Plots: Finding the Mean · 5

ANSWER

20.4

Dot Plots: Finding the Mean · 8

ANSWER

25.2

Dot Plots: Finding the Mean · 7

ANSWER

8.7

Dot Plots: Finding the Mean · 9

The dot plot shows the number of goals scored for 11 matches. Each dot stands for one match. What is the mean number of goals scored?



Dot Plots: Finding the Mean · 10

The dot plot shows the number of rainy days for 12 months. Each dot stands for one month. What is the mean number of rainy days?

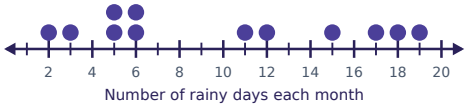

Dot Plots: Finding the Mean · 11

The dot plot shows the number of rainy days for 11 months. Each dot stands for one month. What is the mean number of rainy days?

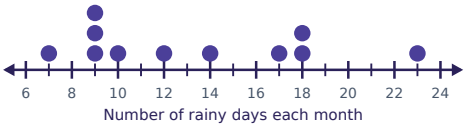

Dot Plots: Finding the Mean · 12

The dot plot shows the number of rainy days for 11 months. Each dot stands for one month. What is the mean number of rainy days?

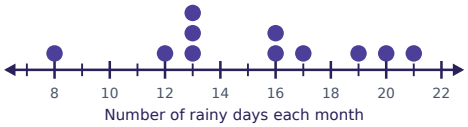

Dot Plots: Finding the Mean · 13

The dot plot shows the number of rainy days for 12 months. Each dot stands for one month. What is the mean number of rainy days?

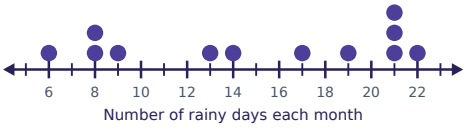

Dot Plots: Finding the Mean · 14

The dot plot shows the number of hours of sleep for 12 students. Each dot stands for one student. What is the mean number of hours of sleep?



Dot Plots: Finding the Mean · 15

The dot plot shows the number of rainy days for 12 months. Each dot stands for one month. What is the mean number of rainy days?

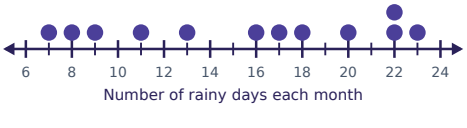

Dot Plots: Finding the Mean · 16

The dot plot shows the number of hours of sleep for 11 students. Each dot stands for one student. What is the mean number of hours of sleep?

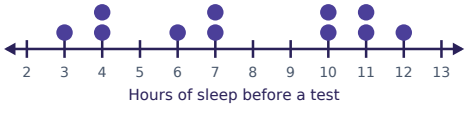

Dot Plots: Finding the Mean · 10

ANSWER

9.9

Dot Plots: Finding the Mean · 9

ANSWER

4.4

Dot Plots: Finding the Mean · 12

ANSWER

15.3

Dot Plots: Finding the Mean · 11

ANSWER

13.3

Dot Plots: Finding the Mean · 14

ANSWER

8.2

Dot Plots: Finding the Mean · 13

ANSWER

14.9

Dot Plots: Finding the Mean · 16

ANSWER

7.7

Dot Plots: Finding the Mean · 15

ANSWER

15.5

Dot Plots: Finding the Mean · 17

The dot plot shows the number of push-ups done in one minute for 12 students. Each dot stands for one student. What is the mean number of push-ups done in one minute?

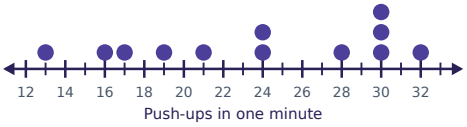

Dot Plots: Finding the Mean · 18

The dot plot shows the high temperature in °C for 12 days. Each dot stands for one day. What is the mean high temperature in °C?

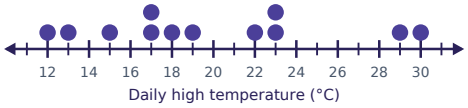

Dot Plots: Finding the Mean · 19

The dot plot shows the number of minutes the bus was late for 12 days. Each dot stands for one day. What is the mean number of minutes the bus was late?

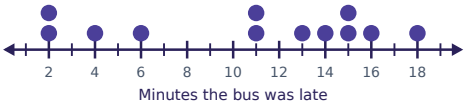

Dot Plots: Finding the Mean · 20

The dot plot shows the number of minutes the bus was late for 13 days. Each dot stands for one day. What is the mean number of minutes the bus was late?

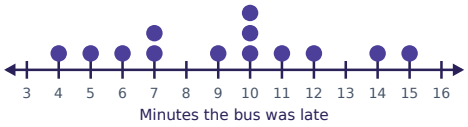

Dot Plots: Finding the Mean · 21

The dot plot shows the number of text messages sent in one hour for 13 teens. Each dot stands for one teen. What is the mean number of text messages sent in one hour?

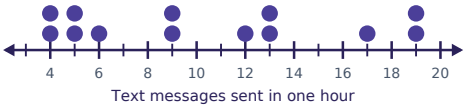

Dot Plots: Finding the Mean · 22

The dot plot shows the high temperature in °C for 12 days. Each dot stands for one day. What is the mean high temperature in °C?

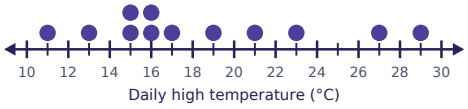

Dot Plots: Finding the Mean · 23

The dot plot shows the number of rainy days for 12 months. Each dot stands for one month. What is the mean number of rainy days?

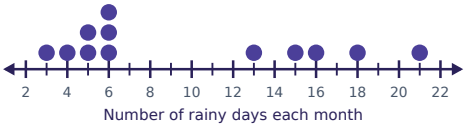

Dot Plots: Finding the Mean · 24

The dot plot shows the number of books read over the summer for 13 students. Each dot stands for one student. What is the mean number of books read over the summer?



Dot Plots: Finding the Mean · 18

ANSWER

19.8

Dot Plots: Finding the Mean · 17

ANSWER

23.7

Dot Plots: Finding the Mean · 20

ANSWER

9.2

Dot Plots: Finding the Mean · 19

ANSWER

10.6

Dot Plots: Finding the Mean · 22

ANSWER

18.5

Dot Plots: Finding the Mean · 21

ANSWER

10.4

Dot Plots: Finding the Mean · 24

ANSWER

8.3

Dot Plots: Finding the Mean · 23

ANSWER

9.8