Midpoint & Distance Formulas · 1

Find the midpoint of the segment with endpoints A(-9, 10) and B(-17, 14).

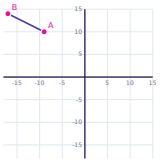

Midpoint & Distance Formulas · 2

Find the distance between A(-5, 11) and B(-17, 27).

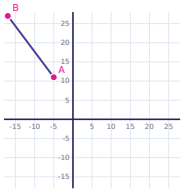

Midpoint & Distance Formulas · 3

Find the midpoint of the segment with endpoints A(-6, 3) and B(-14, 13).

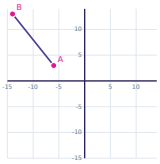

Midpoint & Distance Formulas · 4

Find the distance between A(7, -2) and B(-1, -8).

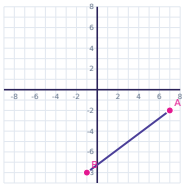

Midpoint & Distance Formulas · 5

Find the midpoint of the segment with endpoints A(-10, 5) and B(-4, 5).

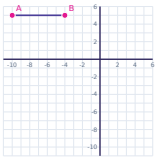

Midpoint & Distance Formulas · 6

Find the distance between A(5, 11) and B(9, 14).

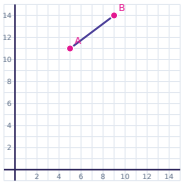

Midpoint & Distance Formulas · 7

Find the midpoint of the segment with endpoints A(-1, -10) and B(3, -20).

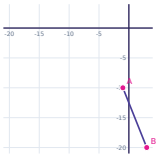

Midpoint & Distance Formulas · 8

Find the distance between A(-9, -9) and B(0, 3).

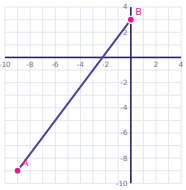

Midpoint & Distance Formulas · 2

ANSWER

20

Midpoint & Distance Formulas · 1

ANSWER

(-13, 12)

Midpoint & Distance Formulas · 4

ANSWER

10

Midpoint & Distance Formulas · 3

ANSWER

(-10, 8)

Midpoint & Distance Formulas · 6

ANSWER

5

Midpoint & Distance Formulas · 5

ANSWER

(-7, 5)

Midpoint & Distance Formulas · 8

ANSWER

15

Midpoint & Distance Formulas · 7

ANSWER

(1, -15)

Midpoint & Distance Formulas · 9

Find the midpoint of the segment with endpoints A(12, -9) and B(22, -19).

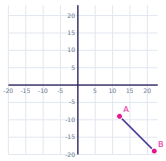

Midpoint & Distance Formulas · 10

Find the distance between A(-5, 2) and B(2, 26).

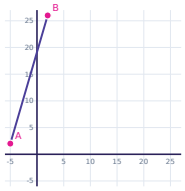

Midpoint & Distance Formulas · 11

Find the midpoint of the segment with endpoints A(10, 3) and B(14, -3).

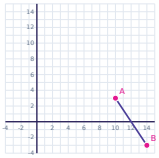

Midpoint & Distance Formulas · 12

Find the distance between A(10, -1) and B(22, -10).

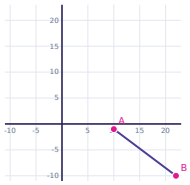

Midpoint & Distance Formulas · 13

Find the midpoint of the segment with endpoints A(0, -9) and B(2, -17).

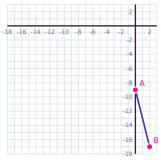

Midpoint & Distance Formulas · 14

Find the distance between A(-9, 5) and B(6, -3).

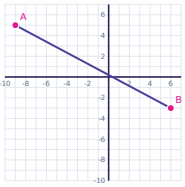

Midpoint & Distance Formulas · 15

Find the midpoint of the segment with endpoints A(3, 6) and B(1, 2).

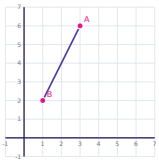

Midpoint & Distance Formulas · 16

Find the distance between A(-9, 12) and B(0, 24).

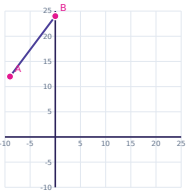

Midpoint & Distance Formulas · 10

ANSWER

25

Midpoint & Distance Formulas · 9

ANSWER

(17, -14)

Midpoint & Distance Formulas · 12

ANSWER

15

Midpoint & Distance Formulas · 11

ANSWER

(12, 0)

Midpoint & Distance Formulas · 14

ANSWER

17

Midpoint & Distance Formulas · 13

ANSWER

(1, -13)

Midpoint & Distance Formulas · 16

ANSWER

15

Midpoint & Distance Formulas · 15

ANSWER

(2, 4)

Midpoint & Distance Formulas · 17

Find the midpoint of the segment with endpoints A(8, 15) and B(12, 9).

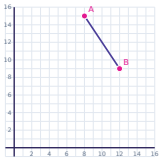

Midpoint & Distance Formulas · 18

Find the distance between A(14, -10) and B(17, -14).

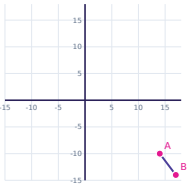

Midpoint & Distance Formulas · 19

Find the midpoint of the segment with endpoints A(13, -12) and B(9, -2).

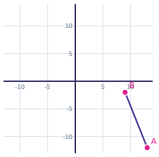

Midpoint & Distance Formulas · 20

Find the distance between A(-5, -1) and B(7, 15).

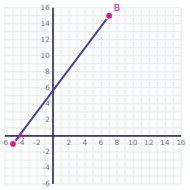

Midpoint & Distance Formulas · 21

Find the midpoint of the segment with endpoints A(13, 2) and B(21, 12).

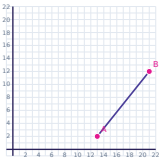

Midpoint & Distance Formulas · 22

Find the distance between A(0, 5) and B(-16, -7).

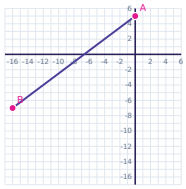

Midpoint & Distance Formulas · 23

Find the midpoint of the segment with endpoints A(-5, -1) and B(-1, 11).

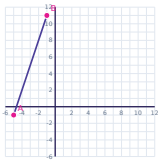

Midpoint & Distance Formulas · 24

Find the distance between A(0, 5) and B(6, 13).

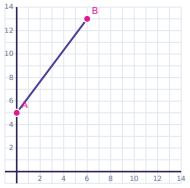

Midpoint & Distance Formulas · 18

ANSWER

5

Midpoint & Distance Formulas · 17

ANSWER

(10, 12)

Midpoint & Distance Formulas · 20

ANSWER

20

Midpoint & Distance Formulas · 19

ANSWER

(11, -7)

Midpoint & Distance Formulas · 22

ANSWER

20

Midpoint & Distance Formulas · 21

ANSWER

(17, 7)

Midpoint & Distance Formulas · 24

ANSWER

10

Midpoint & Distance Formulas · 23

ANSWER

(-3, 5)