Midpoint & Distance Formulas · 1

Find the midpoint of the segment with endpoints A(-15, 6) and B(-25, -2).

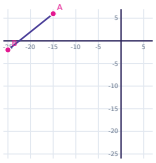

Midpoint & Distance Formulas · 2

Find the distance between A(9, -5) and B(15, -13).

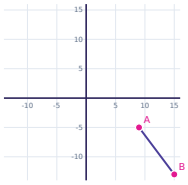

Midpoint & Distance Formulas · 3

Find the midpoint of the segment with endpoints A(-8, -4) and B(-20, -10).

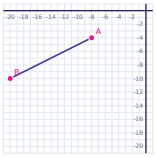

Midpoint & Distance Formulas · 4

Find the distance between A(14, 11) and B(26, -5).

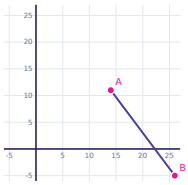

Midpoint & Distance Formulas · 5

Find the midpoint of the segment with endpoints A(-14, -3) and B(-2, -13).

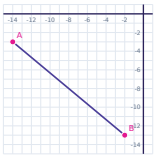

Midpoint & Distance Formulas · 6

Find the distance between A(15, -9) and B(7, -24).

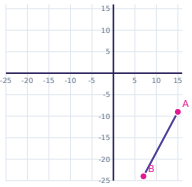

Midpoint & Distance Formulas · 7

Find the midpoint of the segment with endpoints A(-3, 13) and B(-7, 1).

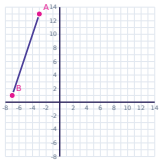

Midpoint & Distance Formulas · 8

Find the distance between A(-14, 4) and B(-7, -20).

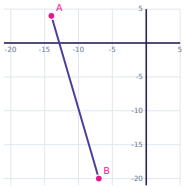

Midpoint & Distance Formulas · 2

ANSWER

10

Midpoint & Distance Formulas · 1

ANSWER

(-20, 2)

Midpoint & Distance Formulas · 4

ANSWER

20

Midpoint & Distance Formulas · 3

ANSWER

(-14, -7)

Midpoint & Distance Formulas · 6

ANSWER

17

Midpoint & Distance Formulas · 5

ANSWER

(-8, -8)

Midpoint & Distance Formulas · 8

ANSWER

25

Midpoint & Distance Formulas · 7

ANSWER

(-5, 7)

Midpoint & Distance Formulas · 9

Find the midpoint of the segment with endpoints A(8, 12) and B(2, 0).

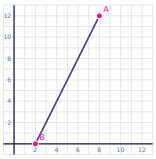

Midpoint & Distance Formulas · 10

Find the distance between A(5, 5) and B(-3, -10).

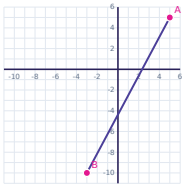

Midpoint & Distance Formulas · 11

Find the midpoint of the segment with endpoints A(10, -6) and B(14, 2).

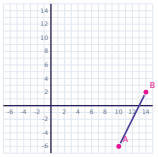

Midpoint & Distance Formulas · 12

Find the distance between A(-5, 6) and B(16, -14).

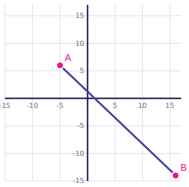

Midpoint & Distance Formulas · 13

Find the midpoint of the segment with endpoints A(-11, 9) and B(-23, 13).

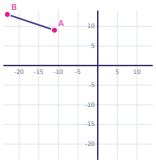

Midpoint & Distance Formulas · 14

Find the distance between A(-5, -12) and B(15, 9).

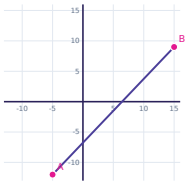

Midpoint & Distance Formulas · 15

Find the midpoint of the segment with endpoints A(-9, -5) and B(-17, -11).

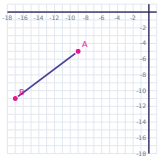

Midpoint & Distance Formulas · 16

Find the distance between A(15, 11) and B(-1, -1).

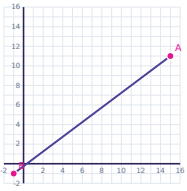

Midpoint & Distance Formulas · 10

ANSWER

17

Midpoint & Distance Formulas · 9

ANSWER

(5, 6)

Midpoint & Distance Formulas · 12

ANSWER

29

Midpoint & Distance Formulas · 11

ANSWER

(12, -2)

Midpoint & Distance Formulas · 14

ANSWER

29

Midpoint & Distance Formulas · 13

ANSWER

(-17, 11)

Midpoint & Distance Formulas · 16

ANSWER

20

Midpoint & Distance Formulas · 15

ANSWER

(-13, -8)

Midpoint & Distance Formulas · 17

Find the midpoint of the segment with endpoints A(-7, -12) and B(5, -12).

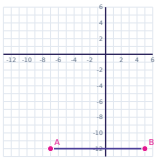

Midpoint & Distance Formulas · 18

Find the distance between A(-13, 5) and B(-4, 17).

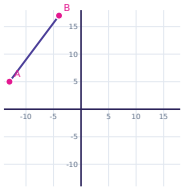

Midpoint & Distance Formulas · 19

Find the midpoint of the segment with endpoints A(7, 11) and B(17, 17).

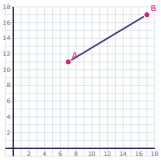

Midpoint & Distance Formulas · 20

Find the distance between A(11, -11) and B(5, -19).

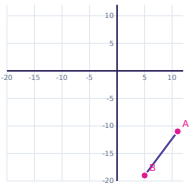

Midpoint & Distance Formulas · 21

Find the midpoint of the segment with endpoints A(-10, -7) and B(-18, -7).

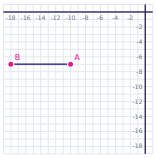

Midpoint & Distance Formulas · 22

Find the distance between A(-7, 8) and B(2, -4).

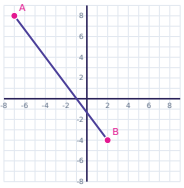

Midpoint & Distance Formulas · 23

Find the midpoint of the segment with endpoints A(9, -9) and B(5, 1).

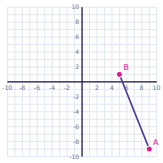

Midpoint & Distance Formulas · 24

Find the distance between A(5, -13) and B(-16, -33).

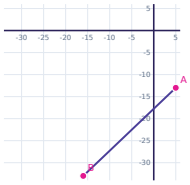

Midpoint & Distance Formulas · 18

ANSWER

15

Midpoint & Distance Formulas · 17

ANSWER

(-1, -12)

Midpoint & Distance Formulas · 20

ANSWER

10

Midpoint & Distance Formulas · 19

ANSWER

(12, 14)

Midpoint & Distance Formulas · 22

ANSWER

15

Midpoint & Distance Formulas · 21

ANSWER

(-14, -7)

Midpoint & Distance Formulas · 24

ANSWER

29

Midpoint & Distance Formulas · 23

ANSWER

(7, -4)