Midpoint & Distance Formulas · 1

Find the midpoint of the segment with endpoints A(-3, 4) and B(1, 12).

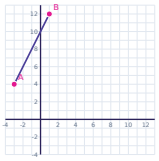


Midpoint & Distance Formulas · 2

Find the distance between A(3, -2) and B(9, 6).

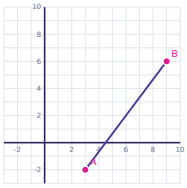


Midpoint & Distance Formulas · 3

Find the midpoint of the segment with endpoints A(-1, 5) and B(1, 3).

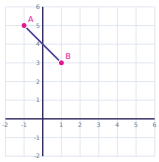


Midpoint & Distance Formulas · 4

Find the distance between A(0, -2) and B(-4, 1).

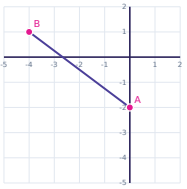


Midpoint & Distance Formulas · 5

Find the midpoint of the segment with endpoints A(5, -5) and B(15, 3).

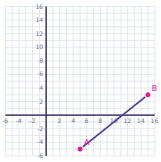


Midpoint & Distance Formulas · 6

Find the distance between A(-5, 2) and B(0, 14).

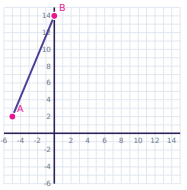


Midpoint & Distance Formulas · 7

Find the midpoint of the segment with endpoints A(3, 4) and B(15, -2).

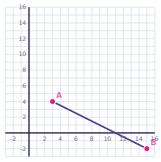


Midpoint & Distance Formulas · 8

Find the distance between A(-2, 4) and B(10, 9).

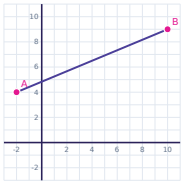

Midpoint & Distance Formulas · 2

**ANSWER**

**10**

Midpoint & Distance Formulas · 1

**ANSWER**

**(-1, 8)**

Midpoint & Distance Formulas · 4

**ANSWER**

**5**

Midpoint & Distance Formulas · 3

**ANSWER**

**(0, 4)**

Midpoint & Distance Formulas · 6

**ANSWER**

**13**

Midpoint & Distance Formulas · 5

**ANSWER**

**(10, -1)**

Midpoint & Distance Formulas · 8

**ANSWER**

**13**

Midpoint & Distance Formulas · 7

**ANSWER**

**(9, 1)**

Midpoint & Distance Formulas · 9

Find the midpoint of the segment with endpoints A(-1, 5) and B(-5, -7).

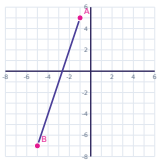


Midpoint & Distance Formulas · 10

Find the distance between A(5, 1) and B(17, 6).

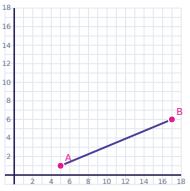


Midpoint & Distance Formulas · 11

Find the midpoint of the segment with endpoints A(-1, -4) and B(9, -2).

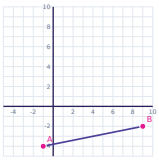


Midpoint & Distance Formulas · 12

Find the distance between A(-7, -7) and B(-19, -12).

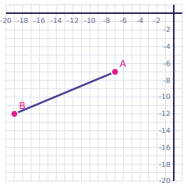


Midpoint & Distance Formulas · 13

Find the midpoint of the segment with endpoints A(-6, -6) and B(-12, -18).

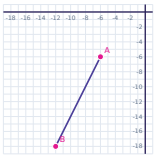


Midpoint & Distance Formulas · 14

Find the distance between A(-5, -1) and B(-10, 11).

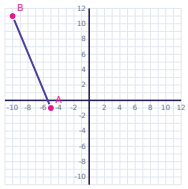


Midpoint & Distance Formulas · 15

Find the midpoint of the segment with endpoints A(-4, -3) and B(6, -9).

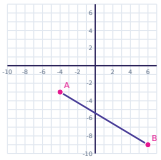


Midpoint & Distance Formulas · 16

Find the distance between A(-1, 5) and B(2, 9).

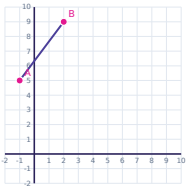

Midpoint & Distance Formulas · 10

**ANSWER**

**13**

Midpoint & Distance Formulas · 9

**ANSWER**

**(-3, -1)**

Midpoint & Distance Formulas · 12

**ANSWER**

**13**

Midpoint & Distance Formulas · 11

**ANSWER**

**(4, -3)**

Midpoint & Distance Formulas · 14

**ANSWER**

**13**

Midpoint & Distance Formulas · 13

**ANSWER**

**(-9, -12)**

Midpoint & Distance Formulas · 16

**ANSWER**

**5**

Midpoint & Distance Formulas · 15

**ANSWER**

**(1, -6)**

Midpoint & Distance Formulas · 17

Find the midpoint of the segment with endpoints A(7, 1) and B(19, 3).

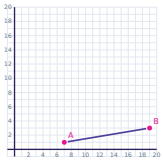


Midpoint & Distance Formulas · 18

Find the distance between A(8, 9) and B(12, 12).

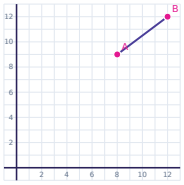


Midpoint & Distance Formulas · 19

Find the midpoint of the segment with endpoints A(-2, -2) and B(0, 8).

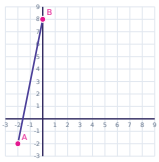


Midpoint & Distance Formulas · 20

Find the distance between A(2, 7) and B(17, 15).

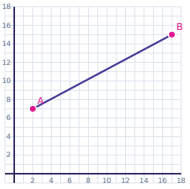


Midpoint & Distance Formulas · 21

Find the midpoint of the segment with endpoints A(-7, -8) and B(-9, -20).

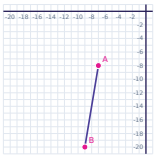


Midpoint & Distance Formulas · 22

Find the distance between A(-4, -9) and B(5, -21).

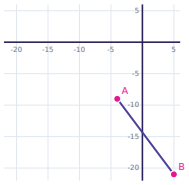


Midpoint & Distance Formulas · 23

Find the midpoint of the segment with endpoints A(1, 5) and B(1, -3).

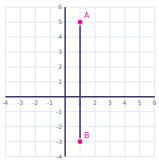


Midpoint & Distance Formulas · 24

Find the distance between A(9, -9) and B(21, 0).

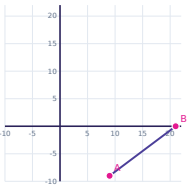

Midpoint & Distance Formulas · 18

**ANSWER**

**5**

Midpoint & Distance Formulas · 17

**ANSWER**

**(13, 2)**

Midpoint & Distance Formulas · 20

**ANSWER**

**17**

Midpoint & Distance Formulas · 19

**ANSWER**

**(-1, 3)**

Midpoint & Distance Formulas · 22

**ANSWER**

**15**

Midpoint & Distance Formulas · 21

**ANSWER**

**(-8, -14)**

Midpoint & Distance Formulas · 24

**ANSWER**

**15**

Midpoint & Distance Formulas · 23

**ANSWER**

**(1, 1)**