Midpoint & Distance Formulas · 1

Find the midpoint of the segment with endpoints A(-3, 4) and B(1, 12).

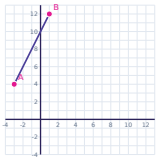

Midpoint & Distance Formulas · 2

Find the distance between A(3, -2) and B(9, 6).

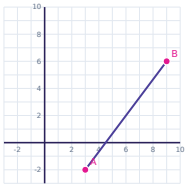

Midpoint & Distance Formulas · 3

Find the midpoint of the segment with endpoints A(-1, 5) and B(1, 3).

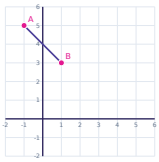

Midpoint & Distance Formulas · 4

Find the distance between A(0, -2) and B(-4, 1).

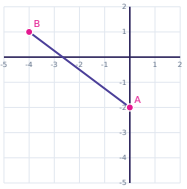

Midpoint & Distance Formulas · 5

Find the midpoint of the segment with endpoints A(5, -5) and B(15, 3).

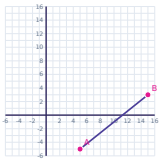

Midpoint & Distance Formulas · 6

Find the distance between A(-5, 2) and B(0, 14).

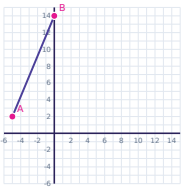

Midpoint & Distance Formulas · 7

Find the midpoint of the segment with endpoints A(3, 4) and B(15, -2).

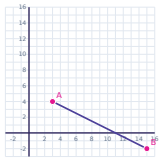

Midpoint & Distance Formulas · 8

Find the distance between A(-2, 4) and B(10, 9).

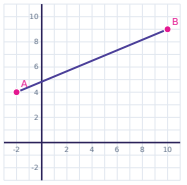

Midpoint & Distance Formulas · 2

ANSWER

10

Midpoint & Distance Formulas · 1

ANSWER

(-1, 8)

Midpoint & Distance Formulas · 4

ANSWER

5

Midpoint & Distance Formulas · 3

ANSWER

(0, 4)

Midpoint & Distance Formulas · 6

ANSWER

13

Midpoint & Distance Formulas · 5

ANSWER

(10, -1)

Midpoint & Distance Formulas · 8

ANSWER

13

Midpoint & Distance Formulas · 7

ANSWER

(9, 1)

Midpoint & Distance Formulas · 9

Find the midpoint of the segment with endpoints A(-1, 5) and B(-5, -7).

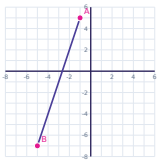

Midpoint & Distance Formulas · 10

Find the distance between A(5, 1) and B(17, 6).

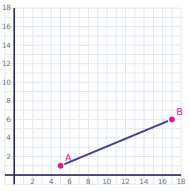

Midpoint & Distance Formulas · 11

Find the midpoint of the segment with endpoints A(-1, -4) and B(9, -2).

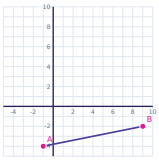

Midpoint & Distance Formulas · 12

Find the distance between A(-7, -7) and B(-19, -12).

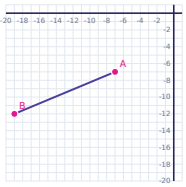

Midpoint & Distance Formulas · 13

Find the midpoint of the segment with endpoints A(-6, -6) and B(-12, -18).

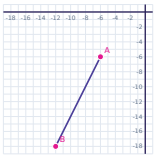

Midpoint & Distance Formulas · 14

Find the distance between A(-5, -1) and B(-10, 11).

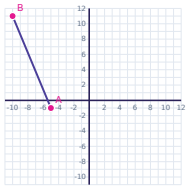

Midpoint & Distance Formulas · 15

Find the midpoint of the segment with endpoints A(-4, -3) and B(6, -9).

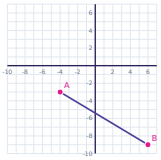

Midpoint & Distance Formulas · 16

Find the distance between A(-1, 5) and B(2, 9).

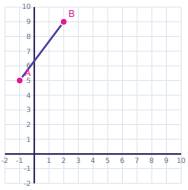

Midpoint & Distance Formulas · 10

ANSWER

13

Midpoint & Distance Formulas · 9

ANSWER

(-3, -1)

Midpoint & Distance Formulas · 12

ANSWER

13

Midpoint & Distance Formulas · 11

ANSWER

(4, -3)

Midpoint & Distance Formulas · 14

ANSWER

13

Midpoint & Distance Formulas · 13

ANSWER

(-9, -12)

Midpoint & Distance Formulas · 16

ANSWER

5

Midpoint & Distance Formulas · 15

ANSWER

(1, -6)

Midpoint & Distance Formulas · 17

Find the midpoint of the segment with endpoints A(7, 1) and B(19, 3).

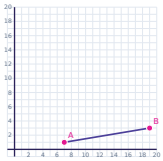

Midpoint & Distance Formulas · 18

Find the distance between A(8, 9) and B(12, 12).

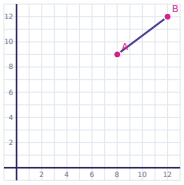

Midpoint & Distance Formulas · 19

Find the midpoint of the segment with endpoints A(-2, -2) and B(0, 8).

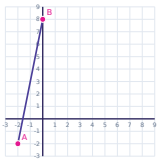

Midpoint & Distance Formulas · 20

Find the distance between A(2, 7) and B(17, 15).

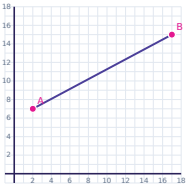

Midpoint & Distance Formulas · 21

Find the midpoint of the segment with endpoints A(-7, -8) and B(-9, -20).

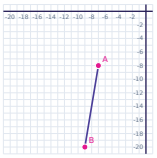

Midpoint & Distance Formulas · 22

Find the distance between A(-4, -9) and B(5, -21).

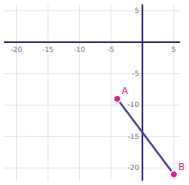

Midpoint & Distance Formulas · 23

Find the midpoint of the segment with endpoints A(1, 5) and B(1, -3).

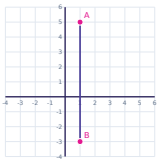

Midpoint & Distance Formulas · 24

Find the distance between A(9, -9) and B(21, 0).

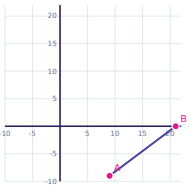

Midpoint & Distance Formulas · 18

ANSWER

5

Midpoint & Distance Formulas · 17

ANSWER

(13, 2)

Midpoint & Distance Formulas · 20

ANSWER

17

Midpoint & Distance Formulas · 19

ANSWER

(-1, 3)

Midpoint & Distance Formulas · 22

ANSWER

15

Midpoint & Distance Formulas · 21

ANSWER

(-8, -14)

Midpoint & Distance Formulas · 24

ANSWER

15

Midpoint & Distance Formulas · 23

ANSWER

(1, 1)