Task card 1 Area & Perimeter of Polygons

Find the perimeter of a rectangle with length 16 and width 4.

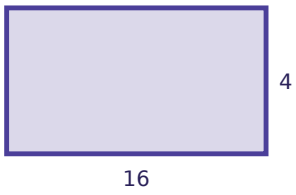

Task card 2 Area & Perimeter of Polygons

Find the area of a triangle with base 13 and height 11.

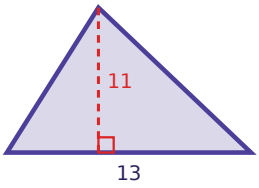

Task card 3 Area & Perimeter of Polygons

Find the area of a rectangle with length 16 and width 8.

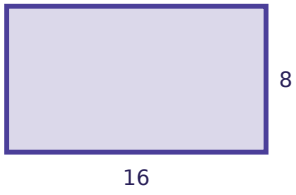

Task card 4 Area & Perimeter of Polygons

Find the area of a triangle with base 8 and height 12.

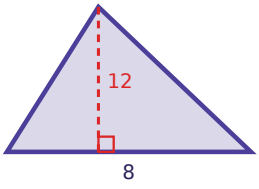

Task card 5 Area & Perimeter of Polygons

Find the area of a rectangle with length 4 and width 16.

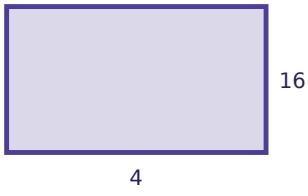

Task card 6 Area & Perimeter of Polygons

Find the area of a triangle with base 17 and height 8.

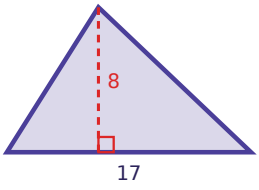

Task card 7 Area & Perimeter of Polygons

Find the area of a rectangle with length 8 and width 8.

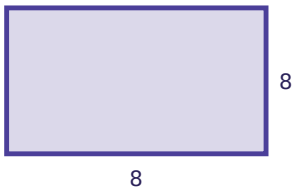

Task card 8 Area & Perimeter of Polygons

Find the area of a triangle with base 12 and height 16.

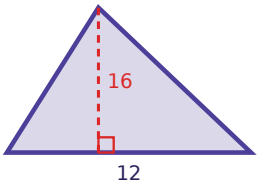

Task card 9 Area & Perimeter of Polygons

Find the area of a rectangle with length 11 and width 19.



Task card 10 Area & Perimeter of Polygons

Find the area of a triangle with base 7 and height 19.

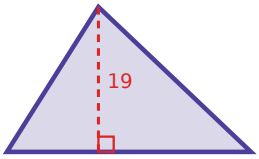

Task card 11 Area & Perimeter of Polygons

Find the area of a rectangle with length 10 and width 9.



Task card 12 Area & Perimeter of Polygons

Find the area of a triangle with base 13 and height 19.

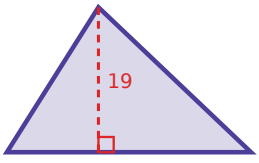

Task card 13 Area & Perimeter of Polygons

Find the perimeter of a rectangle with length 5 and width 8.

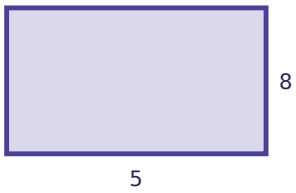

Task card 14 Area & Perimeter of Polygons

Find the area of a triangle with base 14 and height 6.

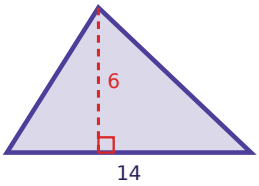

Task card 15 Area & Perimeter of Polygons

Find the area of a rectangle with length 13 and width 6.



Task card 16 Area & Perimeter of Polygons

Find the area of a triangle with base 9 and height 18.

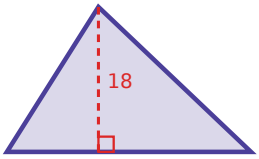

Task card 17 Area & Perimeter of Polygons

Find the perimeter of a rectangle with length 12 and width 12.



Task card 18 Area & Perimeter of Polygons

Find the area of a triangle with base 23 and height 4.

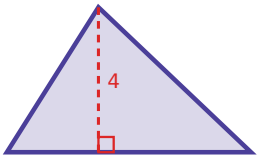

Task card 19 Area & Perimeter of Polygons

Find the area of a rectangle with length 4 and width 22.

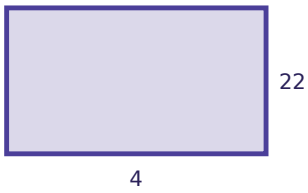

Task card 20 Area & Perimeter of Polygons

Find the area of a triangle with base 6 and height 14.

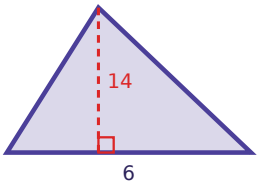

Task card 21 Area & Perimeter of Polygons

Find the perimeter of a rectangle with length 8 and width 19.

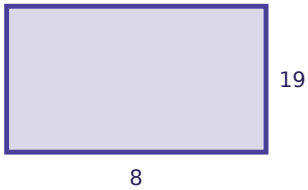

Task card 22 Area & Perimeter of Polygons

Find the area of a triangle with base 10 and height 14.

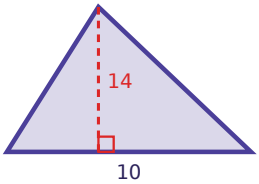

Task card 23 Area & Perimeter of Polygons

Find the area of a rectangle with length 7 and width 6.

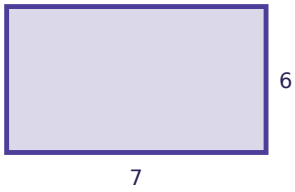

Task card 24 Area & Perimeter of Polygons

Find the area of a triangle with base 19 and height 11.

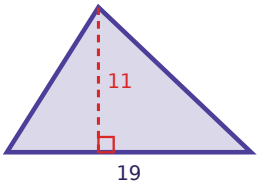

Area & Perimeter of Polygons Task Cards

Recording sheet · Grade 10 · Solve each problem. Round to one decimal place if needed.

Name: _____ Date: _____

Scan to check your answers

1	2	3	4
5	6	7	8
9	10	11	12
13	14	15	16
17	18	19	20
21	22	23	24

Area & Perimeter of Polygons Task Cards: Answer Key

Grade 10 · Medium

The answers online

1. 40	**2.** 71.5	**3.** 128
4. 48	**5.** 64	**6.** 68
7. 64	**8.** 96	**9.** 209
10. 66.5	**11.** 90	**12.** 123.5
13. 26	**14.** 42	**15.** 78
16. 81	**17.** 48	**18.** 46
19. 88	**20.** 42	**21.** 54
22. 70	**23.** 42	**24.** 104.5