Task card 1 Area & Perimeter of Polygons

Find the perimeter of a rectangle with length 17 and width 3.

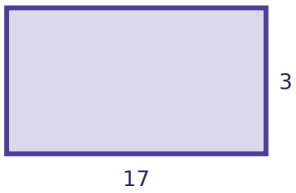

Task card 2 Area & Perimeter of Polygons

Find the area of a triangle with base 25 and height 25.

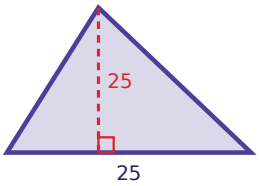

Task card 3 Area & Perimeter of Polygons

Find the perimeter of a rectangle with length 17 and width 27.



Task card 4 Area & Perimeter of Polygons

Find the area of a triangle with base 12 and height 16.

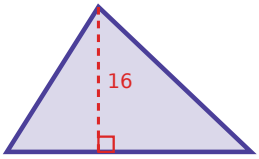

Task card 5 Area & Perimeter of Polygons

Find the perimeter of a rectangle with length 8 and width 25.



Task card 6 Area & Perimeter of Polygons

Find the area of a triangle with base 10 and height 15.

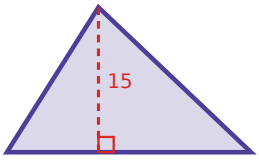

Task card 7 Area & Perimeter of Polygons

Find the area of a rectangle with length 25 and width 10.

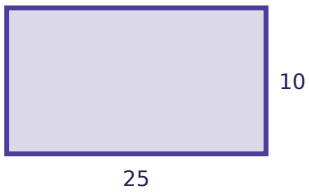

Task card 8 Area & Perimeter of Polygons

Find the area of a triangle with base 5 and height 15.

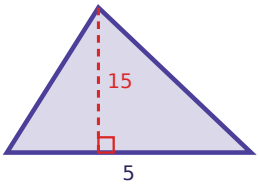

Task card 9 Area & Perimeter of Polygons

Find the perimeter of a rectangle with length 8 and width 12.



Task card 10 Area & Perimeter of Polygons

Find the area of a triangle with base 5 and height 30.

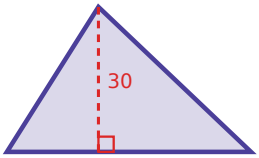

Task card 11 Area & Perimeter of Polygons

Find the area of a rectangle with length 9 and width 14.



Task card 12 Area & Perimeter of Polygons

Find the area of a triangle with base 17 and height 5.

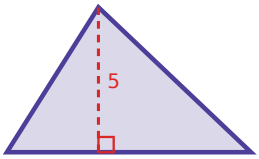

Task card 13 Area & Perimeter of Polygons

Find the perimeter of a rectangle with length 11 and width 11.

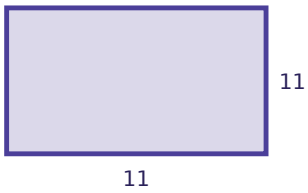

Task card 14 Area & Perimeter of Polygons

Find the area of a triangle with base 15 and height 17.

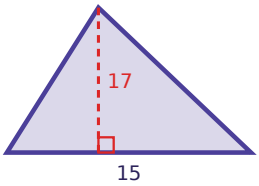

Task card 15 Area & Perimeter of Polygons

Find the area of a rectangle with length 29 and width 27.



Task card 16 Area & Perimeter of Polygons

Find the area of a triangle with base 18 and height 28.

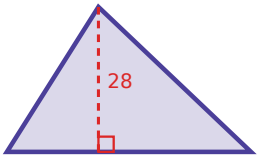

Task card 17 Area & Perimeter of Polygons

Find the perimeter of a rectangle with length 21 and width 9.



Task card 18 Area & Perimeter of Polygons

Find the area of a triangle with base 13 and height 23.

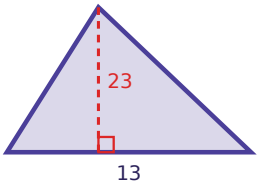

Task card 19 Area & Perimeter of Polygons

Find the perimeter of a rectangle with length 7 and width 15.

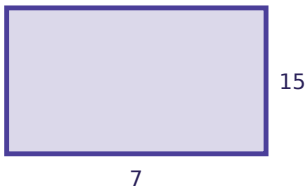

Task card 20 Area & Perimeter of Polygons

Find the area of a triangle with base 9 and height 11.

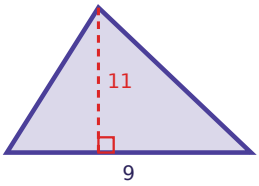

Task card 21 Area & Perimeter of Polygons

Find the area of a rectangle with length 18 and width 27.

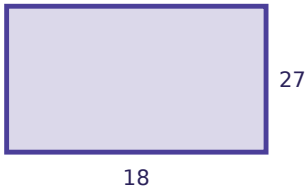

Task card 22 Area & Perimeter of Polygons

Find the area of a triangle with base 27 and height 11.

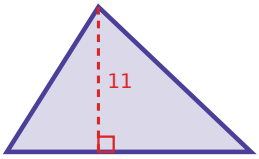

Task card 23 Area & Perimeter of Polygons

Find the area of a rectangle with length 4 and width 17.



Task card 24 Area & Perimeter of Polygons

Find the area of a triangle with base 14 and height 16.

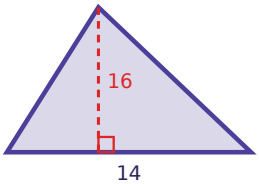

Area & Perimeter of Polygons Task Cards

Recording sheet · Grade 10 · Solve each problem. Round to one decimal place if needed.

Name: _____ Date: _____

Scan to check your answers

1	2	3	4
5	6	7	8
9	10	11	12
13	14	15	16
17	18	19	20
21	22	23	24

Area & Perimeter of Polygons Task Cards: Answer Key

Grade 10 · Hard

The answers online

1. 40	**2.** 312.5	**3.** 88
4. 96	**5.** 66	**6.** 75
7. 250	**8.** 37.5	**9.** 40
10. 75	**11.** 126	**12.** 42.5
13. 44	**14.** 127.5	**15.** 783
16. 252	**17.** 60	**18.** 149.5
19. 44	**20.** 49.5	**21.** 486
22. 148.5	**23.** 68	**24.** 112