Area & Perimeter of Polygons · 1

Find the perimeter of a rectangle with length 6 and width 4.

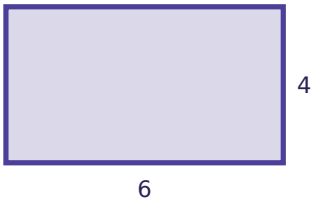

Area & Perimeter of Polygons · 2

Find the area of a triangle with base 5 and height 7.

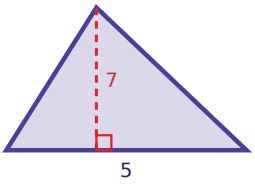

Area & Perimeter of Polygons · 3

Find the perimeter of a rectangle with length 4 and width 8.

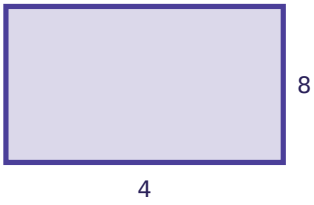

Area & Perimeter of Polygons · 4

Find the area of a triangle with base 5 and height 5.

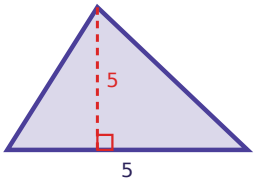

Area & Perimeter of Polygons · 5

Find the perimeter of a rectangle with length 6 and width 5.

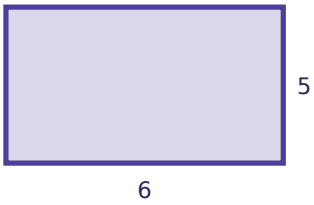

Area & Perimeter of Polygons · 6

Find the area of a triangle with base 7 and height 4.

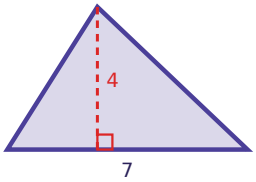

Area & Perimeter of Polygons · 7

Find the perimeter of a rectangle with length 5 and width 8.

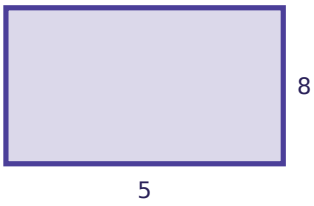

Area & Perimeter of Polygons · 8

Find the area of a triangle with base 9 and height 9.

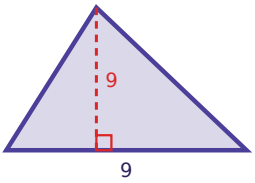

Area & Perimeter of Polygons · 2

ANSWER

17.5

Area & Perimeter of Polygons · 1

ANSWER

20

Area & Perimeter of Polygons · 4

ANSWER

12.5

Area & Perimeter of Polygons · 3

ANSWER

24

Area & Perimeter of Polygons · 6

ANSWER

14

Area & Perimeter of Polygons · 5

ANSWER

22

Area & Perimeter of Polygons · 8

ANSWER

40.5

Area & Perimeter of Polygons · 7

ANSWER

26

Area & Perimeter of Polygons · 9

Find the perimeter of a rectangle with length 7 and width 6.

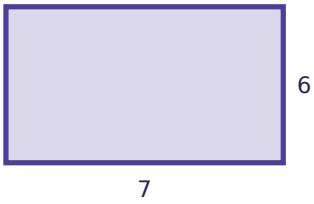

Area & Perimeter of Polygons · 10

Find the area of a triangle with base 10 and height 7.

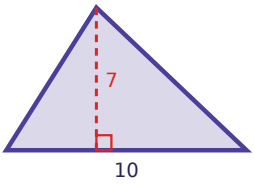

Area & Perimeter of Polygons · 11

Find the area of a rectangle with length 3 and width 5.



Area & Perimeter of Polygons · 12

Find the area of a triangle with base 8 and height 4.

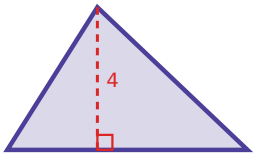

Area & Perimeter of Polygons · 13

Find the area of a rectangle with length 10 and width 3.



Area & Perimeter of Polygons · 14

Find the area of a triangle with base 5 and height 6.

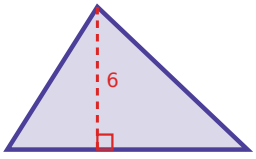

Area & Perimeter of Polygons · 15

Find the area of a rectangle with length 8 and width 5.



Area & Perimeter of Polygons · 16

Find the area of a triangle with base 6 and height 7.

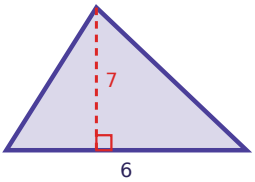

Area & Perimeter of Polygons · 10

ANSWER

35

Area & Perimeter of Polygons · 9

ANSWER

26

Area & Perimeter of Polygons · 12

ANSWER

16

Area & Perimeter of Polygons · 11

ANSWER

15

Area & Perimeter of Polygons · 14

ANSWER

15

Area & Perimeter of Polygons · 13

ANSWER

30

Area & Perimeter of Polygons · 16

ANSWER

21

Area & Perimeter of Polygons · 15

ANSWER

40

Area & Perimeter of Polygons · 17

Find the area of a rectangle with length 8 and width 11.

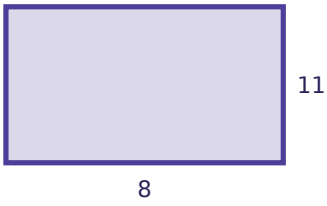

Area & Perimeter of Polygons · 18

Find the area of a triangle with base 6 and height 14.

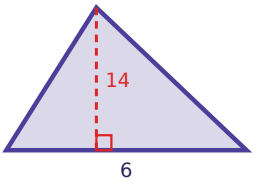

Area & Perimeter of Polygons · 19

Find the perimeter of a rectangle with length 4 and width 15.



Area & Perimeter of Polygons · 20

Find the perimeter of a rectangle with length 14 and width 4.



Area & Perimeter of Polygons · 21

Find the area of a triangle with base 7 and height 8.

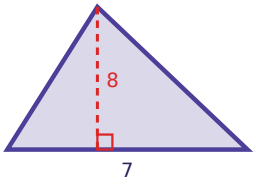

Area & Perimeter of Polygons · 22

Find the perimeter of a rectangle with length 9 and width 14.



Area & Perimeter of Polygons · 23

Find the area of a triangle with base 15 and height 6.

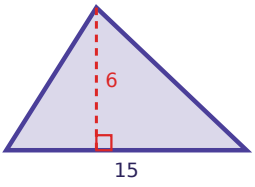

Area & Perimeter of Polygons · 24

Find the perimeter of a rectangle with length 9 and width 8.



Area & Perimeter of Polygons · 18

ANSWER

42

Area & Perimeter of Polygons · 17

ANSWER

88

Area & Perimeter of Polygons · 20

ANSWER

36

Area & Perimeter of Polygons · 19

ANSWER

38

Area & Perimeter of Polygons · 22

ANSWER

46

Area & Perimeter of Polygons · 21

ANSWER

28

Area & Perimeter of Polygons · 24

ANSWER

34

Area & Perimeter of Polygons · 23

ANSWER

45