Task card 1 Adding to a Two-Digit Number

50 + 1 = ___

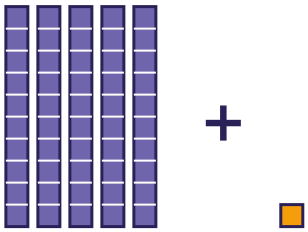

Task card 2 Adding to a Two-Digit Number

27 + 1 = ___

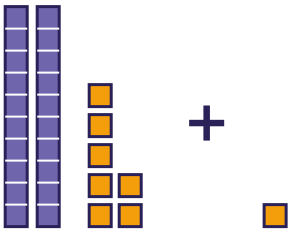

Task card 3 Adding to a Two-Digit Number

38 + 1 = ___

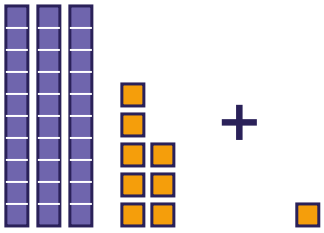

Task card 4 Adding to a Two-Digit Number

Count the tens and the ones.

How many in all?

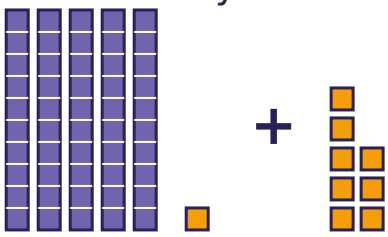

Task card 5 Adding to a Two-Digit Number

4 ones + 3 ones = 7 ones. The 2 tens stay. 24 + 3 = ___

Task card 6 Adding to a Two-Digit Number

Add.

$$\begin{array}{r} 26 \\ +\ 2 \\ \hline \end{array}$$

Task card 7 Adding to a Two-Digit Number

Sam has 45 buttons and gets 3 more. How many buttons does Sam have now?

Task card 8 Adding to a Two-Digit Number

58 + 1 = ___

Task card 9 Adding to a Two-Digit Number

33 + 2 = ___

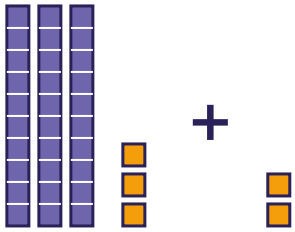

Task card 10 Adding to a Two-Digit Number

50 + 9 = ___

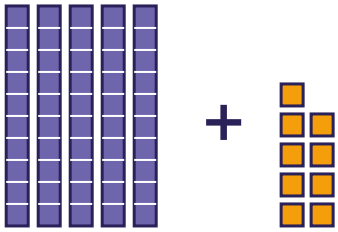

Task card 11 Adding to a Two-Digit Number

20 + 8 = ___

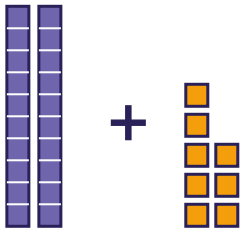

Task card 12 Adding to a Two-Digit Number

Count the tens and the ones.

How many in all?

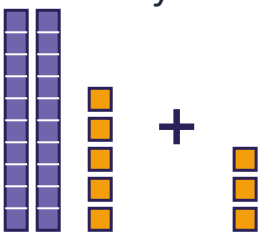

Task card 13 Adding to a Two-Digit Number

2 ones + 5 ones = 7 ones. The 3 tens stay. 32 + 5 = ___

Task card 14 Adding to a Two-Digit Number

Add.

$$\begin{array}{r} 13 \\ +\ 1 \\ \hline \end{array}$$

Task card 15 Adding to a Two-Digit Number

Leo has 47 marbles and gets 2 more. How many marbles does Leo have now?

Task card 16 Adding to a Two-Digit Number

26 + 1 = ___

Task card 17 Adding to a Two-Digit Number

86 + 3 = ___

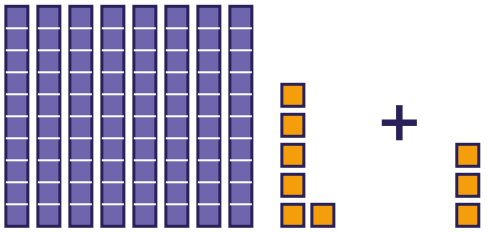

Task card 18 Adding to a Two-Digit Number

88 + 10 = ___

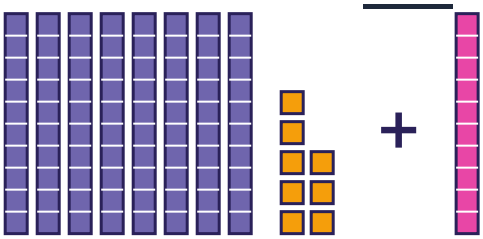

Task card 19 Adding to a Two-Digit Number

Count the tens and the ones.

How many in all?

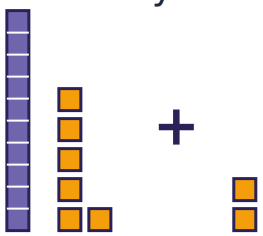

Task card 20 Adding to a Two-Digit Number

1 ten + 5 tens = 6 tens. The 9 ones stay. 19 + 50 = ___

Task card 21 Adding to a Two-Digit Number

Add.

$$\begin{array}{r} 37 \\ +\ 2 \\ \hline \end{array}$$

Task card 22 Adding to a Two-Digit Number

Sam has 28 beads and gets 70 more. How many beads does Sam have now?

Task card 23 Adding to a Two-Digit Number

23 + 4 = ___

Task card 24 Adding to a Two-Digit Number

47 + 1 = ___

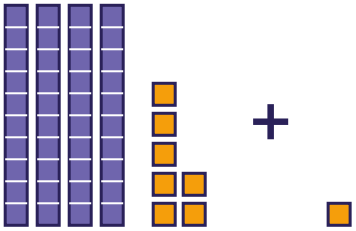

Adding to a Two-Digit Number Task Cards

Recording sheet · Grade 1 · Add the tens and the ones. The same kind of sum comes in different shapes.

Name: _____ Date: _____

Scan to check your answers

1	2	3	4
5	6	7	8
9	10	11	12
13	14	15	16
17	18	19	20
21	22	23	24

Adding to a Two-Digit Number Task Cards: Answer Key

Grade 1 · Easy

The answers online

1. 51	**2.** 28	**3.** 39
4. 59	**5.** 27	**6.** 28
7. 48	**8.** 59	**9.** 35
10. 59	**11.** 28	**12.** 28
13. 37	**14.** 14	**15.** 49
16. 27	**17.** 89	**18.** 98
19. 18	**20.** 69	**21.** 39
22. 98	**23.** 27	**24.** 48