Adding to a Two-Digit Number · 1

$73 + 20 = ___$

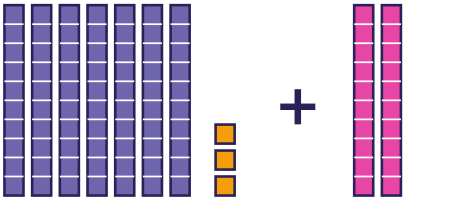

Adding to a Two-Digit Number · 2

$40 + 50 = ___$

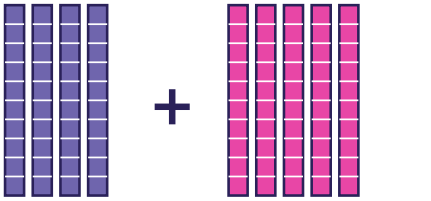

Adding to a Two-Digit Number · 3

$65 + 10 = ___$

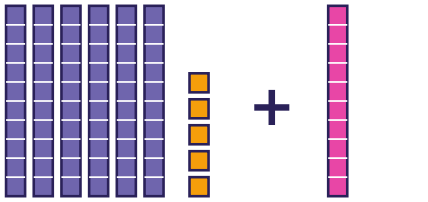

Adding to a Two-Digit Number · 4

Count the tens and the ones.

How many in all?

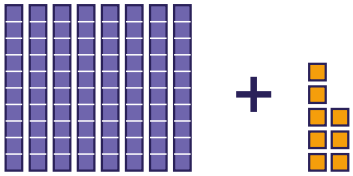

Adding to a Two-Digit Number · 5

2 tens + 2 tens = 4 tens. The 4 ones stay. 24 + 20 = ___

Adding to a Two-Digit Number · 6

Add.

$$\begin{array}{r} 70 \\ +\ 1 \\ \hline \end{array}$$

Adding to a Two-Digit Number · 7

Max has 16 toy cars and gets 2 more. How many toy cars does Max have now?

Adding to a Two-Digit Number · 8

$64 + 3 = ___$

Adding to a Two-Digit Number · 2

ANSWER

90

Adding to a Two-Digit Number · 1

ANSWER

93

Adding to a Two-Digit Number · 4

ANSWER

88

Adding to a Two-Digit Number · 3

ANSWER

75

Adding to a Two-Digit Number · 6

ANSWER

71

Adding to a Two-Digit Number · 5

ANSWER

44

Adding to a Two-Digit Number · 8

ANSWER

67

Adding to a Two-Digit Number · 7

ANSWER

18

Adding to a Two-Digit Number · 9

$43 + 20 = ___$

Adding to a Two-Digit Number · 10

$50 + 40 = ___$

Adding to a Two-Digit Number · 11

$5 + 26 = ___$

Adding to a Two-Digit Number · 12

$72 + 10 = ___$

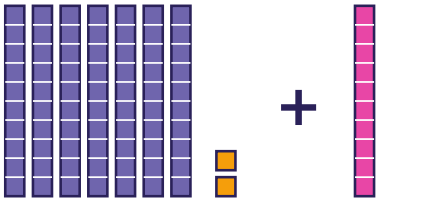

Adding to a Two-Digit Number · 13

85 + 5 = 90, and 4 more. 85 + 9 = ___

Adding to a Two-Digit Number · 14

Add.

$$\begin{array}{r} 36 \\ +\ 40 \\ \hline \end{array}$$

Adding to a Two-Digit Number · 15

Sam has 25 crayons and gets 7 more. How many crayons does Sam have now?

Adding to a Two-Digit Number · 16

$66 + ___ = 86$

Adding to a Two-Digit Number · 10

ANSWER

90

Adding to a Two-Digit Number · 9

ANSWER

63

Adding to a Two-Digit Number · 12

ANSWER

82

Adding to a Two-Digit Number · 11

ANSWER

31

Adding to a Two-Digit Number · 14

ANSWER

76

Adding to a Two-Digit Number · 13

ANSWER

94

Adding to a Two-Digit Number · 16

ANSWER

20

Adding to a Two-Digit Number · 15

ANSWER

32

Adding to a Two-Digit Number · 17

25 + 5 = ___

Adding to a Two-Digit Number · 18

76 + 20 = ___

Adding to a Two-Digit Number · 19

40 + 33 = ___

Adding to a Two-Digit Number · 20

21 + 60 = ___

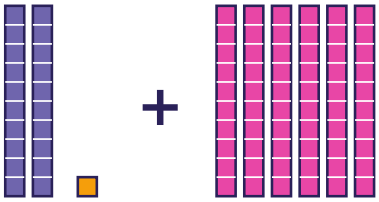

Adding to a Two-Digit Number · 21

4 tens + 3 tens = 7 tens. The 7 ones stay. 47 + 30 = ___

Adding to a Two-Digit Number · 22

Add.

$$\begin{array}{r} 13 \\ +\ 30 \\ \hline \end{array}$$

Adding to a Two-Digit Number · 23

Sam has 52 shells and gets 40 more. How many shells does Sam have now?

Adding to a Two-Digit Number · 24

26 + ___ = 56

Adding to a Two-Digit Number · 18

ANSWER

96

Adding to a Two-Digit Number · 17

ANSWER

30

Adding to a Two-Digit Number · 20

ANSWER

81

Adding to a Two-Digit Number · 19

ANSWER

73

Adding to a Two-Digit Number · 22

ANSWER

43

Adding to a Two-Digit Number · 21

ANSWER

77

Adding to a Two-Digit Number · 24

ANSWER

30

Adding to a Two-Digit Number · 23

ANSWER

92