Adding to a Two-Digit Number · 1

$50 + 1 = ___$

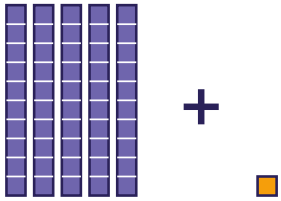

Adding to a Two-Digit Number · 2

$27 + 1 = ___$

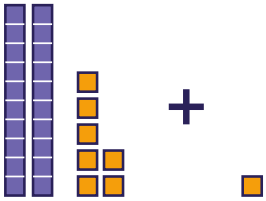

Adding to a Two-Digit Number · 3

$38 + 1 = ___$

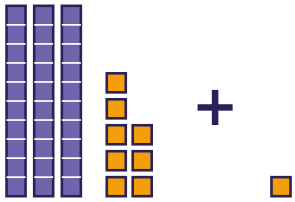

Adding to a Two-Digit Number · 4

Count the tens and the ones.

How many in all?

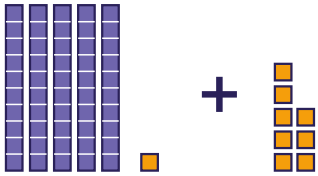

Adding to a Two-Digit Number · 5

4 ones + 3 ones = 7 ones.

The 2 tens stay. 24 + 3 = ___

Adding to a Two-Digit Number · 6

Add.

$$\begin{array}{r} 26 \\ +\ \ 2 \\ \hline \end{array}$$

Adding to a Two-Digit Number · 7

Sam has 45 buttons and gets 3 more. How many buttons does Sam have now?

Adding to a Two-Digit Number · 8

$58 + 1 = ___$

Adding to a Two-Digit Number · 2

ANSWER

28

Adding to a Two-Digit Number · 1

ANSWER

51

Adding to a Two-Digit Number · 4

ANSWER

59

Adding to a Two-Digit Number · 3

ANSWER

39

Adding to a Two-Digit Number · 6

ANSWER

28

Adding to a Two-Digit Number · 5

ANSWER

27

Adding to a Two-Digit Number · 8

ANSWER

59

Adding to a Two-Digit Number · 7

ANSWER

48

Adding to a Two-Digit Number · 9

$33 + 2 = ___$

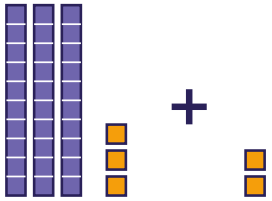

Adding to a Two-Digit Number · 10

$50 + 9 = ___$

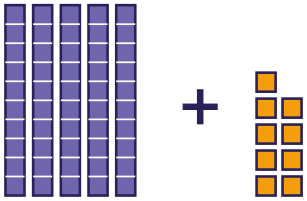

Adding to a Two-Digit Number · 11

$20 + 8 = ___$

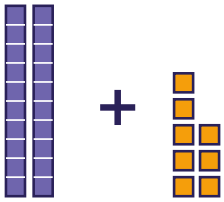

Adding to a Two-Digit Number · 12

Count the tens and the ones.

How many in all?

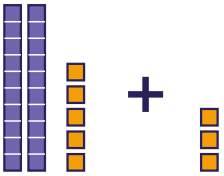

Adding to a Two-Digit Number · 13

2 ones + 5 ones = 7 ones.

The 3 tens stay. 32 + 5 = ___

Adding to a Two-Digit Number · 14

Add.

$$\begin{array}{r} 13 \\ +\ 1 \\ \hline \end{array}$$

Adding to a Two-Digit Number · 15

Leo has 47 marbles and gets 2 more. How many marbles does Leo have now?

Adding to a Two-Digit Number · 16

$26 + 1 = ___$

Adding to a Two-Digit Number · 10

ANSWER

59

Adding to a Two-Digit Number · 9

ANSWER

35

Adding to a Two-Digit Number · 12

ANSWER

28

Adding to a Two-Digit Number · 11

ANSWER

28

Adding to a Two-Digit Number · 14

ANSWER

14

Adding to a Two-Digit Number · 13

ANSWER

37

Adding to a Two-Digit Number · 16

ANSWER

27

Adding to a Two-Digit Number · 15

ANSWER

49

Adding to a Two-Digit Number · 17

$86 + 3 = ___$

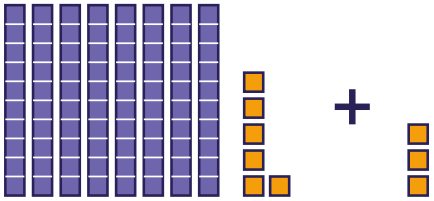

Adding to a Two-Digit Number · 18

$88 + 10 = ___$

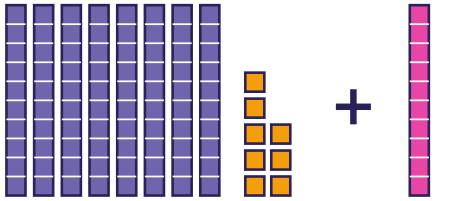

Adding to a Two-Digit Number · 19

Count the tens and the ones.

How many in all?

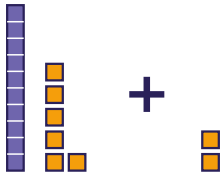

Adding to a Two-Digit Number · 20

1 ten + 5 tens = 6 tens. The 9 ones stay. 19 + 50 = ___

Adding to a Two-Digit Number · 21

Add.

$$\begin{array}{r} 37 \\ +\ 2 \\ \hline \end{array}$$

Adding to a Two-Digit Number · 22

Sam has 28 beads and gets 70 more. How many beads does Sam have now?

Adding to a Two-Digit Number · 23

$23 + 4 = ___$

Adding to a Two-Digit Number · 24

$47 + 1 = ___$

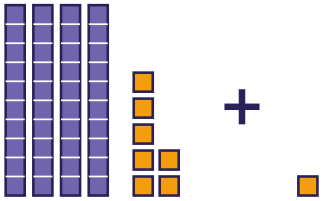

Adding to a Two-Digit Number · 18

ANSWER

98

Adding to a Two-Digit Number · 17

ANSWER

89

Adding to a Two-Digit Number · 20

ANSWER

69

Adding to a Two-Digit Number · 19

ANSWER

18

Adding to a Two-Digit Number · 22

ANSWER

98

Adding to a Two-Digit Number · 21

ANSWER

39

Adding to a Two-Digit Number · 24

ANSWER

48

Adding to a Two-Digit Number · 23

ANSWER

27