Task card 1 10 More & 10 Less

What is 10 more than 22?



Task card 2 10 More & 10 Less

What is 10 more than 14?



Task card 3 10 More & 10 Less

What is 10 more than 47?

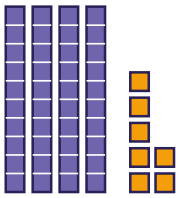

Task card 4 10 More & 10 Less

This is a piece of a hundred chart. Which number is 10 more than 35?

24	25	26
34	35	36
44	?	46

Task card 5 10 More & 10 Less

This is a piece of a hundred chart. Which number is 10 more than 31?

	21	22
	31	32
	?	42

Task card 6 10 More & 10 Less

Mia has 26 beads and gets 10 more. How many beads does Mia have now?

Task card 7 10 More & 10 Less

10 more each time: 12, 22, 32, ___

Task card 8 10 More & 10 Less

10 more than ___ is 42

Task card 9 10 More & 10 Less

What is 10 less than 26?

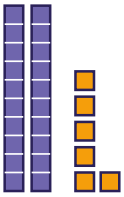

Task card 10 10 More & 10 Less

What is 10 less than 37?

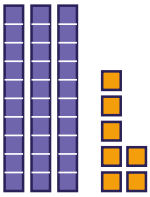

Task card 11 10 More & 10 Less

What is 10 less than 58?

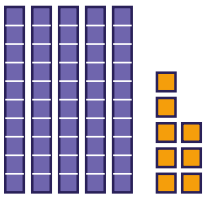

Task card 12 10 More & 10 Less

This is a piece of a hundred chart. Which number is 10 less than 50?

39	?	
49	50	
59	60	

Task card 13 10 More & 10 Less

This is a piece of a hundred chart. Which number is 10 less than 59?

48	?	50
58	59	60
68	69	70

Task card 14 10 More & 10 Less

Lily has 41 buttons and gives 10 away. How many buttons does Lily have left?

Task card 15 10 More & 10 Less

10 less each time: 55, 45, 35, ___

Task card 16 10 More & 10 Less

10 less than ___ is 21

Task card 17 10 More & 10 Less

What is 10 more than 87?

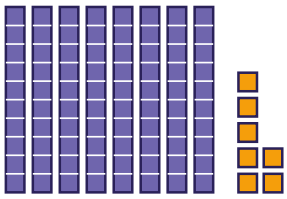

Task card 18 10 More & 10 Less

What is 10 less than 42?

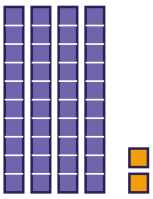

Task card 19 10 More & 10 Less

What is 10 more than 23?

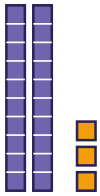

Task card 20 10 More & 10 Less

This is a piece of a hundred chart. Which number is 10 less than 22?

11	?	13
21	22	23
31	32	33

Task card 21 10 More & 10 Less

This is a piece of a hundred chart. Which number is 10 more than 41?

	31	32
	41	42
	?	52

Task card 22 10 More & 10 Less

Lily has 58 crayons and gives 10 away. How many crayons does Lily have left?

Task card 23 10 More & 10 Less

10 more each time: 52, 62, 72, ___

Task card 24 10 More & 10 Less

10 less than ___ is 41

10 More & 10 Less Task Cards

Recording sheet · Grade 1 · Find the number. Think about the tens and the ones.

Name: _____ Date: _____

Scan to check your answers

1	2	3	4
5	6	7	8
9	10	11	12
13	14	15	16
17	18	19	20
21	22	23	24

10 More & 10 Less Task Cards: Answer Key

Grade 1 · Easy

The answers online

1. 32	**2.** 24	**3.** 57
4. 45	**5.** 41	**6.** 36
7. 42	**8.** 32	**9.** 16
10. 27	**11.** 48	**12.** 40
13. 49	**14.** 31	**15.** 25
16. 31	**17.** 97	**18.** 32
19. 33	**20.** 12	**21.** 51
22. 48	**23.** 82	**24.** 51