10 More & 10 Less · 1

What is 10 more than 22?



10 More & 10 Less · 2

What is 10 more than 14?



10 More & 10 Less · 3

What is 10 more than 47?

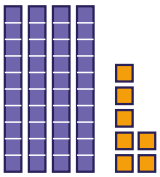

10 More & 10 Less · 4

This is a piece of a hundred chart. Which number is 10 more than 35?

24	**25**	**26**
34	**35**	**36**

10 More & 10 Less · 5

This is a piece of a hundred chart. Which number is 10 more than 31?

	21	**22**
	31	**32**

10 More & 10 Less · 6

Mia has 26 beads and gets 10 more. How many beads does Mia have now?

10 More & 10 Less · 7

10 more each time: 12, 22, 32, ___

10 More & 10 Less · 8

10 more than ___ is 42

10 More & 10 Less · 2

ANSWER

24

10 More & 10 Less · 1

ANSWER

32

10 More & 10 Less · 4

ANSWER

45

10 More & 10 Less · 3

ANSWER

57

10 More & 10 Less · 6

ANSWER

36

10 More & 10 Less · 5

ANSWER

41

10 More & 10 Less · 8

ANSWER

32

10 More & 10 Less · 7

ANSWER

42

10 More & 10 Less · 9

What is 10 less than 26?

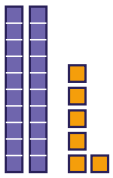

10 More & 10 Less · 10

What is 10 less than 37?

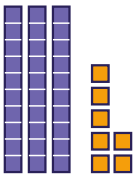

10 More & 10 Less · 11

What is 10 less than 58?

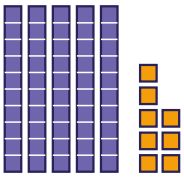

10 More & 10 Less · 12

This is a piece of a hundred chart. Which number is 10 less than 50?

39	**?**	
49	**50**	

10 More & 10 Less · 13

This is a piece of a hundred chart. Which number is 10 less than 59?

48	**?**	**50**
58	**59**	**60**

10 More & 10 Less · 14

Lily has 41 buttons and gives 10 away. How many buttons does Lily have left?

10 More & 10 Less · 15

10 less each time: 55, 45, 35, ___

10 More & 10 Less · 16

10 less than ___ is 21

10 More & 10 Less · 10

ANSWER

27

10 More & 10 Less · 9

ANSWER

16

10 More & 10 Less · 12

ANSWER

40

10 More & 10 Less · 11

ANSWER

48

10 More & 10 Less · 14

ANSWER

31

10 More & 10 Less · 13

ANSWER

49

10 More & 10 Less · 16

ANSWER

31

10 More & 10 Less · 15

ANSWER

25

10 More & 10 Less · 17

What is 10 more than 87?

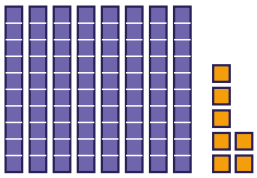

10 More & 10 Less · 18

What is 10 less than 42?

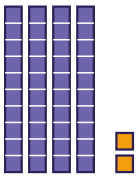

10 More & 10 Less · 19

What is 10 more than 23?

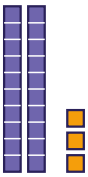

10 More & 10 Less · 20

This is a piece of a hundred chart. Which number is 10 less than 22?

11	**?**	**13**
21	**22**	**23**

10 More & 10 Less · 21

This is a piece of a hundred chart. Which number is 10 more than 41?

	31	**32**
	41	**42**

10 More & 10 Less · 22

Lily has 58 crayons and gives 10 away. How many crayons does Lily have left?

10 More & 10 Less · 23

10 more each time: 52, 62, 72, ___

10 More & 10 Less · 24

10 less than ___ is 41

10 More & 10 Less · 18

ANSWER

32

10 More & 10 Less · 17

ANSWER

97

10 More & 10 Less · 20

ANSWER

12

10 More & 10 Less · 19

ANSWER

33

10 More & 10 Less · 22

ANSWER

48

10 More & 10 Less · 21

ANSWER

51

10 More & 10 Less · 24

ANSWER

51

10 More & 10 Less · 23

ANSWER

82