Task card 1 Subtraction within 20

$4 - 3 = ___$

Task card 2 Subtraction within 20

$2 - 2 = ___$

Task card 3 Subtraction within 20

Subtract.

$$\begin{array}{r} \ 7 \\ ?\ 7 \\ \hline \end{array}$$

Task card 4 Subtraction within 20

There are 8 hearts. The 4 grey ones are taken away. How many are left?



Task card 5 Subtraction within 20

The two parts make the whole. What is the missing number?

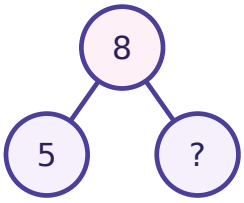

Task card 6 Subtraction within 20

Think: $3 + ? = 4$. So $4 - 3 =$ ___

Task card 7 Subtraction within 20

$7 - ___ = 2$

Task card 8 Subtraction within 20

$___ - 6 = 1$

Task card 9 Subtraction within 20

Leo has 5 shells and gives away 1. How many shells does Leo have left?

Task card 10 Subtraction within 20

$4 - 1 = 5 - ___$

Task card 11 Subtraction within 20

$7 - 3 = ___$

Task card 12 Subtraction within 20

$8 - 7 = ___$

Task card 13 Subtraction within 20

Subtract.

$$\begin{array}{r} 8 \\ ?\ \ 5 \\ \hline \end{array}$$

Task card 14 Subtraction within 20

There are 6 apples. The 2 grey ones are taken away. How many are left?

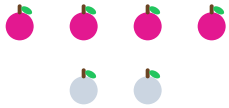

Task card 15 Subtraction within 20

The two parts make the whole. What is the missing number?

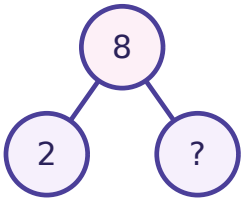

Task card 16 Subtraction within 20

Think: 1 + ? = 3. So 3 − 1 = ___

Task card 17 Subtraction within 20

5 − ___ = 1

Task card 18 Subtraction within 20

___ − 1 = 7

Task card 19 Subtraction within 20

Max has 5 buttons and gives away 1. How many buttons does Max have left?

Task card 20 Subtraction within 20

$8 - 1 = 10 - ___$

Task card 21 Subtraction within 20

$3 - 3 = ___$

Task card 22 Subtraction within 20

$1 - 0 = ___$

Task card 23 Subtraction within 20

Subtract.

$$\begin{array}{r} 6 \\ -\ ?\ \ 2 \\ \hline \end{array}$$

Task card 24 Subtraction within 20

There are 9 stars. The 3 grey ones are taken away. How many are left?

★ ★ ★ ★ ★ ★

★ ★ ★

Subtraction within 20 Task Cards

Recording sheet · Grade 1 · Answer each question. The same facts come in different shapes!

Name: _____ Date: _____

Scan to check your answers

1	2	3	4
5	6	7	8
9	10	11	12
13	14	15	16
17	18	19	20
21	22	23	24

Subtraction within 20 Task Cards: Answer Key

Grade 1 · Easy

The answers online

1. 1	**2.** 0	**3.** 0
4. 4	**5.** 3	**6.** 1
7. 5	**8.** 7	**9.** 4
10. 2	**11.** 4	**12.** 1
13. 3	**14.** 4	**15.** 6
16. 2	**17.** 4	**18.** 8
19. 4	**20.** 3	**21.** 0
22. 1	**23.** 4	**24.** 6