Subtraction within 20 · 1

$11 - 4 = ___$

Subtraction within 20 · 2

$6 - 0 = ___$

Subtraction within 20 · 3

Subtract.

$$\begin{array}{r} 13 \\ ?\ 11 \\ \hline \end{array}$$

Subtraction within 20 · 4

There are 5 stars. The 4 grey ones are taken away. How many are left?



Subtraction within 20 · 5

The two parts make the whole. What is the missing number?

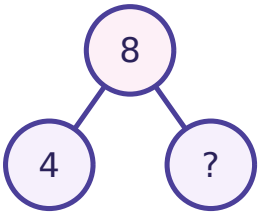

Subtraction within 20 · 6

Think: $7 + ? = 8$.

So $8 - 7 = ___$

Subtraction within 20 · 7

$8 - ___ = 4$

Subtraction within 20 · 8

$___ - 13 = 1$

Subtraction within 20 · 2

ANSWER

6

Subtraction within 20 · 1

ANSWER

7

Subtraction within 20 · 4

ANSWER

1

Subtraction within 20 · 3

ANSWER

2

Subtraction within 20 · 6

ANSWER

1

Subtraction within 20 · 5

ANSWER

4

Subtraction within 20 · 8

ANSWER

14

Subtraction within 20 · 7

ANSWER

4

Subtraction within 20 · 9

Ava has 14 shells and gives away 2. How many shells does Ava have left?

Subtraction within 20 · 10

$13 - 5 = 11 - ___$

Subtraction within 20 · 11

$14 - 0 = ___$

Subtraction within 20 · 12

$8 - 7 = ___$

Subtraction within 20 · 13

Subtract.

$$\begin{array}{r} 16 \\ ?\ \ 6 \\ \hline \end{array}$$

Subtraction within 20 · 14

There are 12 hearts. The 5 grey ones are taken away. How many are left?



Subtraction within 20 · 15

The two parts make the whole. What is the missing number?

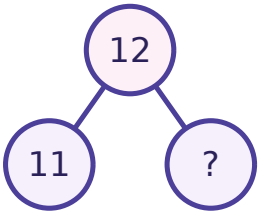

Subtraction within 20 · 16

Think: 5 + ? = 10.

So $10 - 5 = ___$

Subtraction within 20 · 10

ANSWER

3

Subtraction within 20 · 9

ANSWER

12

Subtraction within 20 · 12

ANSWER

1

Subtraction within 20 · 11

ANSWER

14

Subtraction within 20 · 14

ANSWER

7

Subtraction within 20 · 13

ANSWER

10

Subtraction within 20 · 16

ANSWER

5

Subtraction within 20 · 15

ANSWER

1

Subtraction within 20 · 17

$13 - ___ = 8$

Subtraction within 20 · 18

$___ - 7 = 2$

Subtraction within 20 · 19

Sam has 7 beads and gives away 1. How many beads does Sam have left?

Subtraction within 20 · 20

$9 - 4 = 6 - ___$

Subtraction within 20 · 21

$17 - 12 = ___$

Subtraction within 20 · 22

$2 - 0 = ___$

Subtraction within 20 · 23

Subtract.

$$\begin{array}{r} 8 \\ -\ ?\ 0 \\ \hline \end{array}$$

Subtraction within 20 · 24

There are 10 apples. The 7 grey ones are taken away. How many are left?

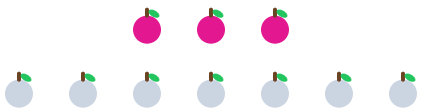

Subtraction within 20 · 18

ANSWER

9

Subtraction within 20 · 17

ANSWER

5

Subtraction within 20 · 20

ANSWER

1

Subtraction within 20 · 19

ANSWER

6

Subtraction within 20 · 22

ANSWER

2

Subtraction within 20 · 21

ANSWER

5

Subtraction within 20 · 24

ANSWER

3

Subtraction within 20 · 23

ANSWER

8