Subtraction within 20 · 1

$4 - 3 = ___$

Subtraction within 20 · 2

$2 - 2 = ___$

Subtraction within 20 · 3

Subtract.

$$\begin{array}{r} 7 \\ ?\ \ 7 \\ \hline \end{array}$$

Subtraction within 20 · 4

There are 8 hearts. The 4 grey ones are taken away. How many are left?



Subtraction within 20 · 5

The two parts make the whole. What is the missing number?

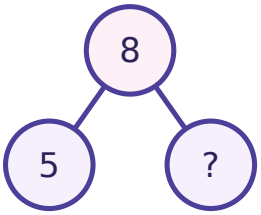

Subtraction within 20 · 6

Think: 3 + ? = 4.

So 4 − 3 = ___

Subtraction within 20 · 7

$7 - ___ = 2$

Subtraction within 20 · 8

$___ - 6 = 1$

Subtraction within 20 · 2

ANSWER

0

Subtraction within 20 · 1

ANSWER

1

Subtraction within 20 · 4

ANSWER

4

Subtraction within 20 · 3

ANSWER

0

Subtraction within 20 · 6

ANSWER

1

Subtraction within 20 · 5

ANSWER

3

Subtraction within 20 · 8

ANSWER

7

Subtraction within 20 · 7

ANSWER

5

Subtraction within 20 · 9

Leo has 5 shells and gives away 1. How many shells does Leo have left?

Subtraction within 20 · 10

$4 - 1 = 5 - ___$

Subtraction within 20 · 11

$7 - 3 = ___$

Subtraction within 20 · 12

$8 - 7 = ___$

Subtraction within 20 · 13

Subtract.

$$\begin{array}{r} 8 \\ ?\ \ 5 \\ \hline \end{array}$$

Subtraction within 20 · 14

There are 6 apples. The 2 grey ones are taken away. How many are left?

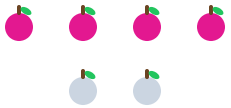

Subtraction within 20 · 15

The two parts make the whole. What is the missing number?

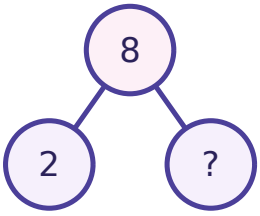

Subtraction within 20 · 16

Think: $1 + ? = 3$.

So $3 - 1 = ___$

Subtraction within 20 · 10

ANSWER

2

Subtraction within 20 · 9

ANSWER

4

Subtraction within 20 · 12

ANSWER

1

Subtraction within 20 · 11

ANSWER

4

Subtraction within 20 · 14

ANSWER

4

Subtraction within 20 · 13

ANSWER

3

Subtraction within 20 · 16

ANSWER

2

Subtraction within 20 · 15

ANSWER

6

Subtraction within 20 · 17

$5 - ___ = 1$

Subtraction within 20 · 18

$___ - 1 = 7$

Subtraction within 20 · 19

Max has 5 buttons and gives away 1. How many buttons does Max have left?

Subtraction within 20 · 20

$8 - 1 = 10 - ___$

Subtraction within 20 · 21

$3 - 3 = ___$

Subtraction within 20 · 22

$1 - 0 = ___$

Subtraction within 20 · 23

Subtract.

$$\begin{array}{r} 6 \\ ?\ 2 \\ \hline \end{array}$$

Subtraction within 20 · 24

There are 9 stars. The 3 grey ones are taken away. How many are left?

★ ★ ★ ★ ★ ★

☆ ☆ ☆

Subtraction within 20 · 18

ANSWER

8

Subtraction within 20 · 17

ANSWER

4

Subtraction within 20 · 20

ANSWER

3

Subtraction within 20 · 19

ANSWER

4

Subtraction within 20 · 22

ANSWER

1

Subtraction within 20 · 21

ANSWER

0

Subtraction within 20 · 24

ANSWER

6

Subtraction within 20 · 23

ANSWER

4