Task card 1 Subtracting Tens

$80 - ___ = 50$

Task card 2 Subtracting Tens

$___ - 50 = 30$

Task card 3 Subtracting Tens

$50 - ___ = 20$

Task card 4 Subtracting Tens

$90 - ___ = 30$

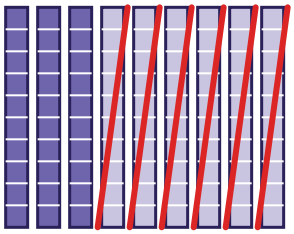

Task card 5 Subtracting Tens

9 tens − ___

tens = 1 ten

Task card 6 Subtracting Tens

Leo has 40 crayons and gives some away. Now Leo has 20. How many did Leo give away?

Task card 7 Subtracting Tens

$50 - 40 = ___$

Task card 8 Subtracting Tens

$90 - 60 = 80 - ___$

Task card 9 Subtracting Tens

$82 - ___ = 62$

Task card 10 Subtracting Tens

$___ - 10 = 67$

Task card 11 Subtracting Tens

$99 - 70 = ___$

Task card 12 Subtracting Tens

$76 - ___ = 56$

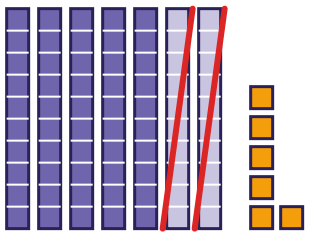

Task card 13 Subtracting Tens

8 tens − 1 ten = 7 tens. The 5 ones stay. 85 − 10 = ___

Task card 14 Subtracting Tens

Ava has 78 cards and gives some away. Now Ava has 58. How many did Ava give away?

Task card 15 Subtracting Tens

Subtract.

$$\begin{array}{r} 57 \\ -\ 20 \\ \hline \end{array}$$

Task card 16 Subtracting Tens

54 − 40 = 44 − ___

Task card 17 Subtracting Tens

40 − ___ = 30

Task card 18 Subtracting Tens

___ − 20 = 70

Task card 19 Subtracting Tens

$90 - ___ = 50$

Task card 20 Subtracting Tens

$30 - ___ = 10$

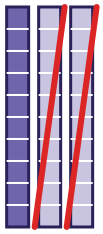

Task card 21 Subtracting Tens

3 tens − ___

tens = 1 ten

Task card 22 Subtracting Tens

Zoe has 70 beads and gives some away. Now Zoe has 20. How many did Zoe give away?

Task card 23 Subtracting Tens

$80 - 10 = ___$

Task card 24 Subtracting Tens

$80 - 20 = 70 - ___$

Subtracting Tens Task Cards

Recording sheet · Grade 1 · Subtract the tens. The same kind of problem comes in different shapes.

Name: _____ Date: _____

Scan to check your answers

1	2	3	4
5	6	7	8
9	10	11	12
13	14	15	16
17	18	19	20
21	22	23	24

Subtracting Tens Task Cards: Answer Key

Grade 1 · Hard

The answers online

1. 30	**2.** 80	**3.** 30
4. 60	**5.** 8	**6.** 20
7. 10	**8.** 50	**9.** 20
10. 77	**11.** 29	**12.** 20
13. 75	**14.** 20	**15.** 37
16. 30	**17.** 10	**18.** 90
19. 40	**20.** 20	**21.** 2
22. 50	**23.** 70	**24.** 10