Subtracting Tens · 1

$50 - 20 = ___$

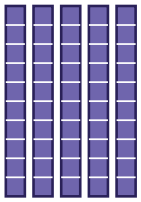

Subtracting Tens · 2

$30 - 10 = ___$



Subtracting Tens · 3

$30 - 20 = ___$

Subtracting Tens · 4

The blocks show 30. 2 tens are crossed out. How many are left?

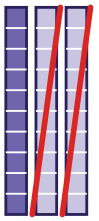

Subtracting Tens · 5

4 tens − 2 tens = ___ tens

Subtracting Tens · 6

40 − 30: count back 3 tens. 30, 20, ___

Subtracting Tens · 7

Sam has 50 beads and gives away 40. How many beads does Sam have left?

Subtracting Tens · 8

Subtract.

$$\begin{array}{r} 20 \\ -\ 10 \\ \hline \end{array}$$

Subtracting Tens · 2

ANSWER

20

Subtracting Tens · 1

ANSWER

30

Subtracting Tens · 4

ANSWER

10

Subtracting Tens · 3

ANSWER

10

Subtracting Tens · 6

ANSWER

10

Subtracting Tens · 5

ANSWER

2

Subtracting Tens · 8

ANSWER

10

Subtracting Tens · 7

ANSWER

10

Subtracting Tens · 9

$40 - 20 = ___$

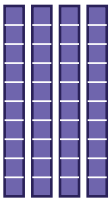

Subtracting Tens · 10

$70 - 20 = ___$



Subtracting Tens · 11

The blocks show 20. 1 ten is crossed out. How many are left?

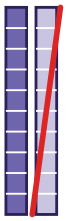

Subtracting Tens · 12

2 tens − 1 ten = ___ tens

Subtracting Tens · 13

90 − 20: count back 2 tens. 80, ___

Subtracting Tens · 14

Ben has 80 crayons and gives away 70. How many crayons does Ben have left?

Subtracting Tens · 15

Subtract.

$$\begin{array}{r} 80 \\ -\ 70 \\ \hline \end{array}$$

Subtracting Tens · 16

$50 - 30 = ___$

Subtracting Tens · 10

ANSWER

50

Subtracting Tens · 9

ANSWER

20

Subtracting Tens · 12

ANSWER

1

Subtracting Tens · 11

ANSWER

10

Subtracting Tens · 14

ANSWER

10

Subtracting Tens · 13

ANSWER

70

Subtracting Tens · 16

ANSWER

20

Subtracting Tens · 15

ANSWER

10

Subtracting Tens · 17

7 tens − 2 tens = ___ tens

Subtracting Tens · 18

40 − 20 = ___

Subtracting Tens · 19

The blocks show 90. 1 ten is crossed out. How many are left?

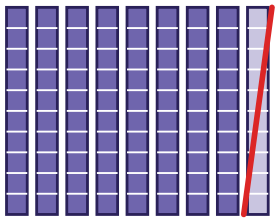

Subtracting Tens · 20

60 − 40: count back 4 tens. 50, 40, 30, ___

Subtracting Tens · 21

Subtract.

```
  50
? 10
----
```

Subtracting Tens · 22

Ben has 70 crayons and gives away 20. How many crayons does Ben have left?

Subtracting Tens · 23

4 tens − 2 tens = 2 tens. What number is 2 tens?

Subtracting Tens · 24

40 − 10 = ___

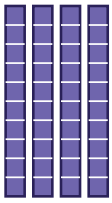

Subtracting Tens · 18

ANSWER

20

Subtracting Tens · 17

ANSWER

5

Subtracting Tens · 20

ANSWER

20

Subtracting Tens · 19

ANSWER

80

Subtracting Tens · 22

ANSWER

50

Subtracting Tens · 21

ANSWER

40

Subtracting Tens · 24

ANSWER

30

Subtracting Tens · 23

ANSWER

20