Task card 1 Subtracting from a Two-Digit Numbe...

$35 - 5 = ___$

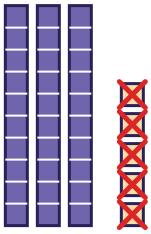

Task card 2 Subtracting from a Two-Digit Numbe...

$27 - 10 = ___$

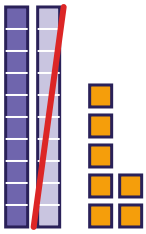

Task card 3 Subtracting from a Two-Digit Numbe...

$44 - 3 = ___$

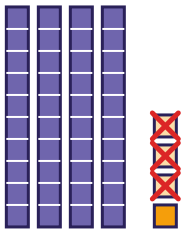

Task card 4 Subtracting from a Two-Digit Numbe...

The blocks show 55. 4 tens are crossed out. How many are left?

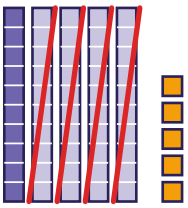

Task card 5 Subtracting from a Two-Digit Numbe...

7 ones − 5 ones = 2 ones. The 2 tens stay. 27 − 5 = ___

Task card 6 Subtracting from a Two-Digit Numbe...

Subtract.

$$\begin{array}{r} 66 \\ -\ 60 \\ \hline \end{array}$$

Task card 7 Subtracting from a Two-Digit Numbe...

Zoe has 71 toy cars and gives away 1. How many toy cars does Zoe have left?

Task card 8 Subtracting from a Two-Digit Numbe...

$42 - 40 = ___$

Task card 9 Subtracting from a Two-Digit Numbe...

$34 - 2 = ___$

Task card 10 Subtracting from a Two-Digit Numbe...

$58 - 20 = ___$

Task card 11 Subtracting from a Two-Digit Numbe...

$64 - 4 = ___$

Task card 12 Subtracting from a Two-Digit Numbe...

$92 - 50 = ___$

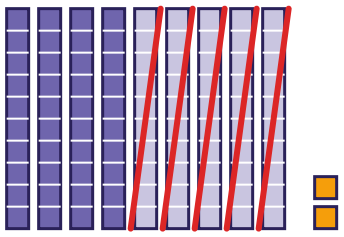

Task card 13 Subtracting from a Two-Digit Numbe...

2 ones − 2 ones = 0 ones. The 9 tens stay. 92 − 2 = ___

Task card 14 Subtracting from a Two-Digit Numbe...

Subtract.

```
  35
? 20
----
```

Task card 15 Subtracting from a Two-Digit Numbe...

Leo has 42 toy cars and gives away 2. How many toy cars does Leo have left?

Task card 16 Subtracting from a Two-Digit Numbe...

45 − 40: count back by tens. 35, 25, 15, ___

Task card 17 Subtracting from a Two-Digit Numbe...

36 − 6 = ___

Task card 18 Subtracting from a Two-Digit Numbe...

45 − 30 = ___

Task card 19 Subtracting from a Two-Digit Numbe...

$53 - 2 = ___$

Task card 20 Subtracting from a Two-Digit Numbe...

$78 - 30 = ___$

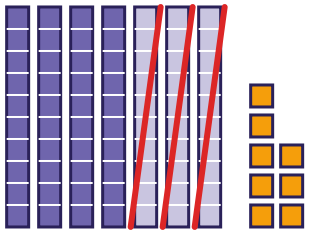

Task card 21 Subtracting from a Two-Digit Numbe...

4 ones − 3 ones = 1 one. The 4 tens stay.

$44 - 3 = ___$

Task card 22 Subtracting from a Two-Digit Numbe...

Subtract.

$$\begin{array}{r} 55 \\ ?\ 30 \\ \hline \end{array}$$

Task card 23 Subtracting from a Two-Digit Numbe...

Lily has 37 buttons and gives away 4. How many buttons does Lily have left?

Task card 24 Subtracting from a Two-Digit Numbe...

$54 - 3 = ___$

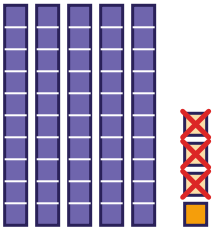

Subtracting from a Two-Digit Number Task Cards

Recording sheet · Grade 1 · Take away ones from the ones, or tens from the tens. The same kind of problem comes in different shapes.

Scan to check your answers

Name: _____ Date: _____

1	2	3	4
5	6	7	8
9	10	11	12
13	14	15	16
17	18	19	20
21	22	23	24

Subtracting from a Two-Digit Number Task Cards: Answer Key

Grade 1 · Medium

The answers online

1. 30	**2.** 17	**3.** 41
4. 15	**5.** 22	**6.** 6
7. 70	**8.** 2	**9.** 32
10. 38	**11.** 60	**12.** 42
13. 90	**14.** 15	**15.** 40
16. 5	**17.** 30	**18.** 15
19. 51	**20.** 48	**21.** 41
22. 25	**23.** 33	**24.** 51