Task card 1 Subtracting from a Two-Digit Numbe...

$64 - 2 = ___$

Task card 2 Subtracting from a Two-Digit Numbe...

$73 - 60 = ___$

Task card 3 Subtracting from a Two-Digit Numbe...

$89 - ___ = 81$

Task card 4 Subtracting from a Two-Digit Numbe...

$42 - 40 = ___$

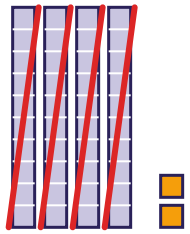

Task card 5 Subtracting from a Two-Digit Numbe...

7 ones − 7 ones = 0 ones. The 9 tens stay. 97 − 7 = ___

Task card 6 Subtracting from a Two-Digit Numbe...

Subtract.

$$\begin{array}{r} 85 \\ -\ 80 \\ \hline \end{array}$$

Task card 7 Subtracting from a Two-Digit Numbe...

Ava has 44 buttons and gives away 4. How many buttons does Ava have left?

Task card 8 Subtracting from a Two-Digit Numbe...

$57 - ___ = 7$

Task card 9 Subtracting from a Two-Digit Numbe...

$78 - 5 = ___$

Task card 10 Subtracting from a Two-Digit Numbe...

$95 - 70 = ___$

Task card 11 Subtracting from a Two-Digit Numbe...

$68 - ___ = 62$

Task card 12 Subtracting from a Two-Digit Numbe...

$88 - 20 = ___$

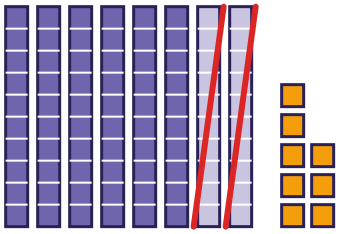

Task card 13 Subtracting from a Two-Digit Numbe...

4 ones − 3 ones = 1 one. The 4 tens stay.

44 − 3 = ___

Task card 14 Subtracting from a Two-Digit Numbe...

Subtract.

```
  79
? 60
----
```

Task card 15 Subtracting from a Two-Digit Numbe...

Mia has 44 crayons and gives away 4. How many crayons does Mia have left?

Task card 16 Subtracting from a Two-Digit Numbe...

42 − ___ = 2

Task card 17 Subtracting from a Two-Digit Numbe...

68 − 2 = ___

Task card 18 Subtracting from a Two-Digit Numbe...

36 − 30 = ___

Task card 19 Subtracting from a Two-Digit Numbe...

$65 - ___ = 61$

Task card 20 Subtracting from a Two-Digit Numbe...

$72 - 30 = ___$

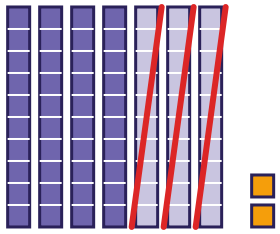

Task card 21 Subtracting from a Two-Digit Numbe...

3 ones − 3 ones = 0 ones. The 3 tens stay. 33 − 3 = ___

Task card 22 Subtracting from a Two-Digit Numbe...

Subtract.

$$\begin{array}{r} 45 \\ ?\ 40 \\ \hline \end{array}$$

Task card 23 Subtracting from a Two-Digit Numbe...

Max has 46 cards and gives away 5. How many cards does Max have left?

Task card 24 Subtracting from a Two-Digit Numbe...

$83 - ___ = 53$

Subtracting from a Two-Digit Number Task Cards

Recording sheet · Grade 1 · Take away ones from the ones, or tens from the tens. The same kind of problem comes in different shapes.

Scan to check your answers

Name: _____ Date: _____

1	2	3	4
5	6	7	8
9	10	11	12
13	14	15	16
17	18	19	20
21	22	23	24

Subtracting from a Two-Digit Number Task Cards: Answer Key

Grade 1 · Hard

The answers online

1. 62	**2.** 13	**3.** 8
4. 2	**5.** 90	**6.** 5
7. 40	**8.** 50	**9.** 73
10. 25	**11.** 6	**12.** 68
13. 41	**14.** 19	**15.** 40
16. 40	**17.** 66	**18.** 6
19. 4	**20.** 42	**21.** 30
22. 5	**23.** 41	**24.** 30