Task card 1 Subtracting from a Two-Digit Numbe...

$38 - 5 = ___$

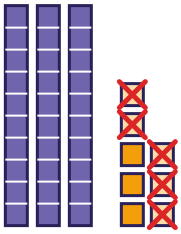

Task card 2 Subtracting from a Two-Digit Numbe...

$18 - 6 = ___$

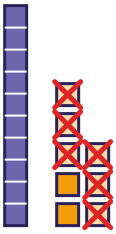

Task card 3 Subtracting from a Two-Digit Numbe...

$32 - 2 = ___$

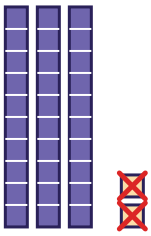

Task card 4 Subtracting from a Two-Digit Numbe...

The blocks show 17. 3 ones are crossed out. How many are left?

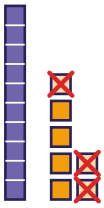

Task card 5 Subtracting from a Two-Digit Numbe...

7 ones − 1 one = 6 ones. The 2 tens stay. 27 − 1 = ___

Task card 6 Subtracting from a Two-Digit Numbe...

Subtract.

$$\begin{array}{r} 38 \\ -\ 3 \\ \hline \end{array}$$

Task card 7 Subtracting from a Two-Digit Numbe...

Leo has 39 stickers and gives away 3. How many stickers does Leo have left?

Task card 8 Subtracting from a Two-Digit Numbe...

$12 - 2 = ___$

Task card 9 Subtracting from a Two-Digit Numbe...

$16 - 5 = ___$

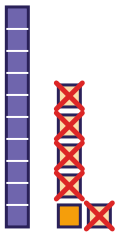

Task card 10 Subtracting from a Two-Digit Numbe...

$51 - 1 = ___$

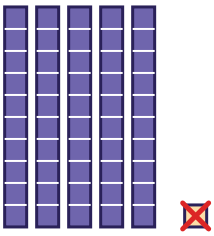

Task card 11 Subtracting from a Two-Digit Numbe...

$56 - 1 = ___$

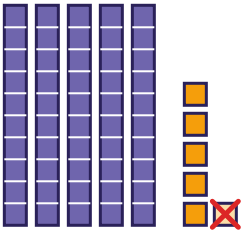

Task card 12 Subtracting from a Two-Digit Numbe...

The blocks show 16. 3 ones are crossed out. How many are left?

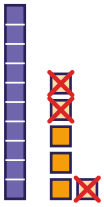

Task card 13 Subtracting from a Two-Digit Numbe...

5 ones − 5 ones = 0 ones. The 4 tens stay. 45 − 5 = ___

Task card 14 Subtracting from a Two-Digit Numbe...

Subtract.

$$\begin{array}{r} 52 \\ -\ ?\ 1 \\ \hline \end{array}$$

Task card 15 Subtracting from a Two-Digit Numbe...

Mia has 54 stickers and gives away 2. How many stickers does Mia have left?

Task card 16 Subtracting from a Two-Digit Numbe...

48 − 3 = ___

Task card 17 Subtracting from a Two-Digit Numbe...

55 − 4 = ___

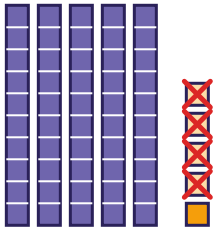

Task card 18 Subtracting from a Two-Digit Numbe...

47 − 30 = ___

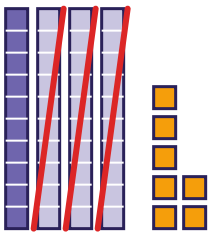

Task card 19 Subtracting from a Two-Digit Numbe...

$49 - 7 = ___$

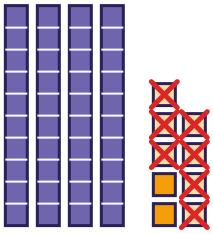

Task card 20 Subtracting from a Two-Digit Numbe...

The blocks show 72. 3 tens are crossed out. How many are left?

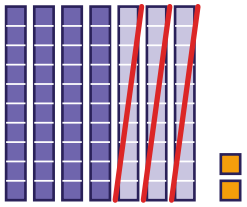

Task card 21 Subtracting from a Two-Digit Numbe...

1 one − 1 one = 0 ones. The 2 tens stay. $21 - 1 = ___$

Task card 22 Subtracting from a Two-Digit Numbe...

Subtract.

$$\begin{array}{r} 47 \\ -\ 10 \\ \hline \end{array}$$

Task card 23 Subtracting from a Two-Digit Numbe...

Mia has 62 beads and gives away 2. How many beads does Mia have left?

Task card 24 Subtracting from a Two-Digit Numbe...

$41 - 40 = ___$

Subtracting from a Two-Digit Number Task Cards

Recording sheet · Grade 1 · Take away ones from the ones, or tens from the tens. The same kind of problem comes in different shapes.

Scan to check your answers

Name: _____ Date: _____

1	2	3	4
5	6	7	8
9	10	11	12
13	14	15	16
17	18	19	20
21	22	23	24

Subtracting from a Two-Digit Number Task Cards: Answer Key

Grade 1 · Easy

The answers online

1. 33	**2.** 12	**3.** 30
4. 14	**5.** 26	**6.** 35
7. 36	**8.** 10	**9.** 11
10. 50	**11.** 55	**12.** 13
13. 40	**14.** 51	**15.** 52
16. 45	**17.** 51	**18.** 17
19. 42	**20.** 42	**21.** 20
22. 37	**23.** 60	**24.** 1